Year 6 - Column Addition — Lesson Guide

Step 1

18,526 + 11,495 = ☐

First, we circle the plus sign so we know to add the two parts and find their sum.

Step 2

18,526 + 11,495 = ☐

First, check whether a mental method would be quicker. Look at the ones. 6 ones and 5 ones make 11 ones. We can exchange 10 ones for 1 ten. Column addition keeps the place values lined up.

Step 3

18,526 + 11,495 = ☐

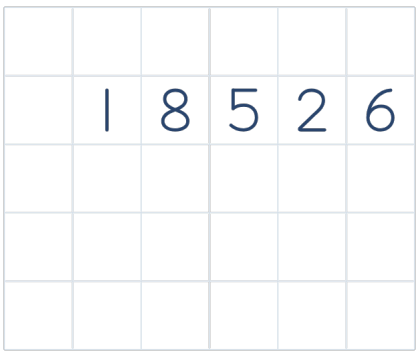

The first digit of 18,526, 1, is in the ten thousands column, so we start there. Now, we write 18,526 in the correct columns, with one digit in each box.

Step 4

18,526 + 11,495 = ☐

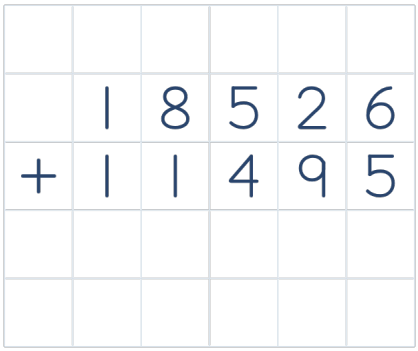

Remember: There must always be a digit in the ones column, even if it is a 0.

Then, we write a plus sign on the left of the calculation. 11,495 has five digits, so we start with 1 in the ten thousands column. We write 11,495 in the correct columns, with one digit in each box.

Step 5

18,526 + 11,495 = ☐

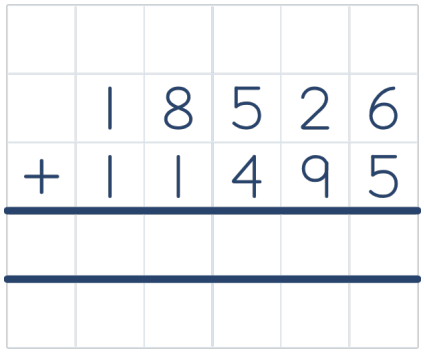

Draw a line under 11,495. Leave one row for the sum, then draw the second line below that row. Write exchanges below the second line.

Step 6

18,526 + 11,495 = ☐

	1	8	5	2	6
+	1	1	4	9	5

First, we add the ones, the smallest place-value column. 6 ones + 5 ones = 11 ones. As we can only write one digit per box, we partition 11 ones into 1 ten and 1 one.

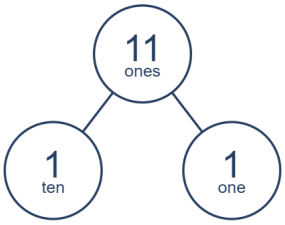

Step 7

18,526 + 11,495 = ☐

	1	8	5	2	6
+	1	1	4	9	5
					1
				1	

We write the 1 ten in the tens column underneath the answer, ready for the next step. Then we write the remaining 1 one in the ones answer box.

Step 8

18,526 + 11,495 = ☐

	1	8	5	2	6
+	1	1	4	9	5
					1
				1	

Remember: Check both places. Keep the small 1 below the tens column and the 1 in the ones answer square.

The small 1 below the tens column stands for 1 ten. The 1 in the ones answer square stands for 1 one. Together, they make 11 ones.

Step 9

18,526 + 11,495 = ☐

	1	8	5	2	6
+	1	1	4	9	5
					1
				1	

Remember: Look below the column you are working on. Add the exchanged amount written there.

Next, we add the tens. 2 tens + 9 tens = 11 tens. Add the 1 exchanged ten shown by the small 1 below the tens column. 11 tens + 1 exchanged ten = 12 tens. As we can only write one digit per box, we partition 12 tens into 1 hundred and 2 tens.

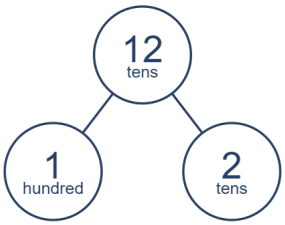

Step 10

18,526 + 11,495 = ☐

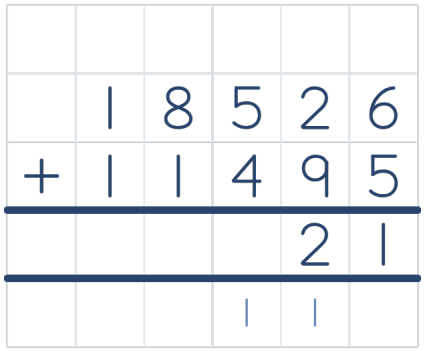

We write the 1 hundred in the hundreds column underneath the answer, ready for the next step. Then we write the remaining 2 tens in the tens answer box.

Step 11

18,526 + 11,495 = ☐

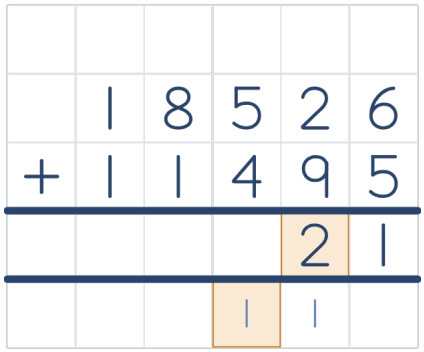

Remember: Check both places. Keep the small 1 below the hundreds column and the 2 in the tens answer square.

The small 1 below the hundreds column stands for 1 hundred. The 2 in the tens answer square stands for 2 tens. Together, they make 12 tens.

Step 12

18,526 + 11,495 = ☐

	1	8	5	2	6
+	1	1	4	9	5
				2	1
			1	1	

Remember: Look below the column you are working on. Add the exchanged amount written there.

Next, we add the hundreds. 5 hundreds + 4 hundreds = 9 hundreds. Add the 1 exchanged hundred shown by the small 1 below the hundreds column. 9 hundreds + 1 exchanged hundred = 10 hundreds. As we can only write one digit per box, we partition 10 hundreds into 1 thousand and 0 hundreds.

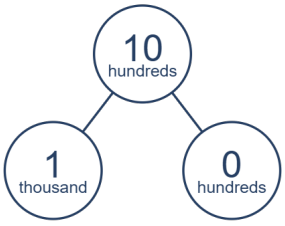

Step 13

18,526 + 11,495 = ☐

	1	8	5	2	6
+	1	1	4	9	5
			0	2	1
		1	1	1	

We write the 1 thousand in the thousands column underneath the answer, ready for the next step. Then we write the remaining 0 hundreds in the hundreds answer box.

Step 14

18,526 + 11,495 = ☐

	1	8	5	2	6
+	1	1	4	9	5
			0	2	1
		1	1	1	

Remember: Check both places. Keep the small 1 below the thousands column and the 0 in the hundreds answer square.

The small 1 below the thousands column stands for 1 thousand. The 0 in the hundreds answer square stands for 0 hundreds. Together, they make 10 hundreds.

Step 15

18,526 + 11,495 = ☐

	1	8	5	2	6
+	1	1	4	9	5
			0	2	1
		1	1	1	

Remember: Look below the column you are working on. Add the exchanged amount written there.

After that, we add the thousands. 8 thousands + 1 thousand = 9 thousands. Add the 1 exchanged thousand shown by the small 1 below the thousands column. 9 thousands + 1 exchanged thousand = 10 thousands. As we can only write one digit per box, we partition 10 thousands into 1 ten thousand and 0 thousands.

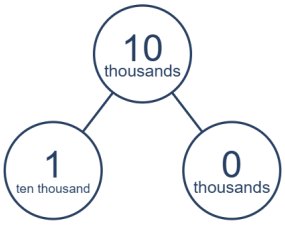

Step 16

18,526 + 11,495 = ☐

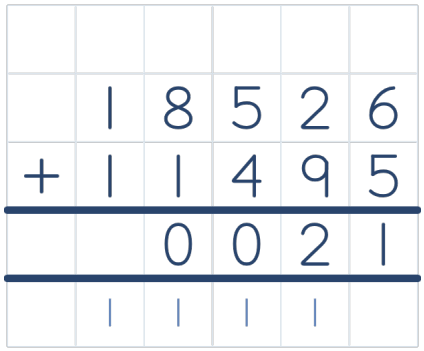

We write the 1 ten thousand in the ten thousands column underneath the answer, ready for the next step. Then we write the remaining 0 thousands in the thousands answer box.

Step 17

18,526 + 11,495 = ☐

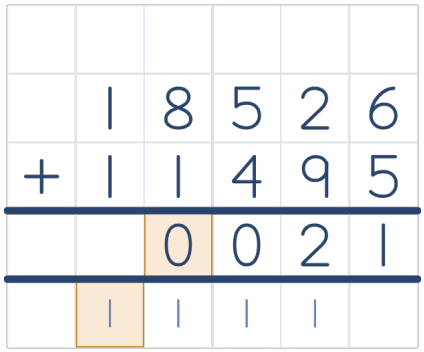

Remember: Check both places. Keep the small 1 below the ten thousands column and the 0 in the thousands answer square.

The small 1 below the ten thousands column stands for 1 ten thousand. The 0 in the thousands answer square stands for 0 thousands. Together, they make 10 thousands.

Step 18

18,526 + 11,495 = ☐

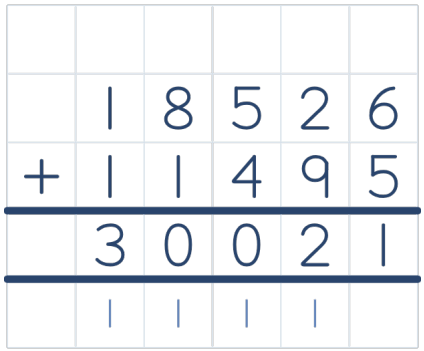

Remember: Look below the column you are working on. Add the exchanged amount written there.

Finally, we add the ten thousands. 1 ten thousand + 1 ten thousand = 2 ten thousands. Add the 1 exchanged ten thousand shown by the small 1 below the ten thousands column. 2 ten thousands + 1 exchanged ten thousand = 3 ten thousands. We write 3 in the ten thousands column. No exchange is needed this time.

Step 19

18,526 + 11,495 = ☐

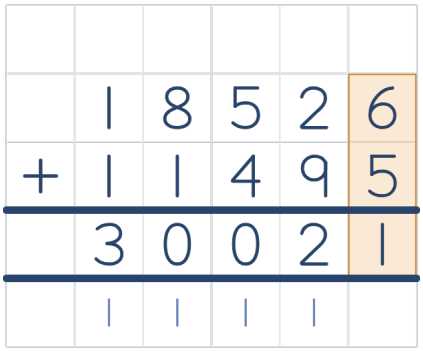

Our sum is 30,021. Before we copy our answer into the answer box, let's check each column, including the exchanges. First, we check the ones: 6 + 5 = 11. We have correctly recorded 1 ten underneath the answer and 1 one in the ones answer box.

Step 20

18,526 + 11,495 = ☐

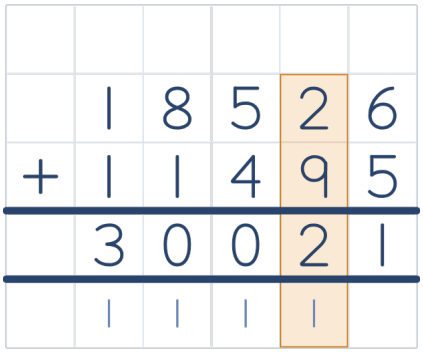

Next, we check the tens, including the exchanged ten: 2 + 9 + 1 = 12. We have correctly recorded 1 hundred underneath the answer and 2 tens in the tens answer box.

Step 21

18,526 + 11,495 = ☐

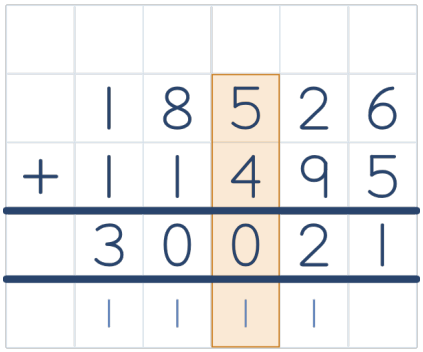

Then, we check the hundreds, including the exchanged hundred: 5 + 4 + 1 = 10. We have correctly recorded 1 thousand underneath the answer and 0 hundreds in the hundreds answer box.

Step 22

18,526 + 11,495 = ☐

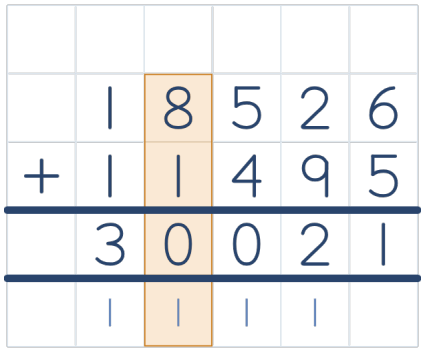

After that, we check the thousands, including the exchanged thousand: 8 + 1 + 1 = 10. We have correctly recorded 1 ten thousand underneath the answer and 0 thousands in the thousands answer box.

Step 23

18,526 + 11,495 = ☐

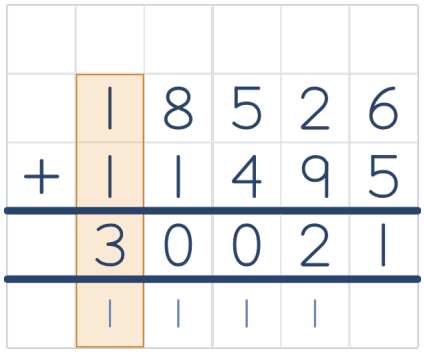

Finally, we check the ten thousands, including the exchanged ten thousand: 1 + 1 + 1 = 3. We have correctly included the exchanged ten thousand and written 3 in the ten thousands answer box.

Step 24

18,526 + 11,495 = **30021**

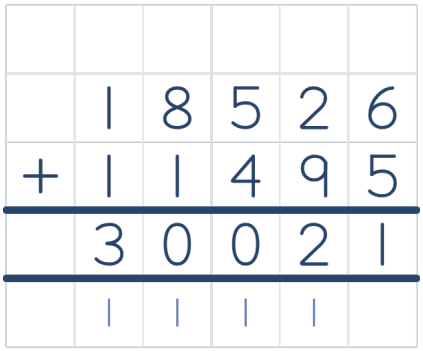

The sum is 30021. Copy 30021 into the answer box. Make sure you copy the answer correctly.

Step 25

18,526 + 11,495 = **30021**

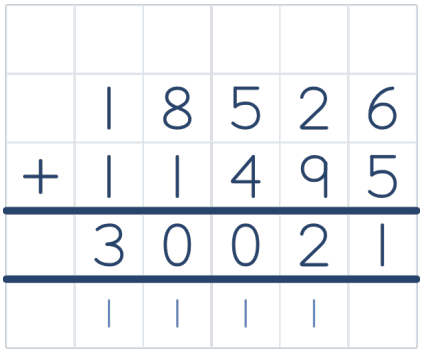

We can round to check whether our sum makes sense. Round 18,526 to 19,000 and 11,495 to 11,000, both to the nearest thousand. 19,000 + 11,000 = 30,000. Each number changes by at most 500. Our exact answer, 30,021, is within 1,000 of the estimate.

Year 6 - Column Addition with Decimals — Lesson Guide

Step 1

48.5 + 7.392 = ☐



First, we circle the plus sign so we know to add the two parts and find their sum.

Step 2

48.5 + 7.392 = ☐



First, check whether a mental method would be quicker. Line up the decimal points in 48.5 and 7.392 so matching places are in the same column. This places 5 tenths directly above 3 tenths.

Step 3

48.5 + 7.392 = ☐

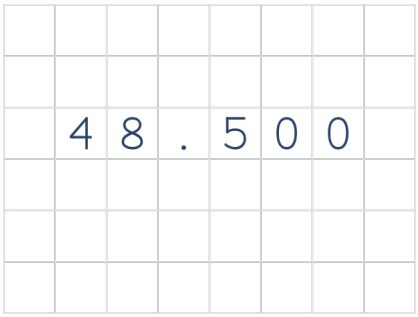

Remember: Line up the decimal points. Each digit goes in its own place-value column.

Write 48.5, with the decimal point between the ones and tenths. Put 0 in the hundredths column and 0 in the thousandths column to show the empty decimal places. 48.5 and 48.500 have the same value.

Step 4

48.5 + 7.392 = ☐

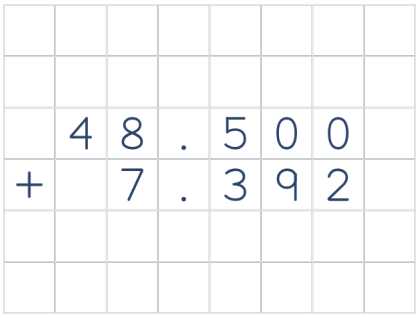

Then, we write a plus sign on the left of the calculation. We write 7.392 below 48.500, lining up the decimal points.

Step 5

48.5 + 7.392 = ☐

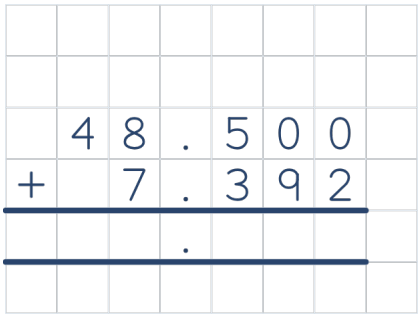

Draw a line under 7.392. Leave one row for the sum, then draw the second line below that row. Write exchanges below the second line. Write the decimal point in the answer row, directly below the other decimal points.

Step 6

48.5 + 7.392 = ☐

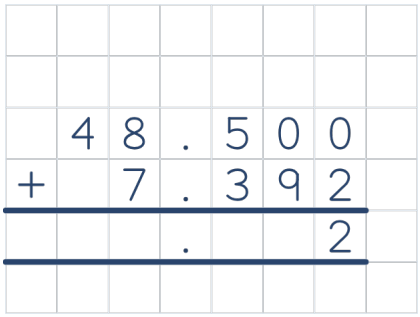

First, we add the thousandths, the smallest place-value column. 0 thousandths + 2 thousandths = 2 thousandths. No exchange is needed this time. We write 2 in the thousandths answer box.

Step 7

48.5 + 7.392 = ☐

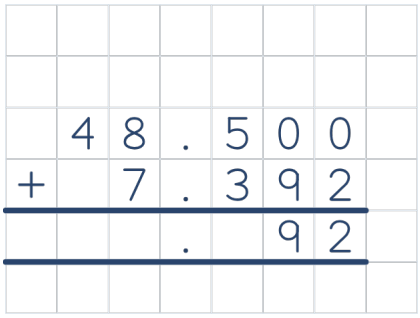

Next, we add the hundredths. 0 hundredths + 9 hundredths = 9 hundredths. No exchange is needed this time. We write 9 in the hundredths answer box.

Step 8

48.5 + 7.392 = ☐

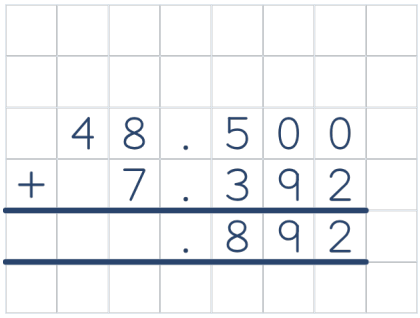

Next, we add the tenths. 5 tenths + 3 tenths = 8 tenths. No exchange is needed this time. We write 8 in the tenths answer box.

Step 9

48.5 + 7.392 = ☐

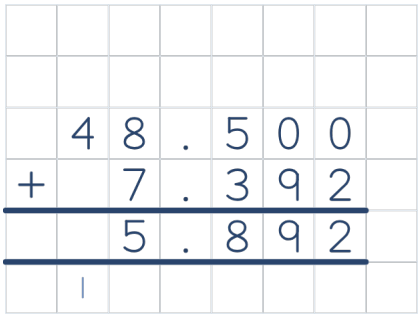

Next, we add the ones. 8 ones + 7 ones = 15 ones. We exchange 10 ones for 1 ten. We write the small 1 below the tens column. We write 5 in the ones answer box.

Step 10

48.5 + 7.392 = ☐

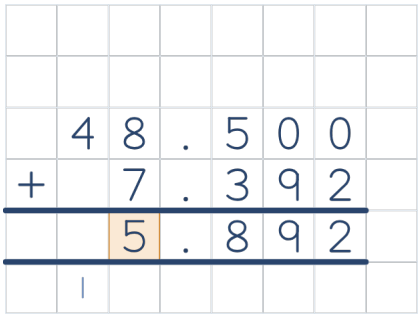

Remember: Check both places. Keep the small 1 below the tens column and the 5 in the ones answer square.

The small 1 below the tens column stands for 1 ten. The 5 in the ones answer square stands for 5 ones. Together, they make 15 ones.

Step 11

48.5 + 7.392 = ☐

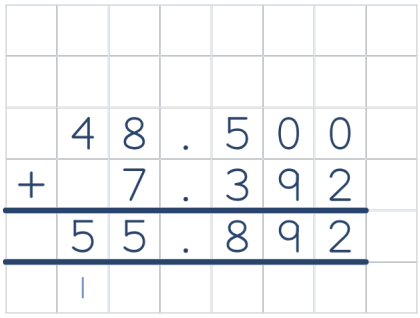

Finally, we add the tens. We remember to add the 1 ten exchanged from the previous column. 4 tens + 0 tens + 1 ten = 5 tens. No exchange is needed this time. We write 5 in the tens answer box.

Step 12

48.5 + 7.392 = ☐

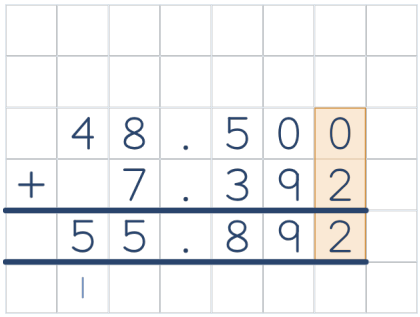

We check the thousandths column. 0 thousandths + 2 thousandths = 2 thousandths.

Step 13

48.5 + 7.392 = ☐

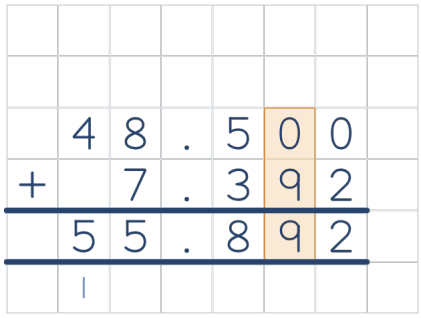

We check the hundredths column. 0 hundredths + 9 hundredths = 9 hundredths.

Step 14

48.5 + 7.392 = ☐

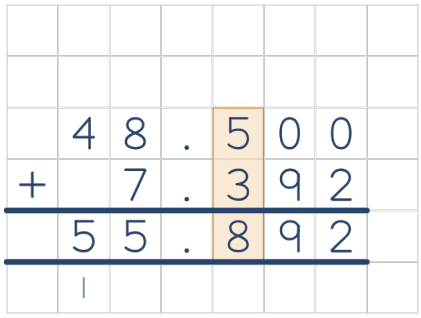

We check the tenths column. 5 tenths + 3 tenths = 8 tenths.

Step 15

48.5 + 7.392 = ☐

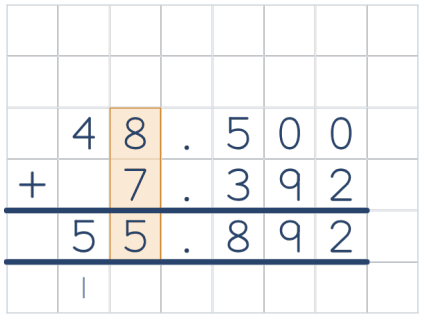

We check the ones column. 8 ones + 7 ones = 15 ones.

Step 16

48.5 + 7.392 = ☐

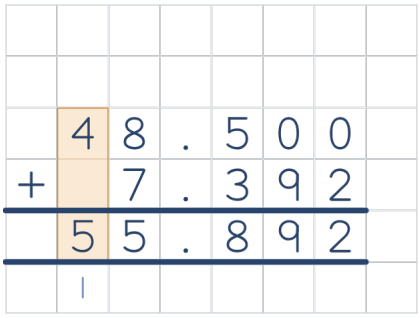

We check the tens column. 4 tens + 0 tens + 1 ten = 5 tens.

Step 17

48.5 + 7.392 = 55.892

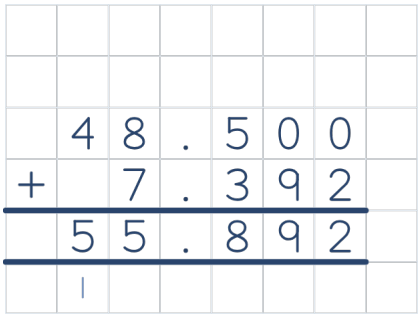

The sum is 55.892. Copy 55.892 into the answer box. Make sure you copy the answer correctly.

Year 6 - Column Subtraction — Lesson Guide

Step 1

58,126 – 19,579 = ☐

First, we circle the minus sign so we know to subtract and find the difference.

Step 2

58,126 – 19,579 = ☐

First, check whether a mental method would be quicker. Look at the ones. We have 6 ones and need to subtract 9 ones. Column subtraction helps us record the exchange.

Step 3

58,126 – 19,579 = ☐

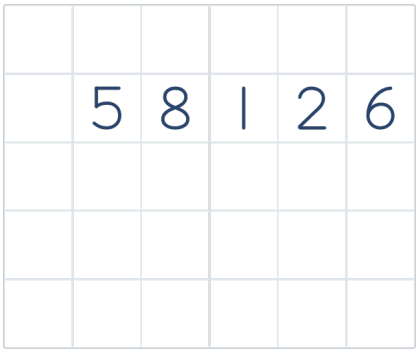

The first digit of 58,126, 5, is in the ten thousands column, so we start there. Now, we write 58,126 in the correct columns, with one digit in each box.

Step 4

58,126 – 19,579 = ☐

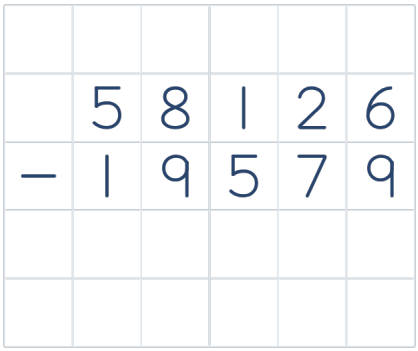

Remember: There must always be a digit in the ones column, even if it is a 0.

Then, we write a minus sign on the left of the calculation. The first digit of 19,579, 1, is in the ten thousands column, so we start there. We write 19,579 in the correct columns, with one digit in each box.

Step 5

58,126 – 19,579 = ☐

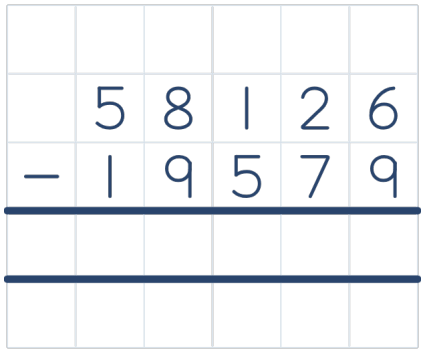

Draw a line under 19,579. Leave one row for the difference, then draw the second line below that row.

Step 6

58,126 – 19,579 = ☐

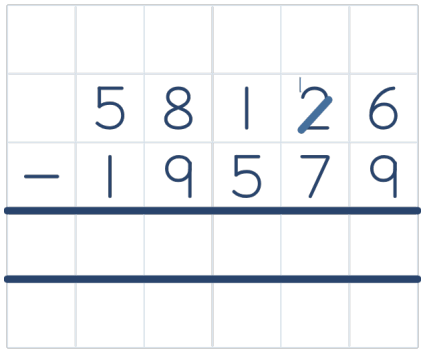

We have 6 ones and need to subtract 9 ones. Exchange 1 ten from the 2 tens for 10 ones. Cross out the 2 and write a small 1 at the top left of the tens square. We now have 1 ten in that column.

Step 7

58,126 – 19,579 = ☐

	5	8	1	2	6
–	1	9	5	7	9

Write a small 1 at the top left of the ones square, beside the 6 already there. The small 1 stands for 10 more ones. Read the two digits together as 16 ones. Keep the original 6 in its place.

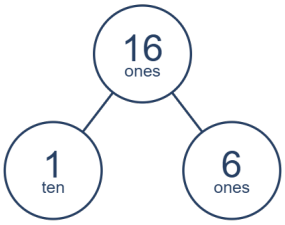

Step 8

58,126 – 19,579 = ☐

	5	8	1	2	6
–	1	9	5	7	9
					7

16 ones – 9 ones = 7 ones, so we write 7 in the ones column.

Step 9

58,126 – 19,579 = ☐

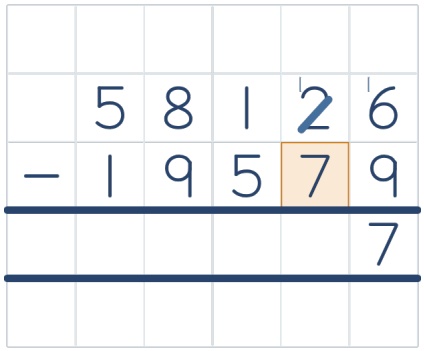

The earlier exchange left 1 ten, so we use that current value instead of the crossed-out 2.

Step 10

58,126 – 19,579 = ☐

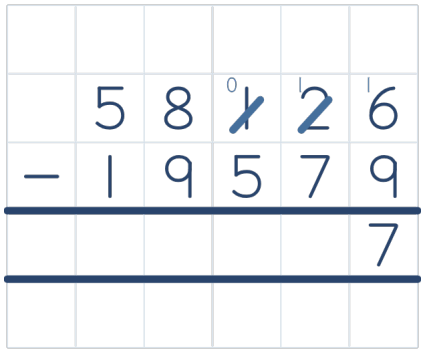

We have 1 ten and need to subtract 7 tens. Exchange 1 hundred from the 1 hundred for 10 tens. Cross out the 1 and write a small 0 at the top left of the hundreds square. We now have 0 hundreds in that column.

Step 11

58,126 – 19,579 = ☐

	5	8	0 ~~1~~	11 ~~2~~	6
–	1	9	5	7	9
					7

Write a small 1 at the top left of the tens square, beside the 1 already there. The small 1 stands for 10 more tens. Read the two digits together as 11 tens. Keep the original 1 in its place.

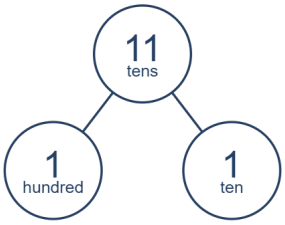

Step 12

58,126 – 19,579 = ☐

	5	8	0 ~~1~~	11 ~~2~~	6
–	1	9	5	7	9
				4	7

11 tens – 7 tens = 4 tens, so we write 4 in the tens column.

Step 13

58,126 – 19,579 = ☐

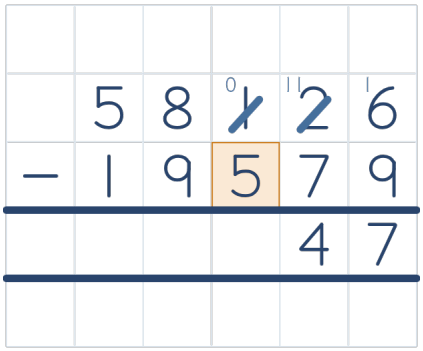

The earlier exchange left 0 hundreds, so we use that current value instead of the crossed-out 1.

Step 14

58,126 – 19,579 = ☐

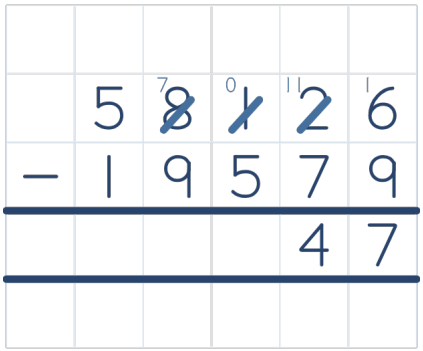

We have 0 hundreds and need to subtract 5 hundreds. Exchange 1 thousand from the 8 thousands for 10 hundreds. Cross out the 8 and write a small 7 at the top left of the thousands square. We now have 7 thousands in that column.

Step 15

58,126 – 19,579 = ☐

	5	7 ~~8~~	10 ~~1~~	11 ~~2~~	6
–	1	9	5	7	9
				4	7

Write a small 1 at the top left of the hundreds square, beside the 0 already there. The small 1 stands for 10 more hundreds. Read the two digits together as 10 hundreds. Keep the original 0 in its place.

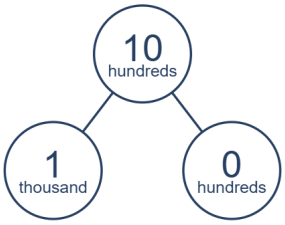

Step 16

58,126 – 19,579 = ☐

	5	7 ~~8~~	10 ~~1~~	11 ~~2~~	6
–	1	9	5	7	9
			5	4	7

10 hundreds – 5 hundreds = 5 hundreds, so we write 5 in the hundreds column.

Step 17

58,126 – 19,579 = ☐

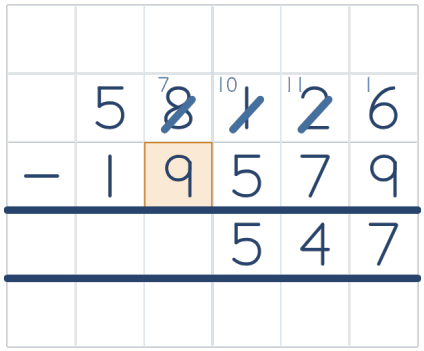

The earlier exchange left 7 thousands, so we use that current value instead of the crossed-out 8.

Step 18

58,126 – 19,579 = ☐

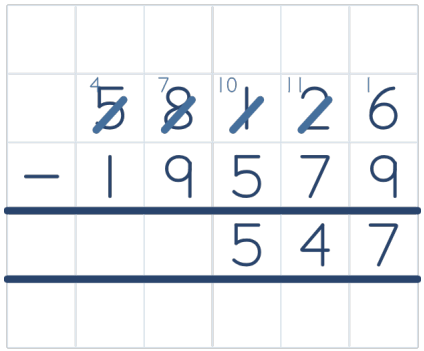

We have 7 thousands and need to subtract 9 thousands. Exchange 1 ten thousand from the 5 ten thousands for 10 thousands. Cross out the 5 and write a small 4 at the top left of the ten thousands square. We now have 4 ten thousands in that column.

Step 19

58,126 – 19,579 = ☐

	4	17	10	11	
	~~5~~	~~8~~	~~1~~	~~2~~	6
–	1	9	5	7	9
			5	4	7

Write a small 1 at the top left of the thousands square, beside the 7 already there. The small 1 stands for 10 more thousands. Read the two digits together as 17 thousands. Keep the original 7 in its place.

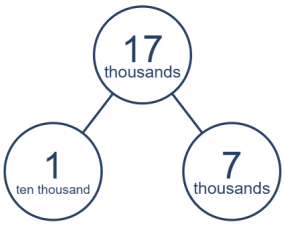

Step 20

58,126 – 19,579 = ☐

	4	17	10	11	
	~~5~~	~~8~~	~~1~~	~~2~~	6
–	1	9	5	7	9
		8	5	4	7

17 thousands – 9 thousands = 8 thousands, so we write 8 in the thousands column.

Step 21

58,126 – 19,579 = ☐

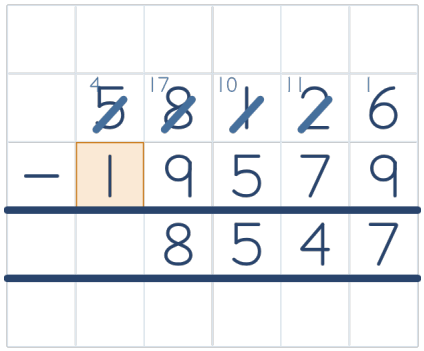

The earlier exchange left 4 ten thousands, so we use that current value instead of the crossed-out 5.

Step 22

58,126 – 19,579 = ☐

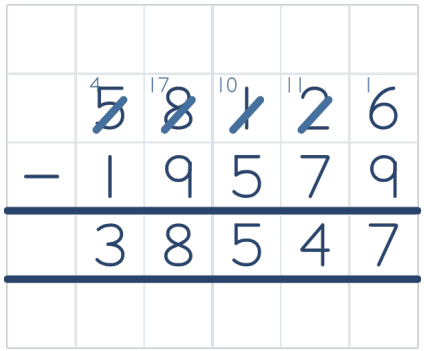

Finally, we subtract the ten thousands, which is 4 ten thousands – 1 ten thousand. 4 ten thousands – 1 ten thousand = 3 ten thousands, so we write 3 in the ten thousands column. No exchange is needed this time.

Step 23

58,126 – 19,579 = ☐

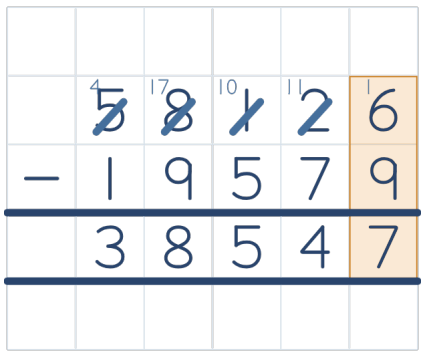

Our difference is 38,547. Before we copy our answer into the answer box, let's check each column, including the exchanges. First, we check the ones: 16 ones – 9 ones = 7 ones. We have correctly written 7 in the ones answer box.

Step 24

58,126 – 19,579 = ☐

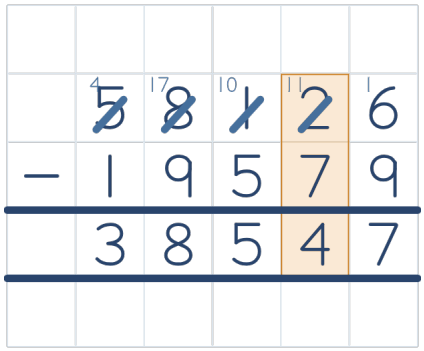

Next, we check the tens: 11 tens – 7 tens = 4 tens. We have correctly written 4 in the tens answer box.

Step 25

58,126 – 19,579 = ☐

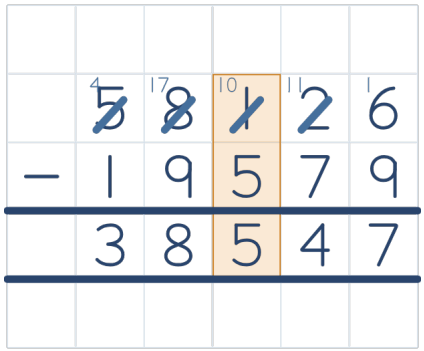

Then, we check the hundreds: 10 hundreds – 5 hundreds = 5 hundreds. We have correctly written 5 in the hundreds answer box.

Step 26

58,126 – 19,579 = ☐

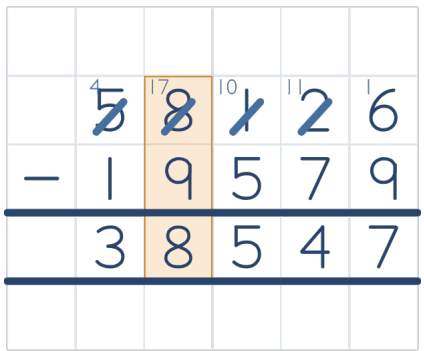

Then, we check the thousands: 17 thousands – 9 thousands = 8 thousands. We have correctly written 8 in the thousands answer box.

Step 27

58,126 – 19,579 = ☐

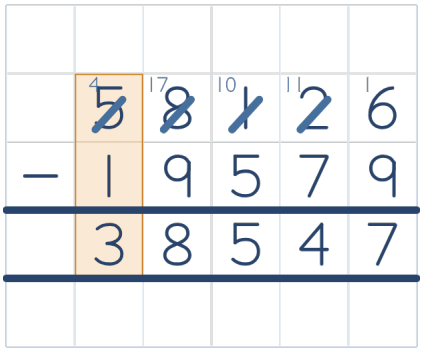

Finally, we check the ten thousands: 4 ten thousands – 1 ten thousand = 3 ten thousands. We have correctly written 3 in the ten thousands answer box.

Step 28

58,126 – 19,579 = **38547**

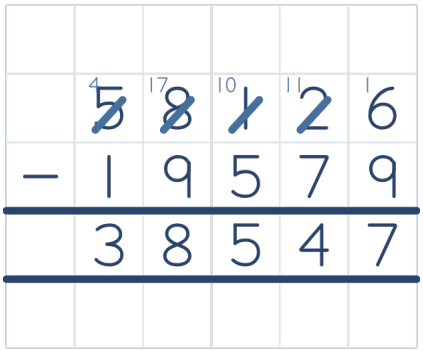

The difference is 38547. Copy 38547 into the answer box. Make sure you copy the answer correctly.

Step 29

58,126 – 19,579 = **38547**

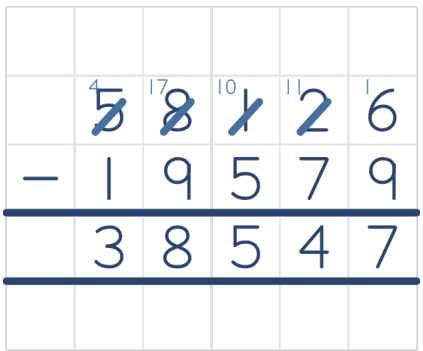

We can round to check whether our difference makes sense. Round 58,126 to 58,000 and 19,579 to 20,000, both to the nearest thousand. 58,000 – 20,000 = 38,000. Each number changes by at most 500. Our exact answer, 38,547, is within 1,000 of the estimate.

Year 6 - Column Subtraction with Decimals — Lesson Guide

Step 1

34.3 – 26.44 = ☐



First, we circle the minus sign so we know to subtract and find the difference.

Step 2

34.3 – 26.44 = ☐



First, check whether a mental method would be quicker. Line up the decimal points in 34.3 and 26.44 so matching places are in the same column. In the hundredths column, 34.3 has 0 hundredths. We need to subtract 4 hundredths. Column subtraction helps us record the exchange.

Step 3

34.3 – 26.44 = ☐

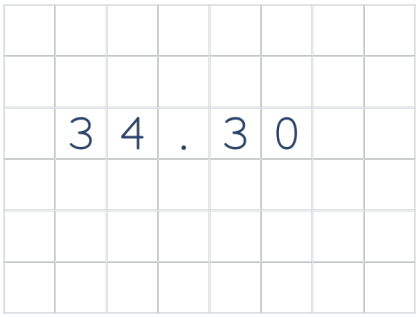

Remember: Line up the decimal points. Each digit goes in its own place-value column.

Write 34.3, with the decimal point between the ones and tenths. Put 0 in the hundredths column to show the empty decimal places. 34.3 and 34.30 have the same value.

Step 4

34.3 – 26.44 = ☐

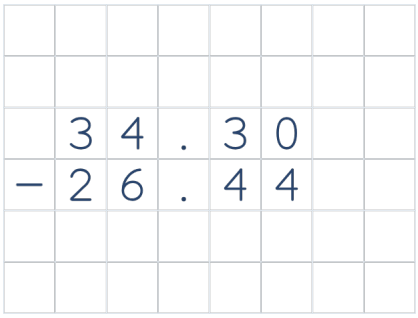

Then, we write a minus sign on the left of the calculation. We write 26.44 below 34.30, lining up the decimal points.

Step 5

34.3 – 26.44 = ☐

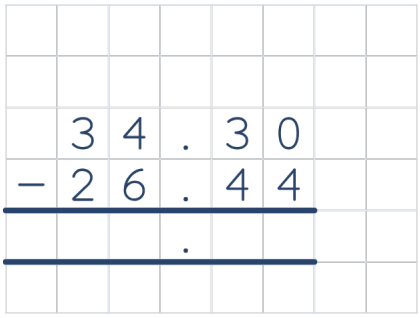

Draw a line under 26.44. Leave one row for the difference, then draw the second line below that row. Write the decimal point in the answer row, directly below the other decimal points.

Step 6

34.3 – 26.44 = ☐

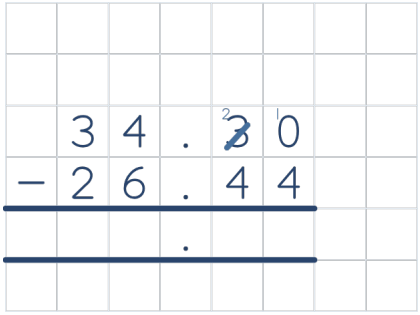

Remember: One tenth is equivalent to ten hundredths. Check both changed squares.

We need to subtract 4 hundredths, but we only have 0 hundredths. Exchange 1 tenth for 10 hundredths. Cross out the 3 and record 2 tenths in the tenths column. Write a small 1 at the top left of the hundredths square, beside the 0 already there. Read the two digits together as 10 hundredths. Keep the original 0 in its place.

Step 7

34.3 – 26.44 = ☐

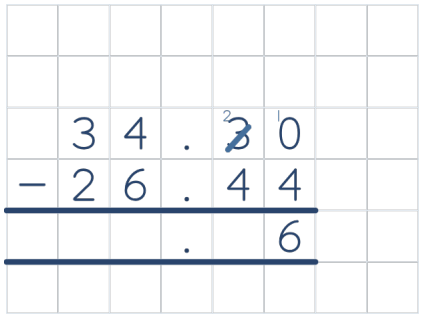

First, we subtract the hundredths, the smallest place-value column. 10 hundredths – 4 hundredths = 6 hundredths. We write 6 in the hundredths answer box.

Step 8

34.3 – 26.44 = ☐

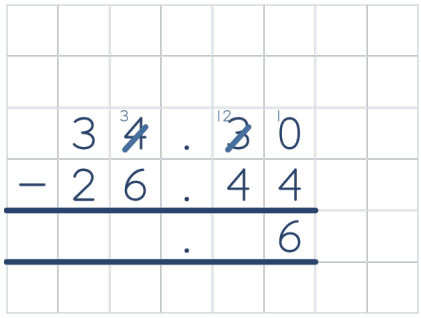

Remember: One one is equivalent to ten tenths. Check both changed squares.

We need to subtract 4 tenths, but we only have 2 tenths. Exchange 1 one for 10 tenths. Cross out the 4 and record 3 ones in the ones column. Write a small 1 at the top left of the tenths square, beside the 2 already there. Read the two digits together as 12 tenths. Keep the original 2 in its place.

Step 9

34.3 – 26.44 = ☐

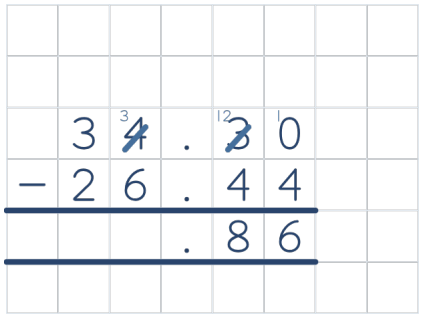

Next, we subtract the tenths. 12 tenths – 4 tenths = 8 tenths. We write 8 in the tenths answer box.

Step 10

34.3 – 26.44 = ☐

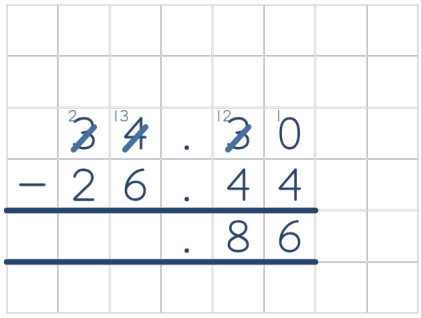

Remember: One ten is equivalent to ten ones. Check both changed squares.

We need to subtract 6 ones, but we only have 3 ones. Exchange 1 ten for 10 ones. Cross out the 3 and record 2 tens in the tens column. Write a small 1 at the top left of the ones square, beside the 3 already there. Read the two digits together as 13 ones. Keep the original 3 in its place.

Step 11

34.3 – 26.44 = ☐

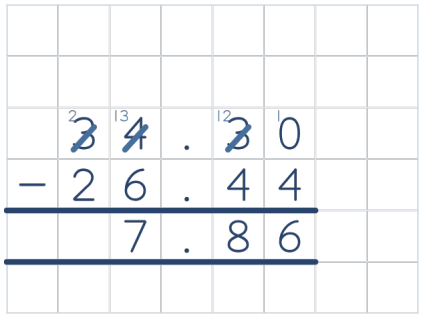

Next, we subtract the ones. 13 ones – 6 ones = 7 ones. We write 7 in the ones answer box.

Step 12

34.3 – 26.44 = ☐

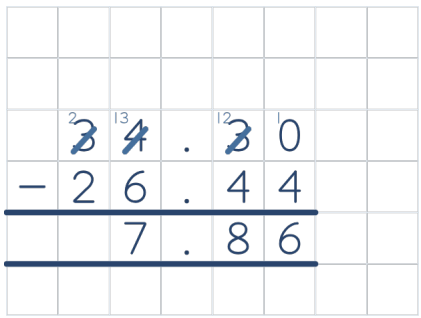

Finally, we subtract the tens. 2 tens – 2 tens = 0 tens. No exchange is needed this time. We leave this answer square empty.

Step 13

34.3 – 26.44 = ☐

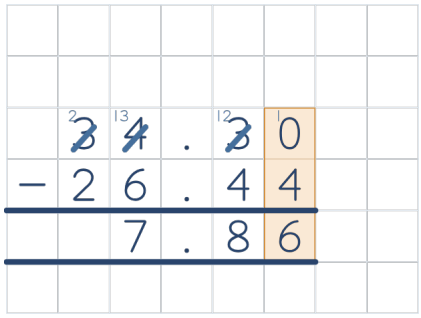

We check the hundredths column. 10 hundredths – 4 hundredths = 6 hundredths.

Step 14

34.3 – 26.44 = ☐

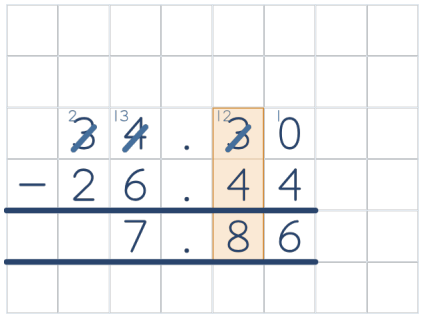

We check the tenths column. 12 tenths – 4 tenths = 8 tenths.

Step 15

34.3 – 26.44 = ☐

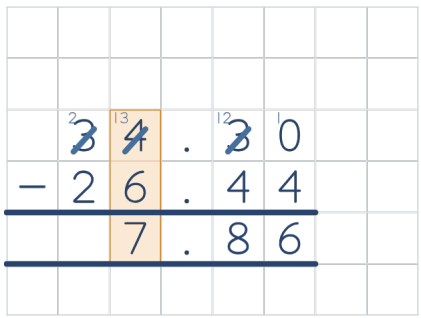

We check the ones column. 13 ones – 6 ones = 7 ones.

Step 16

34.3 – 26.44 = ☐

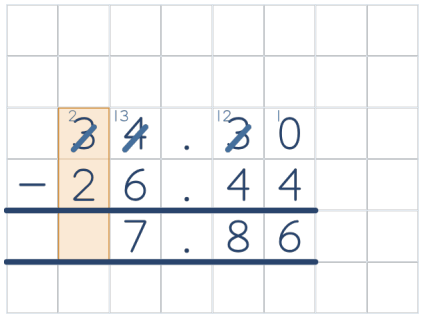

We check the tens column. 2 tens – 2 tens = 0 tens.

Step 17

34.3 – 26.44 = 7.86

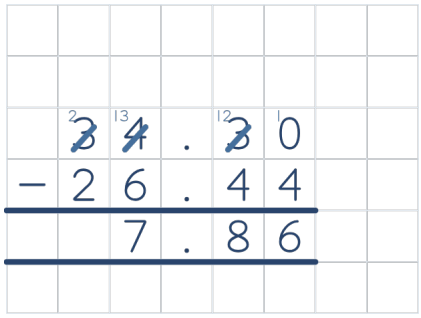

The difference is 7.86. Copy 7.86 into the answer box. Make sure you copy the answer correctly.

Year 6 - Column Multiplication — Lesson Guide

Step 1

1,142 × 2 = ☐



First, we circle the multiplication sign so we know to multiply the two factors and find their product.

Step 2

1,142 × 2 = ☐



First, check whether a mental method would be quicker. The factor 2 multiplies each place value in 1,142. Line up the digits to keep each place value in its own column. Start with 2 ones × 2.

Step 3

1,142 × 2 = ☐

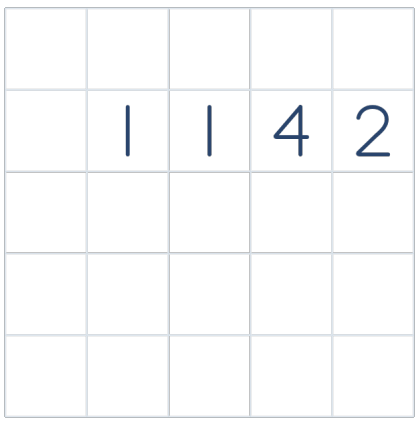

The first digit of 1,142, 1, is in the thousands column, so we start there. Now, we write 1,142 in the correct columns, with one digit in each box.

Step 4

1,142 × 2 = ☐

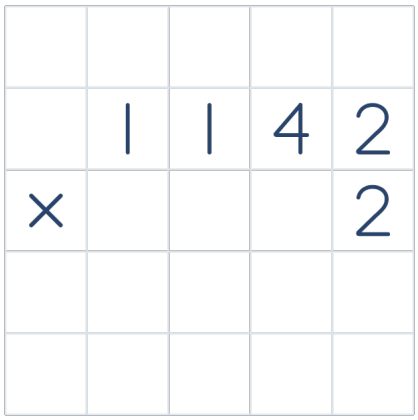

Remember: There must always be a digit in the ones column, even if it is a 0.

Then, we write the multiplication sign on the left and 2 in the ones column. We are multiplying by 2 ones.

Step 5

1,142 × 2 = ☐

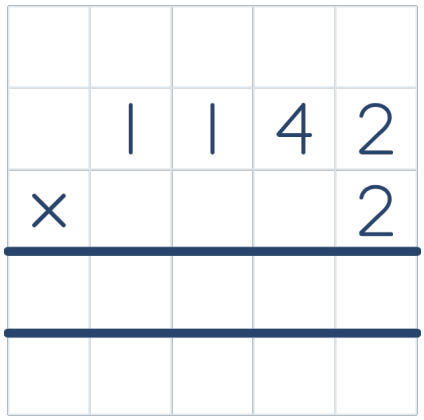

Draw a line under 2. Leave one row for the product, then draw the second line below that row. Write exchanges below the second line.

Step 6

1,142 × 2 = ☐

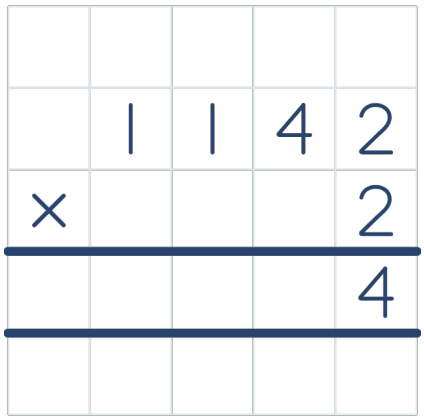

First, we multiply the ones, the smallest place-value column. 2 ones × 2 = 4 ones. We write 4 in the ones column. No exchange is needed this time.

Step 7

1,142 × 2 = ☐

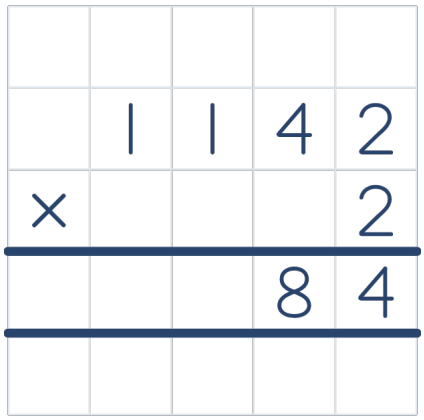

Remember: Check whether there is an exchange to add from the previous column. Include it before writing this answer.

Next, we multiply the tens. 4 tens × 2 = 8 tens. We write 8 in the tens column. No exchange is needed this time.

Step 8

1,142 × 2 = ☐

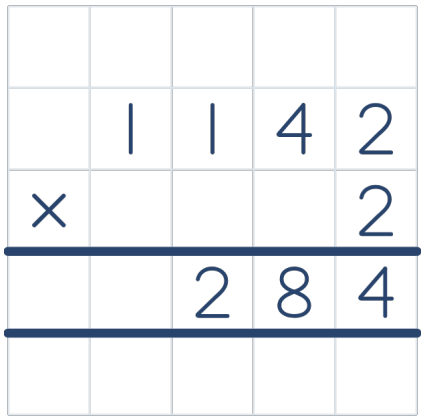

Remember: Check whether there is an exchange to add from the previous column. Include it before writing this answer.

Next, we multiply the hundreds. 1 hundred × 2 = 2 hundreds. We write 2 in the hundreds column. No exchange is needed this time.

Step 9

1,142 × 2 = ☐

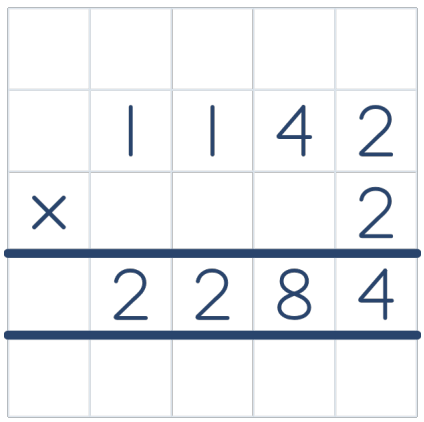

Remember: Check whether there is an exchange to add from the previous column. Include it before writing this answer.

Finally, we multiply the thousands. 1 thousand × 2 = 2 thousands. We write 2 in the thousands column. No exchange is needed this time.

Step 10

1,142 × 2 = ☐

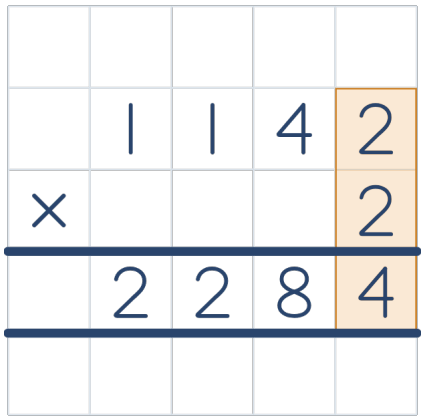

Our product is 2,284. Before we copy our answer into the answer box, let's check each column, including the exchanges. First, we check the ones: 2 ones × 2 = 4 ones. We have correctly written 4 in the answer row, using the correct place-value columns.

Step 11

1,142 × 2 = ☐

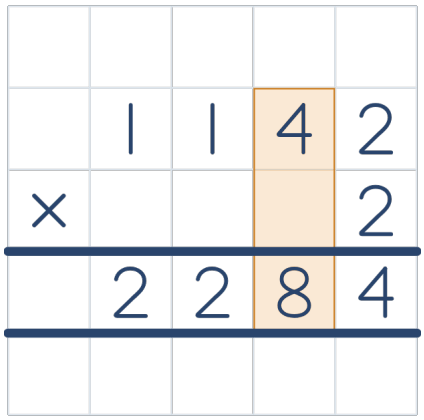

Next, we check the tens: 4 tens × 2 = 8 tens. We have correctly written 8 in the answer row, using the correct place-value columns.

Step 12

1,142 × 2 = ☐

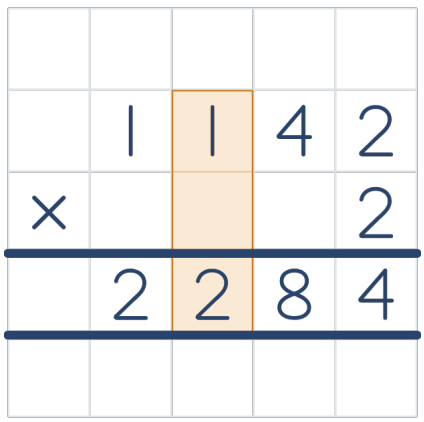

Next, we check the hundreds: 1 hundred × 2 = 2 hundreds. We have correctly written 2 in the answer row, using the correct place-value columns.

Step 13

1,142 × 2 = ☐

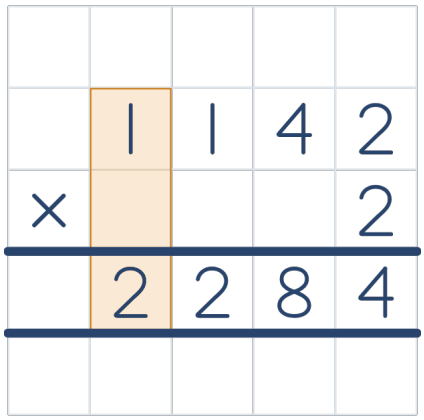

Finally, we check the thousands: 1 thousand × 2 = 2 thousands. We have correctly written 2 in the answer row, using the correct place-value columns.

Step 14

1,142 × 2 = 2284

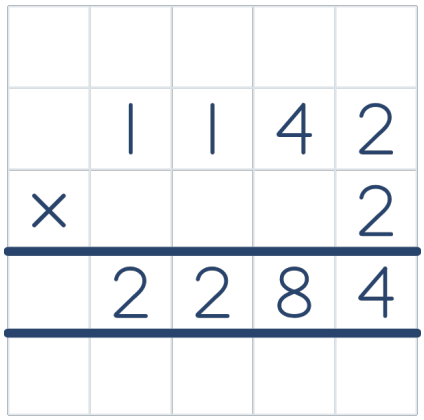

The product is 2284. Copy 2284 into the answer box. Make sure you copy the answer correctly.

Year 6 - Long Multiplication — Lesson Guide

Step 1

235 × 17 = ☐



First, we circle the multiplication sign so we know to multiply the two factors and find their product.

Step 2

235 × 17 = ☐



First, check whether a mental method would be quicker. Split 17 into 10 and 7. The first product is 235 × 7. The second product is 235 × 10. Add the two products to find 235 × 17.

Step 3

235 × 17 = ☐



The first digit of 235, 2, is in the hundreds column, so we start there. Now, we write 235 in the correct columns, with one digit in each box.

Step 4

235 × 17 = ☐

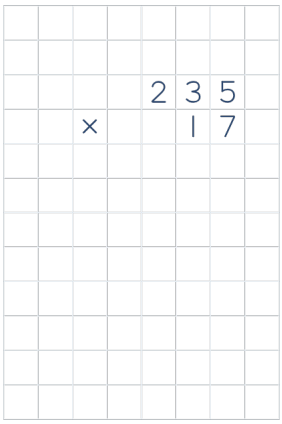

Remember: There must always be a digit in the ones column, even if it is a 0.

Then, we write the multiplication sign on the left. We write 17 below 235, with 1 in the tens column and 7 in the ones column.

Step 5

235 × 17 = ☐

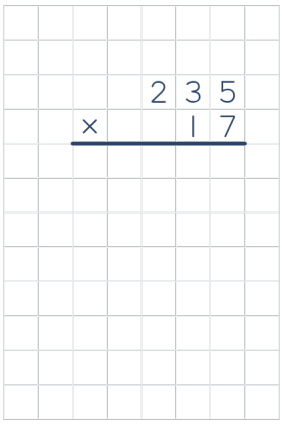

After that, we draw a line below the factors. We leave two rows for the products.

Step 6

235 × 17 = ☐

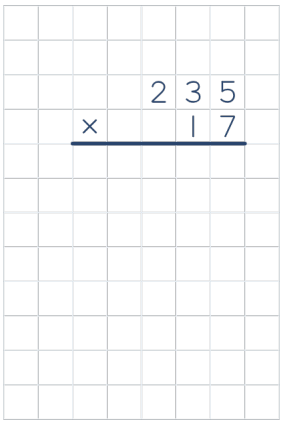

First, we multiply the ones, the smallest place-value column. 5 ones × 7 = 35 ones. As we can only write one digit per box, we partition 35 ones into 3 tens and 5 ones.

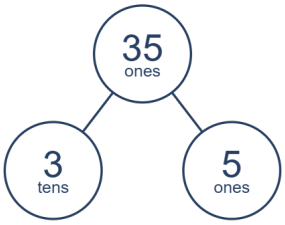

Step 7

235 × 17 = ☐

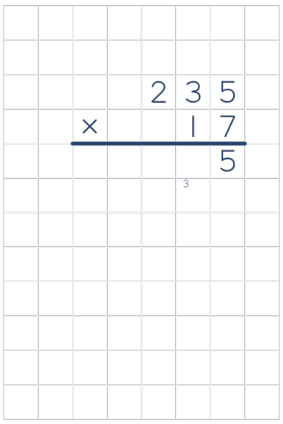

We write the 3 tens in the tens column underneath the answer, ready for the next step. Then we write the remaining 5 ones in the ones square of the first product row.

Step 8

235 × 17 = ☐

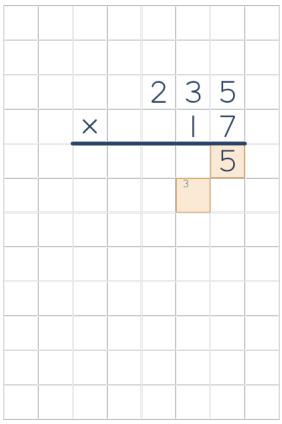

Remember: Check both places. Keep the small 3 below the tens column and the 5 in the ones answer square.

The small 3 below the tens column stands for 3 tens. The 5 in the ones answer square stands for 5 ones. Together, they make 35 ones.

Step 9

235 × 17 = ☐

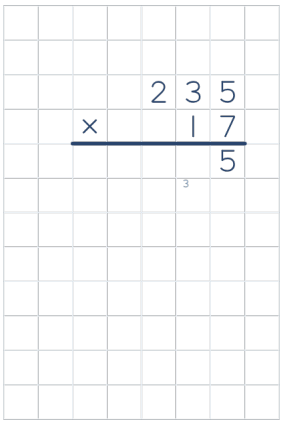

Remember: Each product has its own exchanges. Use only the small exchange digits for the product row you are working on.

Next, we multiply the tens. 3 tens × 7 = 21 tens. Add the 3 exchanged tens shown by the small 3 below the tens column. 21 tens + 3 exchanged tens = 24 tens. As we can only write one digit per box, we partition 24 tens into 2 hundreds and 4 tens.

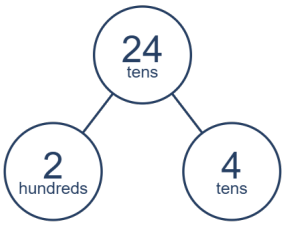

Step 10

235 × 17 = ☐

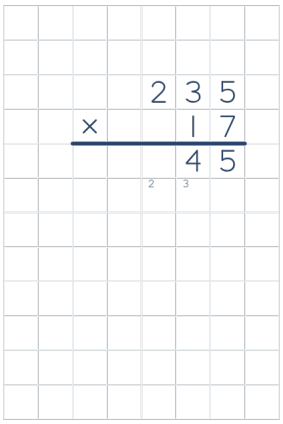

We write the 2 hundreds in the hundreds column underneath the answer, ready for the next step. Then we write the remaining 4 tens in the tens square of the first product row.

Step 11

235 × 17 = ☐

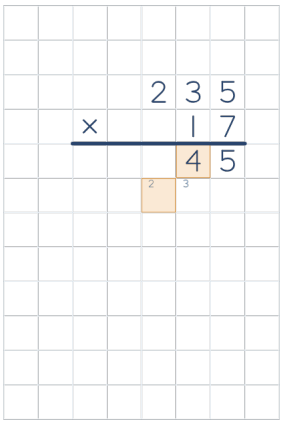

Remember: Check both places. Keep the small 2 below the hundreds column and the 4 in the tens answer square.

The small 2 below the hundreds column stands for 2 hundreds. The 4 in the tens answer square stands for 4 tens. Together, they make 24 tens.

Step 12

235 × 17 = ☐

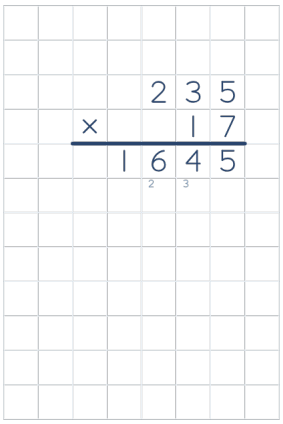

Remember: Each product has its own exchanges. Use only the small exchange digits for the product row you are working on.

Finally, we multiply the hundreds. 2 hundreds × 7 = 14 hundreds. Add the 2 exchanged hundreds shown by the small 2 below the hundreds column. 14 hundreds + 2 exchanged hundreds = 16 hundreds. This is the last column, so we write 1 thousand and 6 hundreds directly in the answer row, with one digit in each box.

Step 13

235 × 17 = ☐

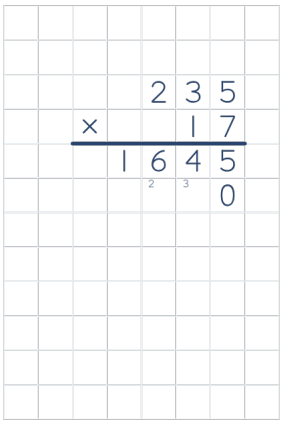

Remember: The tens digit stands for a number of tens. A product of a whole number and a number of tens has 0 ones.

The 1 in the tens column of 17 is worth 10. The second product row is for 235 × 10. Write 0 in the ones square of that row before you multiply. The zero holds the ones place.

Step 14

235 × 17 = ☐

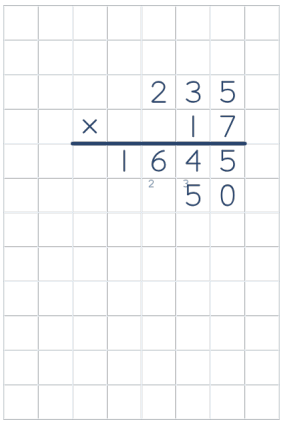

First, we multiply the ones, the smallest place-value column. 5 ones × 10 = 5 tens. We write 5 in the tens square of the second product row. No exchange is needed this time.

Step 15

235 × 17 = ☐

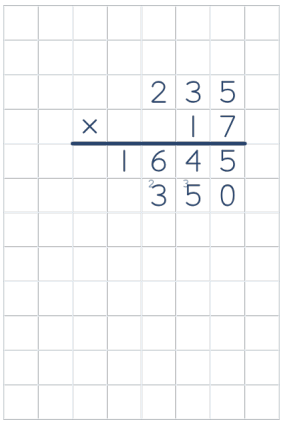

Remember: Each product has its own exchanges. Use only the small exchange digits for the product row you are working on.

Next, we multiply the tens. 3 tens × 10 = 3 hundreds. We write 3 in the hundreds square of the second product row. No exchange is needed this time.

Step 16

235 × 17 = ☐

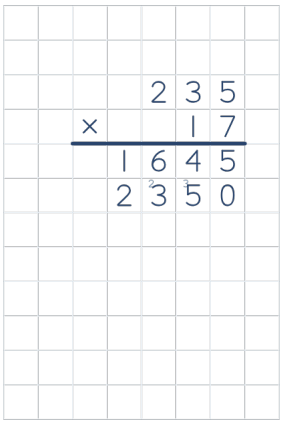

Remember: Each product has its own exchanges. Use only the small exchange digits for the product row you are working on.

Finally, we multiply the hundreds. 2 hundreds × 10 = 2 thousands. We write 2 in the thousands square of the second product row. No exchange is needed this time.

Step 17

235 × 17 = ☐

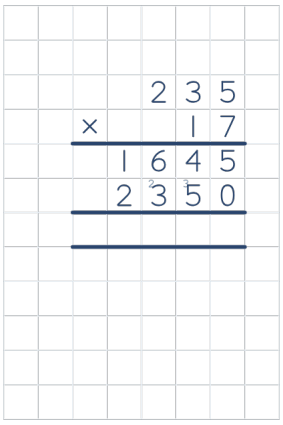

Draw a line under the two products. Leave one row for the sum, then draw the second line below that row. Write exchanges below the second line.

Step 18

235 × 17 = ☐

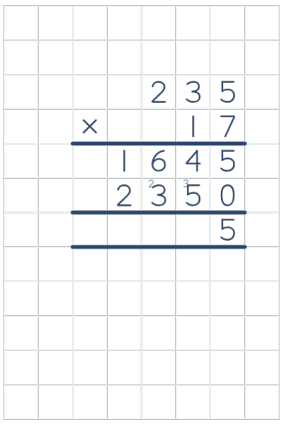

First, we add the ones, the smallest place-value column. 5 ones + 0 ones = 5 ones. We write 5 in the ones answer box. No exchange is needed this time.

Step 19

235 × 17 = ☐

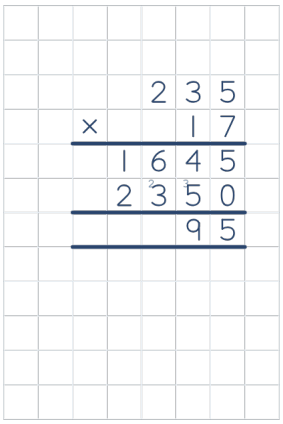

Remember: Check whether there is an exchange to add from the previous column. Include it before writing this answer.

Next, we add the tens. 4 tens + 5 tens = 9 tens. We write 9 in the tens answer box. No exchange is needed this time.

Step 20

235 × 17 = ☐

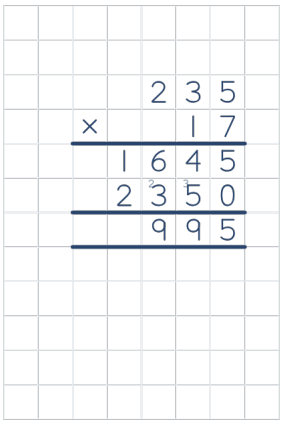

Remember: Check whether there is an exchange to add from the previous column. Include it before writing this answer.

Next, we add the hundreds. 6 hundreds + 3 hundreds = 9 hundreds. We write 9 in the hundreds answer box. No exchange is needed this time.

Step 21

235 × 17 = ☐

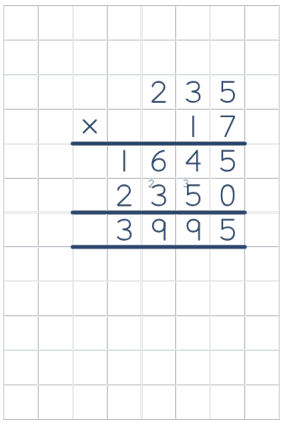

Remember: Check whether there is an exchange to add from the previous column. Include it before writing this answer.

Next, we add the thousands. 1 thousand + 2 thousands = 3 thousands. We write 3 in the thousands answer box. No exchange is needed this time.

Step 22

235 × 17 = ☐

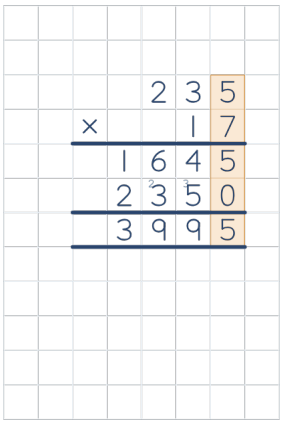

Read the first product row as 1,645. It comes from 235 × 7. Read the second product row as 2,350. It comes from 235 × 10, so it ends in 0. Next, we check the sum of the two rows, one column at a time.

Step 23

235 × 17 = ☐

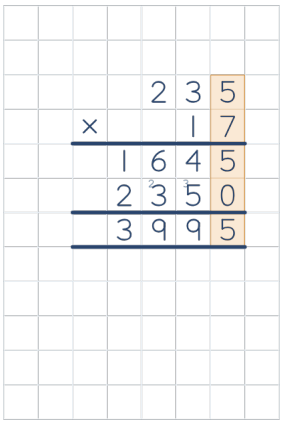

We check the ones column of the sum. 5 ones + 0 ones = 5 ones. We have written 5 in the answer box.

Step 24

235 × 17 = ☐

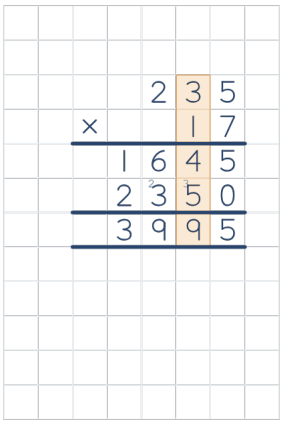

We check the tens column of the sum. 4 tens + 5 tens = 9 tens. We have written 9 in the answer box.

Step 25

235 × 17 = ☐

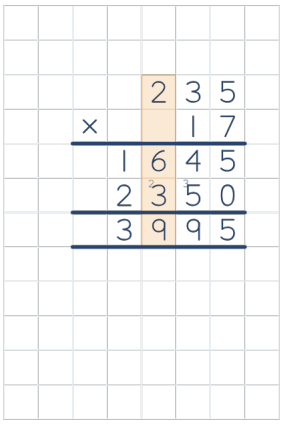

We check the hundreds column of the sum. 6 hundreds + 3 hundreds = 9 hundreds. We have written 9 in the answer box.

Step 26

235 × 17 = ☐

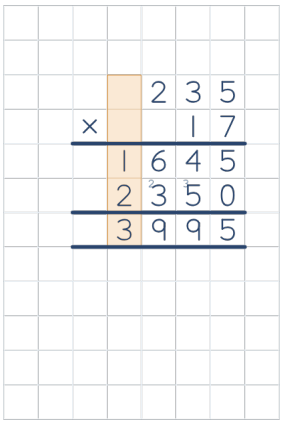

We check the thousands column of the sum. 1 thousand + 2 thousands = 3 thousands. We have written 3 in the answer box.

Step 27

235 × 17 = 3995

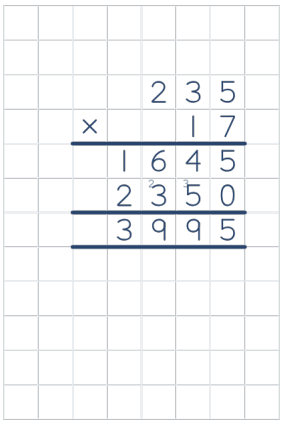

The product is 3995. Copy 3995 into the answer box. Make sure you copy the answer correctly.

Year 6 - Short Division — Lesson Guide

Step 1

1,566 ÷ 2 = ☐

First, we circle the division sign so we know to divide and find the quotient.

Step 2

1,566 ÷ 2 = ☐

First, check whether a mental method would be quicker. I can see two exchanges, so I think short division will help.

Step 3

1,566 ÷ 2 = ☐



The dividend is 1,566, the number we are dividing. We leave a row above the dividend for the quotient, our answer. The first digit of 1,566, 1, is in the thousands column, so we start there. We write 1,566 in the correct columns, with one digit in each box.

Step 4

1,566 ÷ 2 = ☐

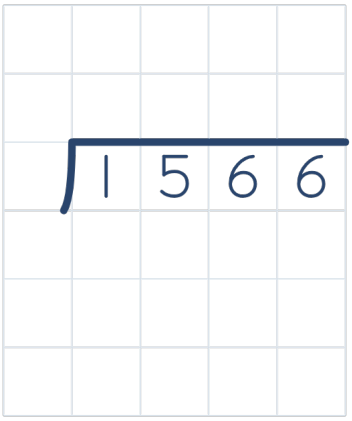

After that, we draw a short curved line on the left of the dividend and a straight line above it. We have kept the row above the line for our quotient.

Step 5

1,566 ÷ 2 = ☐

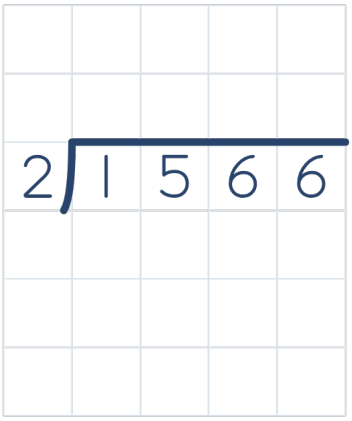

Remember: The divisor goes outside the bracket. The quotient goes above the line.

Then, we write 2 on the left of the curved line. This is the divisor, the number we are dividing by.

Step 6

1,566 ÷ 2 = ☐

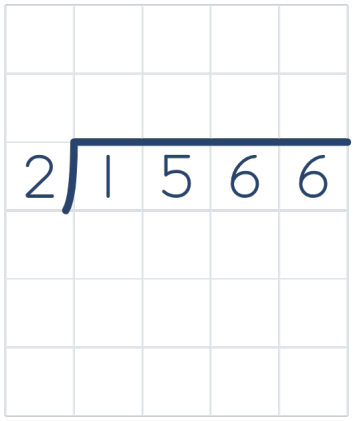

Remember: Leave unused squares before the first quotient digit empty. Once the quotient has started, write a zero when a place has no whole groups.

Start with the 1 thousand in 1,566. There are too few thousands to give each of the 2 groups one. Leave the first quotient square empty. Exchange the 1 thousand in the next step.

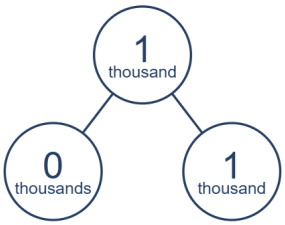

Step 7

1,566 ÷ 2 = ☐

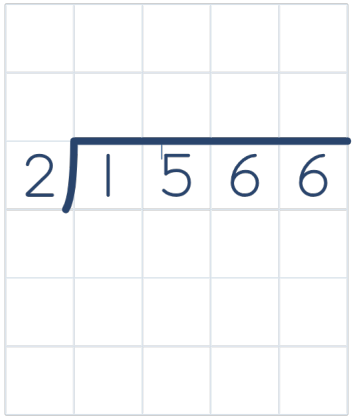

Now, we exchange the 1 thousand left over for 10 hundreds. We write a smaller 1 at the top left of the next square, to the left of the 5 already there. Together they show 15 hundreds, ready for the next step.

Step 8

1,566 ÷ 2 = ☐

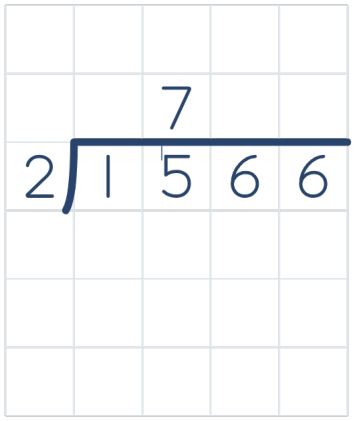

Read the small 1 and the 5 together as 15 hundreds. The small 1 stands for 10 hundreds exchanged from the thousands column. Divide 15 hundreds by 2. Each group gets 7 hundreds and 1 hundred is left over. Write 7 in the hundreds answer square above the line. We will exchange the 1 hundred left over in the next step.

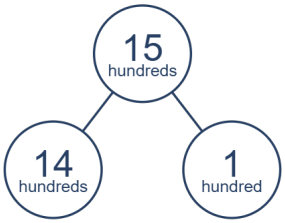

Step 9

1,566 ÷ 2 = ☐

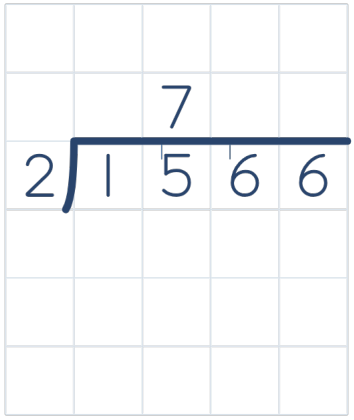

Now, we exchange the 1 hundred left over for 10 tens. We write a smaller 1 at the top left of the next square, to the left of the 6 already there. Together they show 16 tens, ready for the next step.

Step 10

1,566 ÷ 2 = ☐

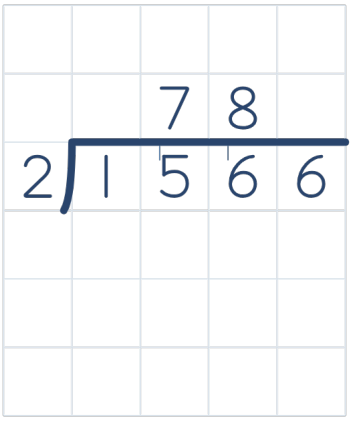

Read the small 1 and the 6 together as 16 tens. The small 1 stands for 10 tens exchanged from the hundreds column. Divide 16 tens by 2. Each group gets 8 tens. Write 8 in the tens answer square above the line.

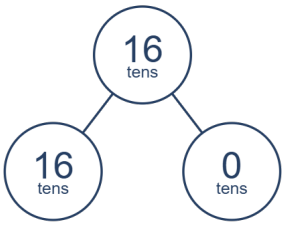

Step 11

1,566 ÷ 2 = ☐

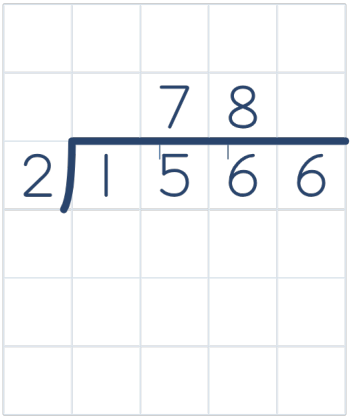

We have shared all 16 tens equally into 2 groups. There are no tens left to exchange. Move to the 6 in the ones column.

Step 12

1,566 ÷ 2 = ☐

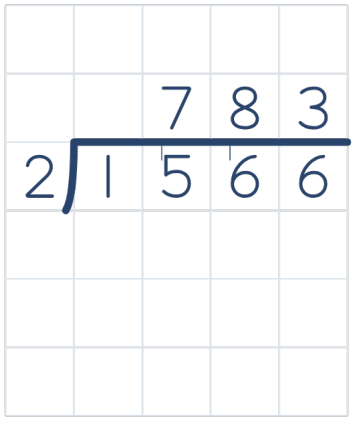

Share 6 ones equally into 2 groups. Each group gets 3 ones. Write 3 in the ones answer square above the line.

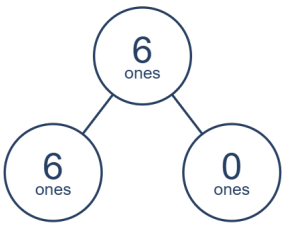

Step 13

1,566 ÷ 2 = ☐

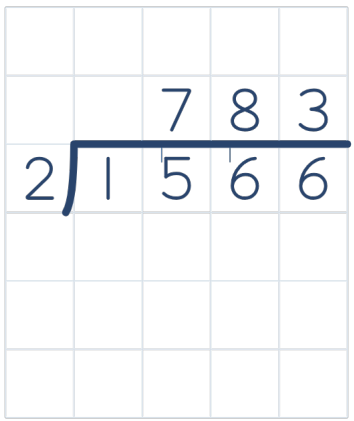

Nothing is left over, so we have finished dividing. Our quotient is 783.

Step 14

1,566 ÷ 2 = ☐

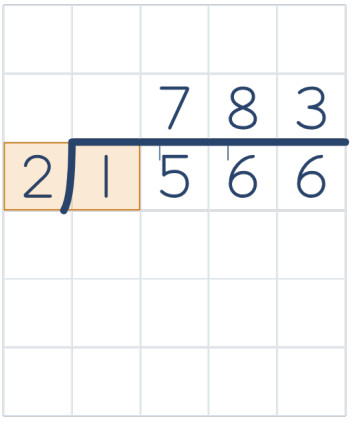

Our quotient is 783. Before we copy our answer into the answer box, let's check each column, including the exchanges. First, we check the thousands. We ask again, "How many 2s are in 1?" 0 groups of 2 make 0, with 1 left over. We have left the first quotient position empty because there are no whole groups. We have exchanged the 1 thousand left over into the next column.

Step 15

1,566 ÷ 2 = ☐

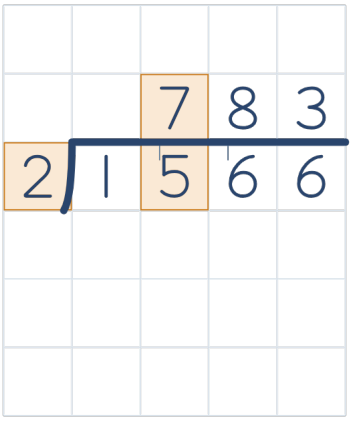

Next, we check the hundreds. We ask again, "How many 2s are in 15?" 7 groups of 2 make 14, with 1 left over. We have written 7 above this column. We have exchanged the 1 hundred left over into the next column.

Step 16

1,566 ÷ 2 = ☐

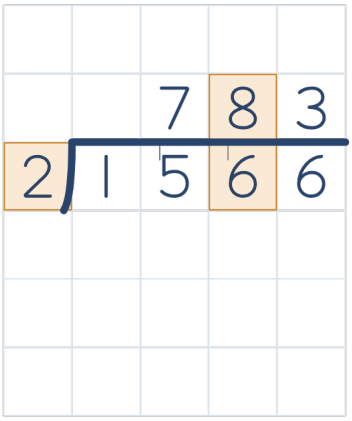

Next, we check the tens. We ask again, "How many 2s are in 16?" 8 groups of 2 make 16. We have written 8 above this column. There is nothing left over in this column.

Step 17

1,566 ÷ 2 = ☐

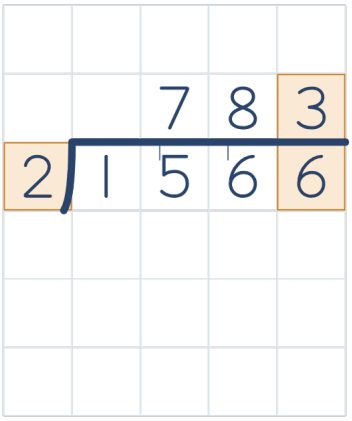

Finally, we check the ones. We ask again, “How many 2s are in 6?” 3 groups of 2 make 6. We have written 3 above this column. There is nothing left over in this column.

Step 18

1,566 ÷ 2 = **783**

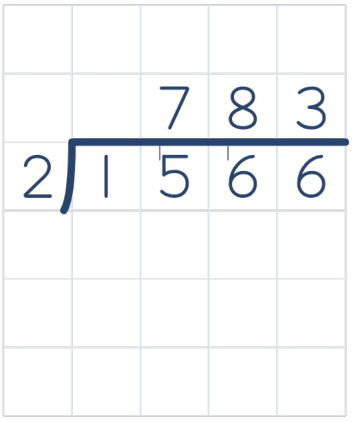

The quotient is 783. Copy 783 into the answer box. Make sure you copy the answer correctly.

Year 6 - Short Division with a Remainder — Lesson Guide

Step 1

925 ÷ 4 = ☐



First, we circle the division sign so we know to divide and find the quotient.

Step 2

925 ÷ 4 = ☐



First, check whether a mental method would be quicker. I can see one exchange, so I think short division will help.

Step 3

925 ÷ 4 = ☐

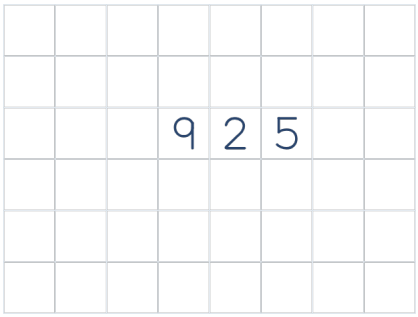

The dividend is 925, the number we are dividing. We leave a row above the dividend for the quotient, our answer. The first digit of 925, 9, is in the hundreds column, so we start there. We write 925 in the correct columns, with one digit in each box.

Step 4

925 ÷ 4 = ☐

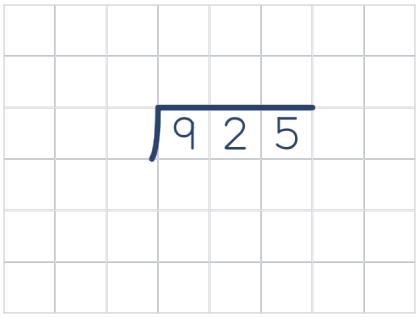

After that, we draw a short curved line on the left of the dividend and a straight line above it. We have kept the row above the line for our quotient.

Step 5

925 ÷ 4 = ☐

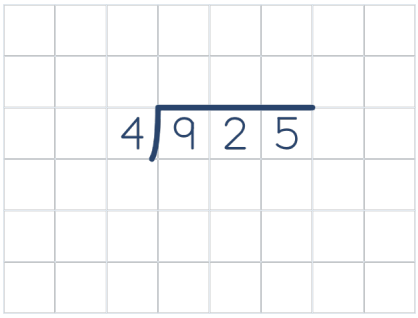

Then, we write 4 on the left of the curved line. This is the divisor, the number we are dividing by.

Step 6

925 ÷ 4 = ☐

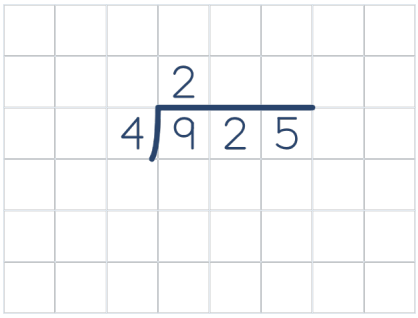

Remember: A digit above the hundreds column tells us how many hundreds are in each group.

Start at the hundreds. Share 9 hundreds equally into 4 groups. Each group gets 2 hundreds and 1 hundred is left over. Write 2 in the hundreds answer square above the line. We will exchange the 1 hundred left over in the next step.

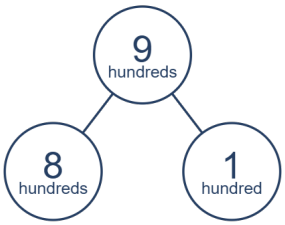

Step 7

925 ÷ 4 = ☐

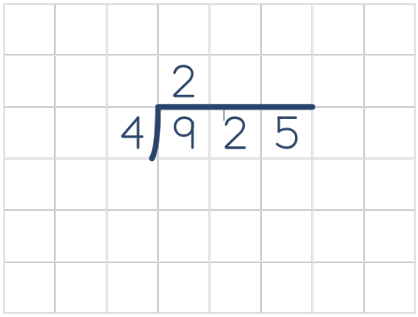

Now, we exchange the 1 hundred left over for 10 tens. We write a smaller 1 at the top left of the next square, to the left of the 2 already there. Together they show 12 tens, ready for the next step.

Step 8

925 ÷ 4 = ☐

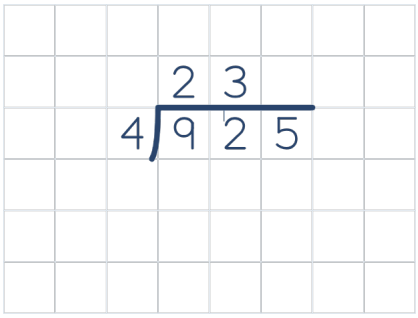

Read the small 1 and the 2 together as 12 tens. The small 1 stands for 10 tens exchanged from the hundreds column. Divide 12 tens by 4. Each group gets 3 tens. Write 3 in the tens answer square above the line.

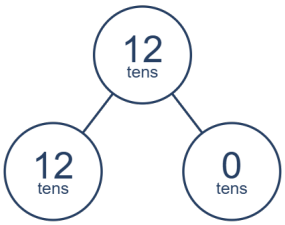

Step 9

925 ÷ 4 = ☐

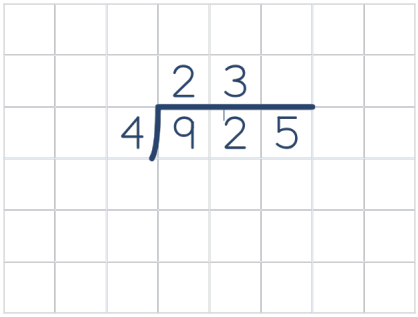

We have shared all 12 tens equally into 4 groups. There are no tens left to exchange. Move to the 5 in the ones column.

Step 10

925 ÷ 4 = ☐

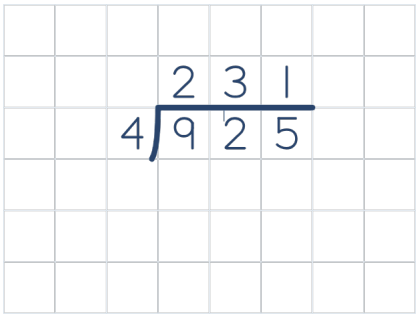

Share 5 ones equally into 4 groups. Each group gets 1 one and 1 one is left over. Write 1 in the ones answer square above the line.

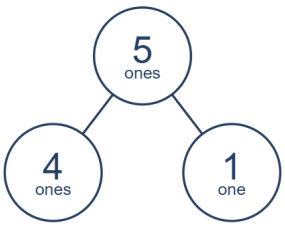

Step 11

925 ÷ 4 = ☐

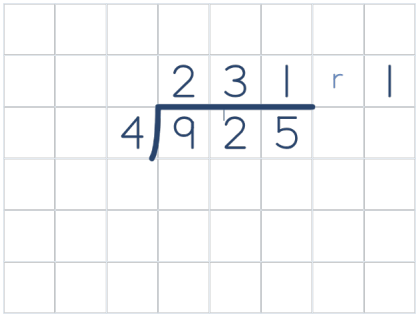

Remember: If enough is left to make another group, increase the quotient and check the remainder again.

We can make 231 groups of 4, with 1 left over. Read the quotient as 231 remainder 1. Write r followed by 1 to the right of the quotient. 1 is smaller than 4, so there is not enough for another group.

Step 12

925 ÷ 4 = ☐

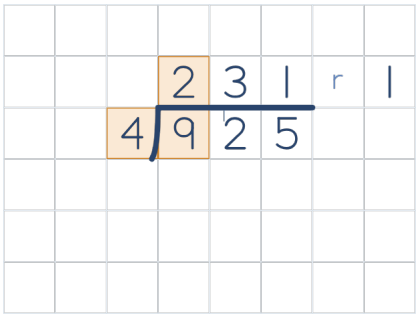

Our quotient is 231 with remainder 1. Before we copy our answer into the answer box, let's check each column, including the exchanges. First, we check the hundreds. We ask again, "How many 4s are in 9?" 2 groups of 4 make 8, with 1 left over. We have written 2 above this column. We have exchanged the 1 hundred left over into the next column.

Step 13

925 ÷ 4 = ☐

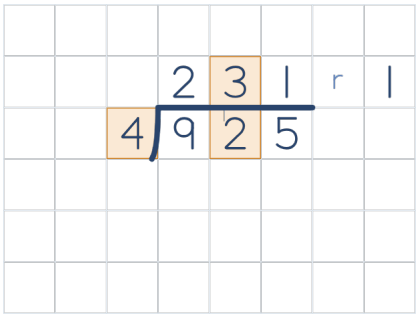

Next, we check the tens. We ask again, "How many 4s are in 12?" 3 groups of 4 make 12. We have written 3 above this column. There is nothing left over in this column.

Step 14

925 ÷ 4 = ☐

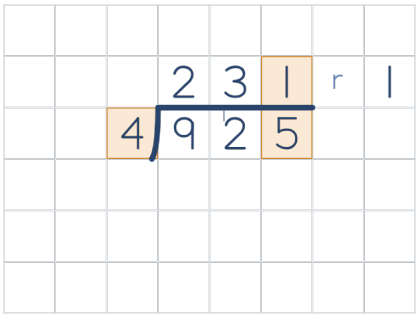

Finally, we check the ones. We ask again, "How many 4s are in 5?" 1 group of 4 makes 4, with 1 left over. We have written 1 above this column. The remainder, 1, is smaller than the divisor, 4.

Step 15

925 ÷ 4 = **231r1**

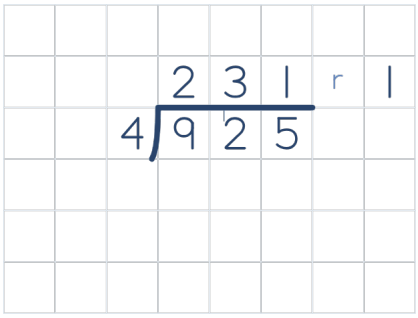

The quotient is 231, with a remainder of 1. Write 231r1 in the answer box. Make sure you copy the answer correctly.

Step 16

925 ÷ 4 = **231r1**

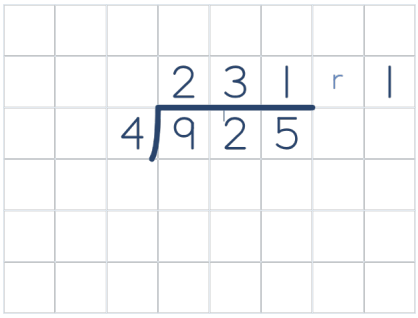

Imagine packing 925 books into boxes that hold 4 each. We can fill 231 boxes, with 1 book left over. If we need to pack every book, we need one more box. That makes 232 boxes altogether.

Step 17

925 ÷ 4 = **231r1**

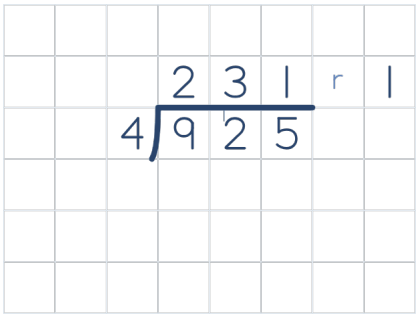

When the amount can be split further, exchange the 1 left over for 100 hundredths. Share those equally into 4 groups. Each group gets 25 hundredths, or 1 quarter, as well as 231 wholes. Each group gets 231.25 altogether.

Year 6 - Short Division with a Decimal Answer — Lesson Guide

Step 1

39 ÷ 4 = ☐ as a decimal



First, we circle the division sign so we know to divide.

Step 2

39 ÷ 4 = ☐ as a decimal

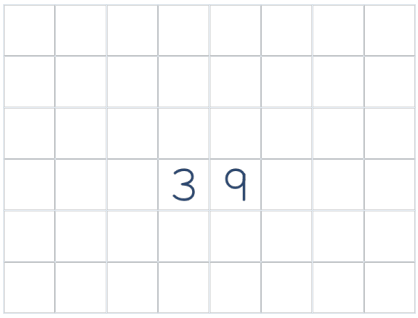

The dividend is 39, the number we are dividing. We leave a row above the dividend for the quotient, our answer. We write 39 in the correct columns, with one digit in each box.

Step 3

39 ÷ 4 = ☐ as a decimal

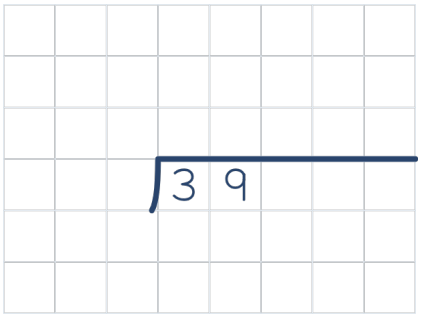

After that, we draw a short curved line on the left of the dividend and a straight line above it.

Step 4

39 ÷ 4 = ☐ as a decimal

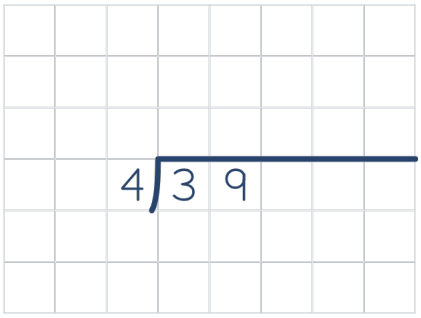

Then, we write 4 on the left of the curved line. This is the divisor, the number we are dividing by.

Step 5

39 ÷ 4 = ☐ as a decimal

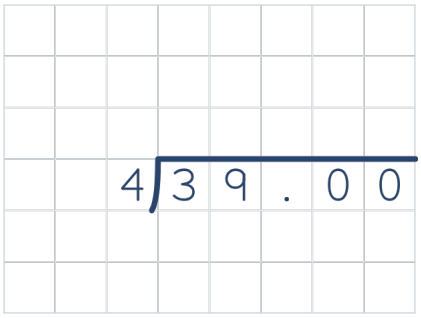

Remember: Adding zeros at the end of the decimal keeps the value the same. Keep each quotient digit above its matching column.

After the ones, put in the decimal point and 2 zeros to write 39.00 inside the bracket. This has the same value as 39, with zero tenths and hundredths to start with. The extra places let us exchange any remainder into smaller units and keep dividing.

Step 6

39 ÷ 4 = ☐ as a decimal

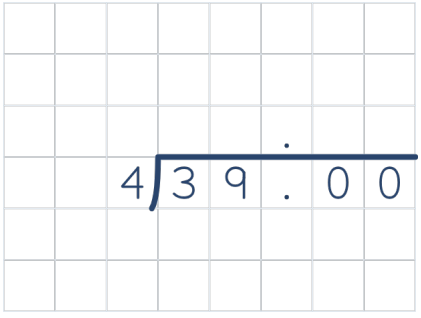

Remember: The decimal points in the dividend and quotient line up.

We write the decimal point in the quotient, directly above the decimal point in the dividend.

Step 7

39 ÷ 4 = ☐ as a decimal

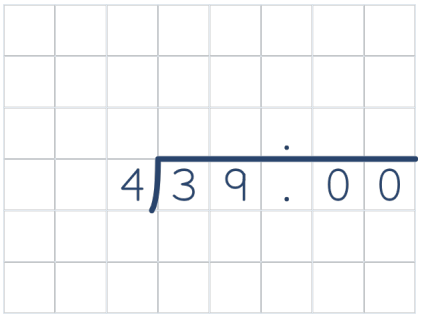

First, we divide the tens, starting on the left with the largest place value. 3 tens ÷ 4 gives 0 tens, with 3 tens left over. There are no whole groups in this column, so we leave its answer box empty.

Step 8

39 ÷ 4 = ☐ as a decimal

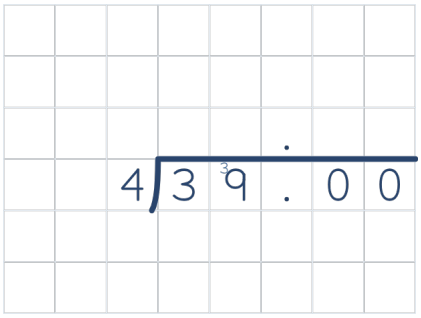

Now, we exchange the 3 tens left over for 30 ones. We write a smaller 3 at the top left of the next digit's square. Together with the 9 already there, this gives 39 ones for the next step.

Step 9

39 ÷ 4 = ☐ as a decimal

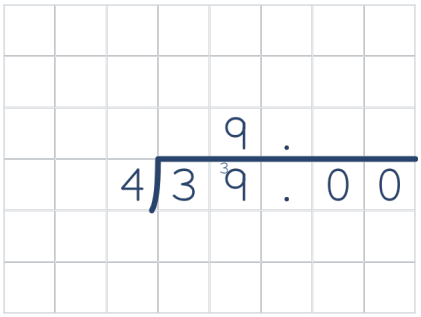

Next, we divide the ones. Read the small 3 and the 9 together as 39 ones. The small 3 stands for 30 ones exchanged from the tens column. Share 39 ones equally between 4 groups. 9 ones in each group uses 36 ones. 3 ones are left over for the next exchange. We write 9 in the ones answer box above the line.

Step 10

39 ÷ 4 = ☐ **as a decimal**

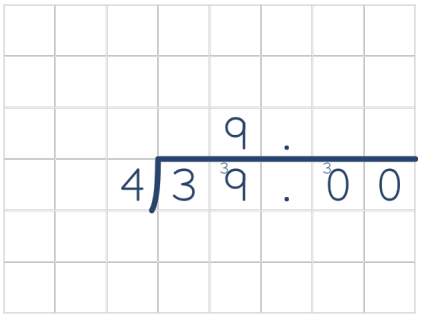

Now, we exchange the 3 ones left over for 30 tenths. We write a smaller 3 at the top left of the next digit's square. Together with the 0 already there, this gives 30 tenths for the next step.

Step 11

39 ÷ 4 = ☐ **as a decimal**

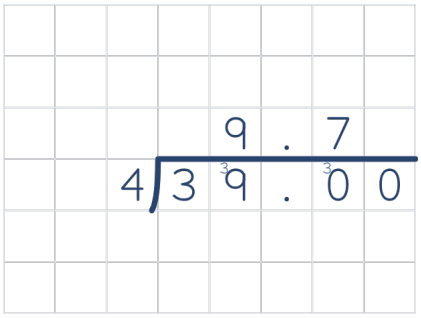

Next, we divide the tenths. Read the small 3 and the 0 together as 30 tenths. The small 3 stands for 30 tenths exchanged from the ones column. Share 30 tenths equally between 4 groups. 7 tenths in each group uses 28 tenths. 2 tenths are left over for the next exchange. We write 7 in the tenths answer box above the line.

Step 12

39 ÷ 4 = ☐ **as a decimal**

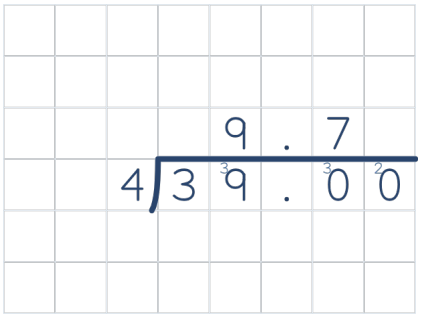

Now, we exchange the 2 tenths left over for 20 hundredths. We write a smaller 2 at the top left of the next digit's square. Together with the 0 already there, this gives 20 hundredths for the next step.

Step 13

39 ÷ 4 = ☐ **as a decimal**

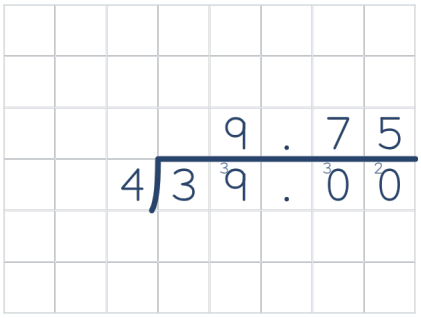

Finally, we divide the hundredths. Read the small 2 and the 0 together as 20 hundredths. The small 2 stands for 20 hundredths exchanged from the tenths column. 20 hundredths ÷ 4 gives 5 hundredths. We write 5 in the hundredths answer box above the line.

Step 14

39 ÷ 4 = ☐ **as a decimal**

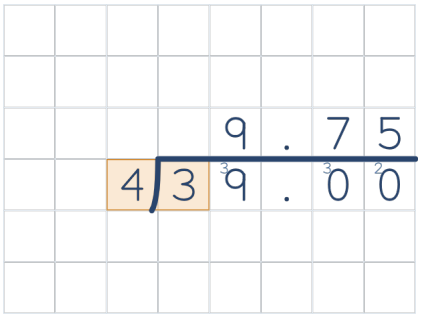

Our quotient is 9.75. Before we copy our answer into the answer box, let's check each column, including the exchanges. First, we check the tens. We ask again, "How many 4s are in 3?" 0 groups of 4 make 0, with 3 left over. We have left this quotient position empty because there are no whole groups. We have exchanged the 3 tens left over into the next column.

Step 15

39 ÷ 4 = ☐ **as a decimal**

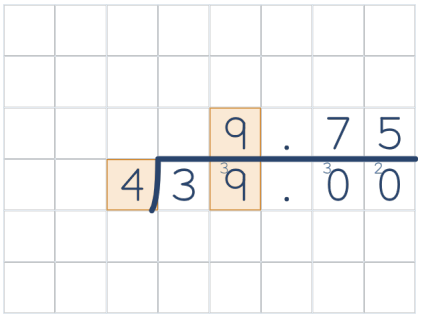

Next, we check the ones. We ask again, "How many 4s are in 39?" 9 groups of 4 make 36, with 3 left over. We have written 9 above this column. We have exchanged the 3 ones left over into the next column.

Step 16

39 ÷ 4 = ☐ **as a decimal**

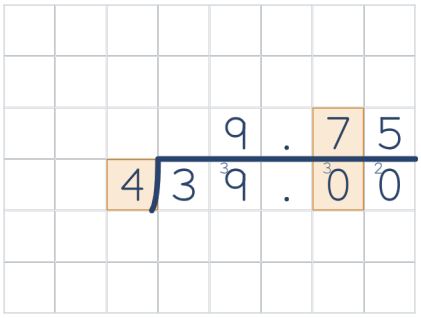

Next, we check the tenths. We ask again, “How many 4s are in 30?” 7 groups of 4 make 28, with 2 left over. We have written 7 above this column. We have exchanged the 2 tenths left over into the next column.

Step 17

39 ÷ 4 = ☐ **as a decimal**

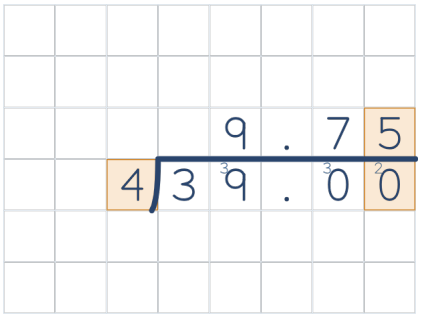

Finally, we check the hundredths. We ask again, “How many 4s are in 20?” 5 groups of 4 make 20. We have written 5 above this column. There is nothing left over in this column.

Step 18

39 ÷ 4 = **9.75** **as a decimal**

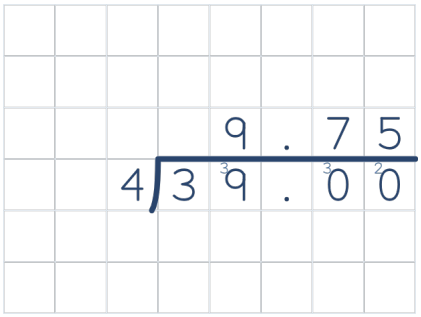

The quotient is 9.75. Copy 9.75 into the answer box. Make sure you copy the answer correctly.

Year 6 - Long Division — Lesson Guide

Step 1

1,935 ÷ 15 = ☐

First, we circle the division sign so we know to divide and find the quotient.

Step 2

1,935 ÷ 15 = ☐

Remember: If the first digit inside the bracket is smaller than the divisor, leave the first quotient square empty. Read the first two digits inside the bracket together. Choose the largest total that fits.

We are dividing by a two-digit number, so we can use long division. We find one digit of the quotient at a time.

Step 3

1,935 ÷ 15 = ☐



The dividend is 1,935, the number we are dividing. We leave a row above the dividend for the quotient, our answer. We write 1,935 in the correct columns, with one digit in each box.

Step 4

1,935 ÷ 15 = ☐

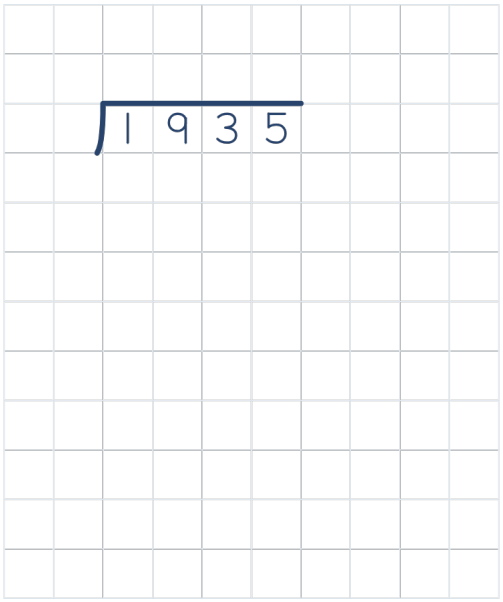

After that, we draw a short curved line on the left of the dividend and a straight line above it.

Step 5

1,935 ÷ 15 = ☐

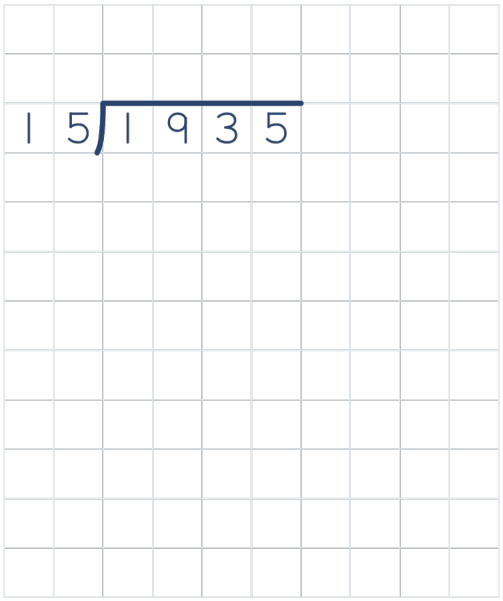

Then, we write 15 on the left of the curved line. This is the divisor, the number we are dividing by.

Step 6

1,935 ÷ 15 = ☐



Remember: Use the largest total that fits. Check the next row to see whether it is too large.

Split 15 into 10 and 5. Write 10 + 5 = 15 on the right for one group. For two groups, add two lots of 10 and two lots of 5. Write 20 + 10 = 30. Build the other rows in the same way. Write 30 + 15 = 45 for three groups. 4 lots of 10 plus 4 lots of 5 is 60. 5 lots of 10 plus 5 lots of 5 is 75. 6 lots of 10 plus 6 lots of 5 is 90. 7 lots of 10 plus 7 lots of 5 is 105. 8 lots of 10 plus 8 lots of 5 is 120. 9 lots of 10 plus 9 lots of 5 is 135. 10 lots of 10 plus 10 lots of 5 is 150.

Step 7

1,935 ÷ 15 = ☐

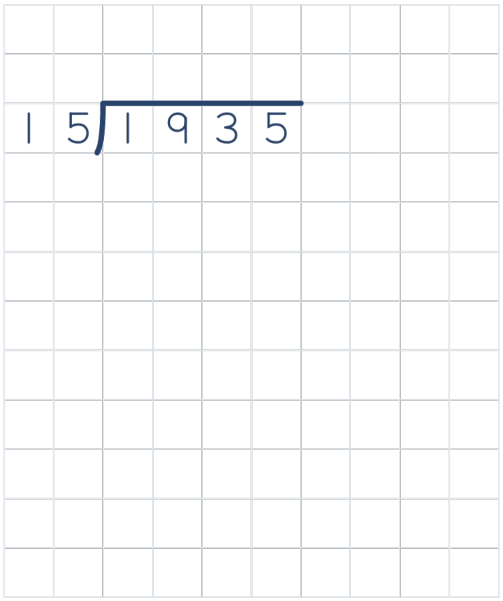

Remember: Leave unused squares before the first quotient digit empty. Once the quotient has started, write a zero when a place has no whole groups.

1 is smaller than 15. No whole group fits yet, so leave this quotient square empty.

Step 8

1,935 ÷ 15 = ☐



Remember: Leave unused squares before the first quotient digit empty. Once the quotient has started, write a zero when a place has no whole groups.

Leave the first quotient square empty because 1 is smaller than 15. Read the first two digits of 1,935 together as 19. Find the largest total in the table that fits into 19.

Step 9

1,935 ÷ 15 = ☐

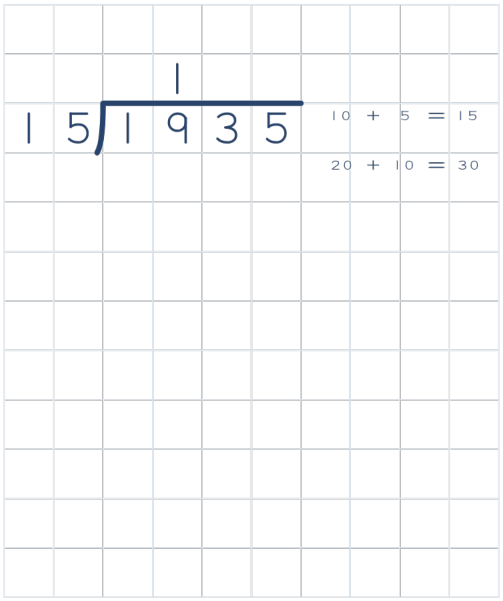

1 group makes 15, which fits into 19. 2 groups make 30, which is too large. We write 1 in the hundreds column above the line.

Step 10

1,935 ÷ 15 = ☐

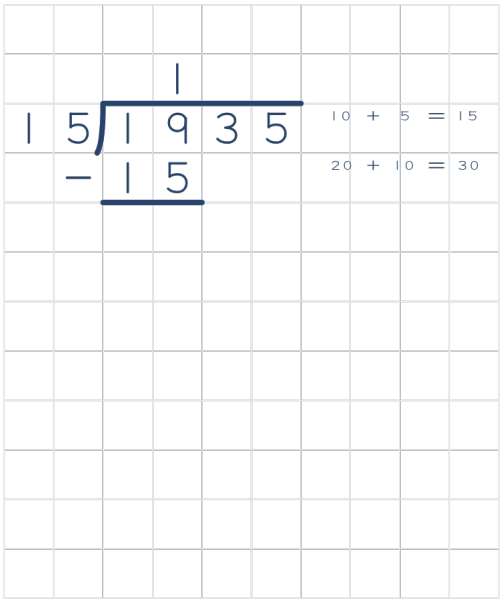

We write 15 below 19, line up the digits and write the subtraction sign. Then we draw a line underneath.

Step 11

1,935 ÷ 15 = ☐

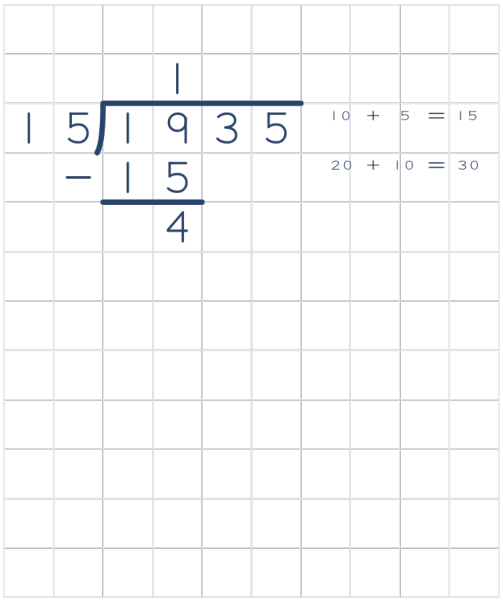

First, we subtract the hundreds in this subtraction, which is 9 hundreds – 5 hundreds. 9 hundreds – 5 hundreds = 4 hundreds, so we write 4 in the hundreds column. No exchange is needed this time.

Step 12

1,935 ÷ 15 = ☐

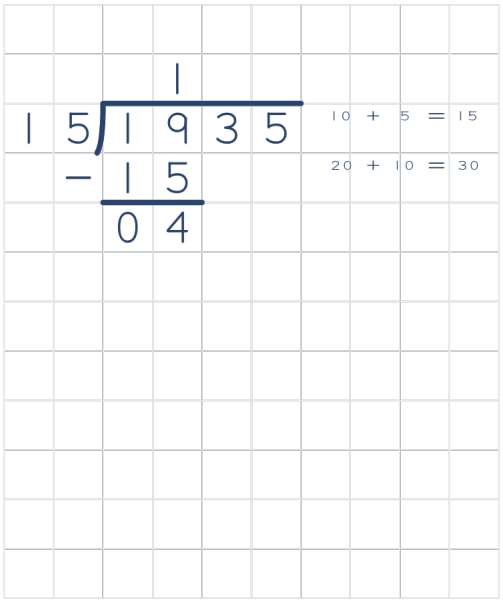

Finally, we subtract the thousands, which is 1 thousand – 1 thousand. 1 thousand – 1 thousand = 0 thousands, so we write 0 in the thousands column. No exchange is needed this time.

Step 13

1,935 ÷ 15 = ☐

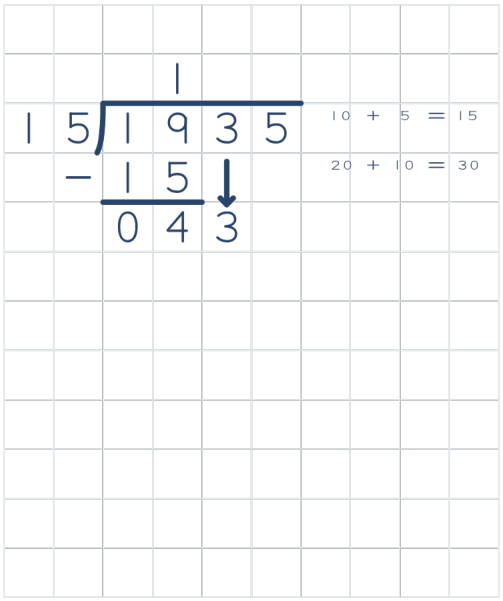

Remember: Bring down one digit at a time. Keep it in its original column.

Draw an arrow straight down from the 3 in the tens column. Copy 3 directly below, next to 4. The 4 hundreds left over become 40 tens. With the next 3 tens, we have 43 tens for the next step.

Step 14

1,935 ÷ 15 = ☐

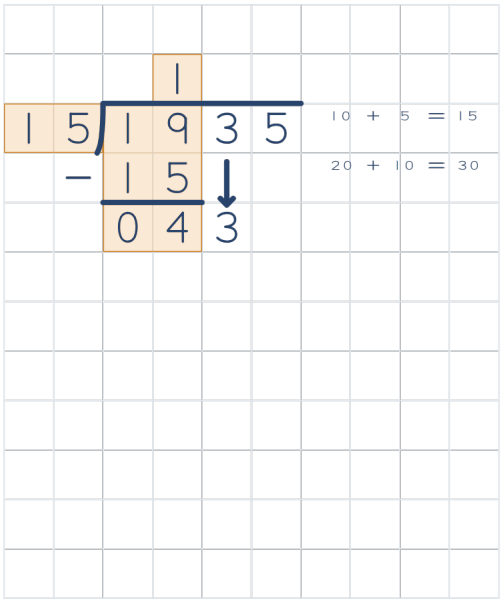

Check the subtraction for 19. 1 × 15 = 15. 19 – 15 = 4. 4 is smaller than 15. Use 4, the amount left over, for this check. The 3 we brought down is for the next division.

Step 15

1,935 ÷ 15 = ☐

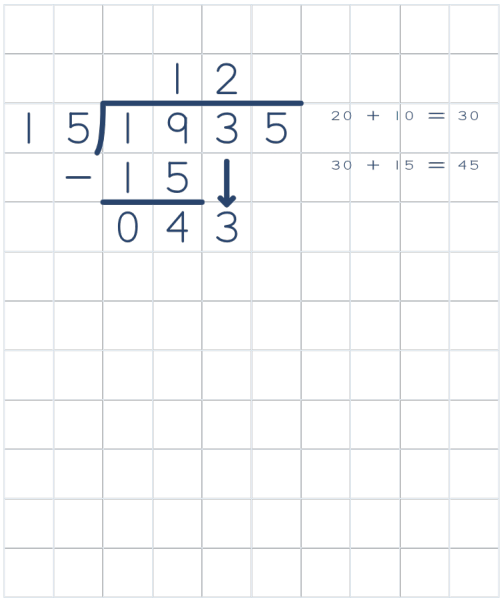

2 groups make 30, which fits into 43. 3 groups make 45, which is too large. We write 2 in the tens column above the line.

Step 16

1,935 ÷ 15 = ☐

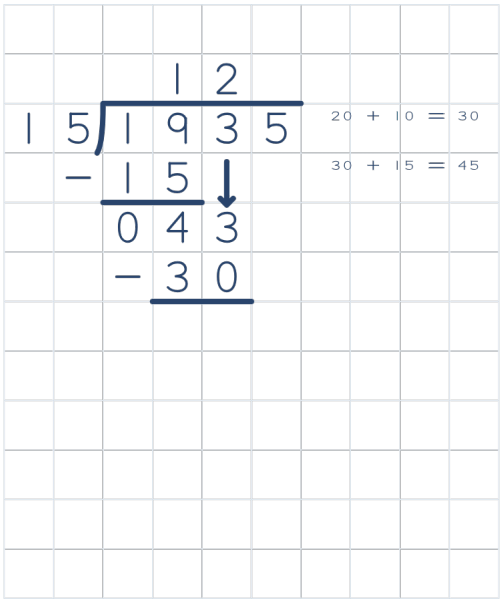

We write 30 below 43, line up the digits and write the subtraction sign. Then we draw a line underneath.

Step 17

1,935 ÷ 15 = ☐

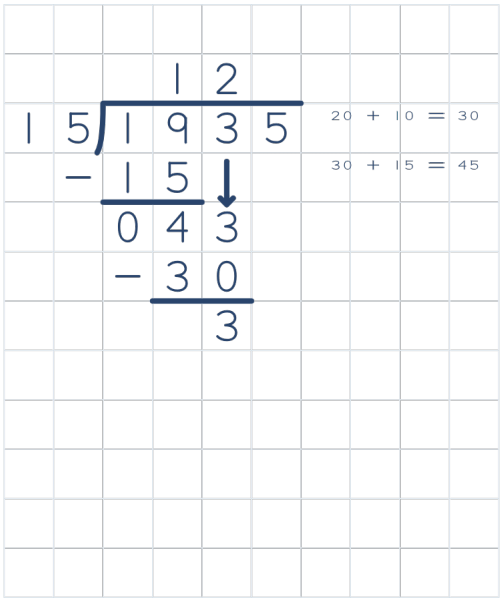

First, we subtract the tens in this subtraction, which is 3 tens – 0 tens. 3 tens – 0 tens = 3 tens, so we write 3 in the tens column. No exchange is needed this time.

Step 18

1,935 ÷ 15 = ☐

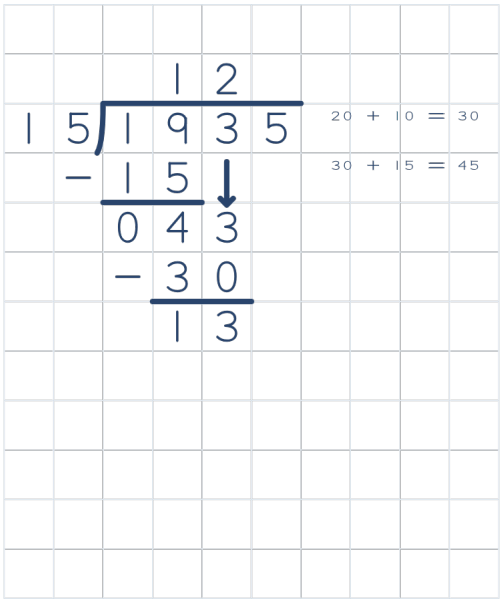

Finally, we subtract the hundreds, which is 4 hundreds – 3 hundreds. 4 hundreds – 3 hundreds = 1 hundred, so we write 1 in the hundreds column. No exchange is needed this time.

Step 19

1,935 ÷ 15 = ☐

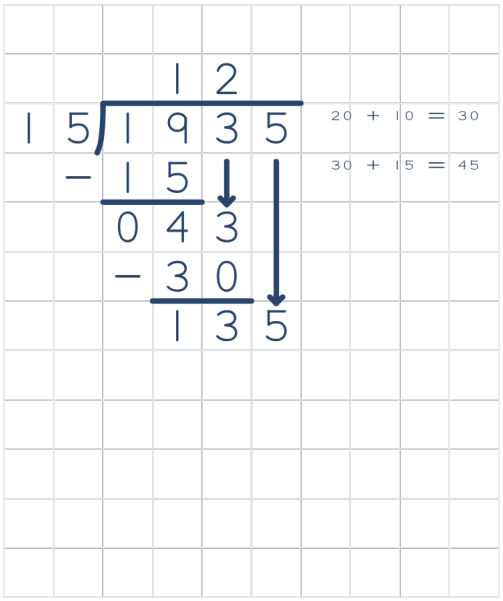

Remember: Bring down one digit at a time. Keep it in its original column.

Draw an arrow straight down from the 5 in the ones column. Copy 5 directly below, next to 13. The 13 tens left over become 130 ones. With the next 5 ones, we have 135 ones for the next step.

Step 20

1,935 ÷ 15 = ☐

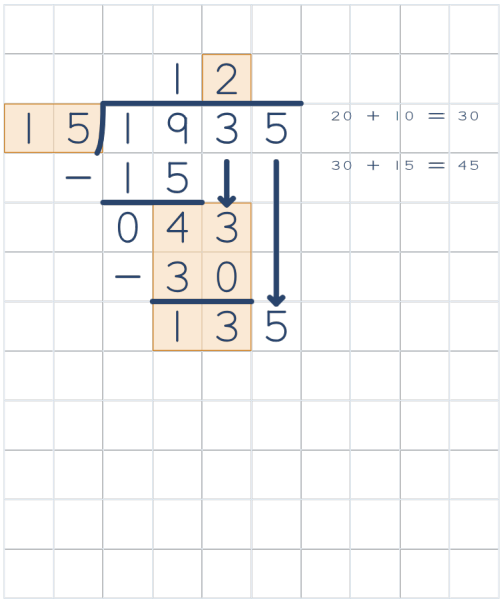

Check the subtraction for 43. 2 × 15 = 30. 43 – 30 = 13. 13 is smaller than 15. Use 13, the amount left over, for this check. The 5 we brought down is for the next division.

Step 21

1,935 ÷ 15 = ☐

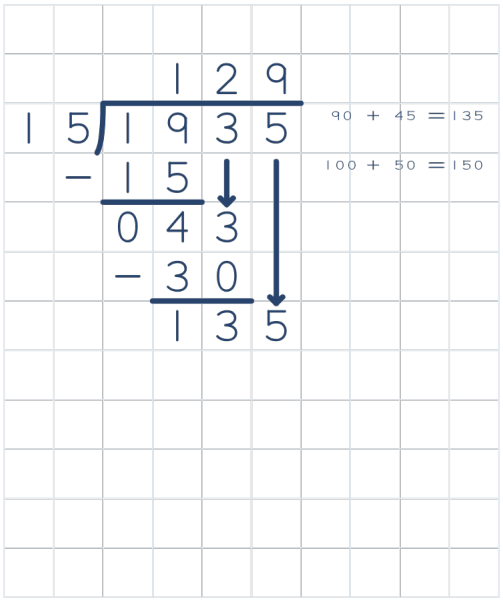

9 groups make 135, which fits into 135. 10 groups make 150, which is too large. We write 9 in the ones column above the line.

Step 22

1,935 ÷ 15 = ☐

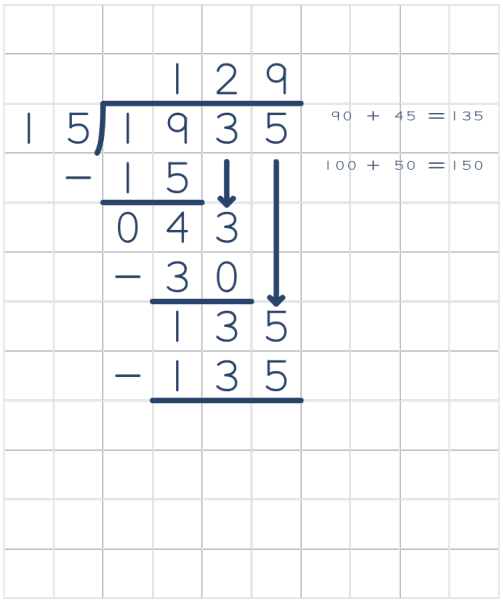

We write 135 below 135, line up the digits and write the subtraction sign. Then we draw a line underneath.

Step 23

1,935 ÷ 15 = ☐

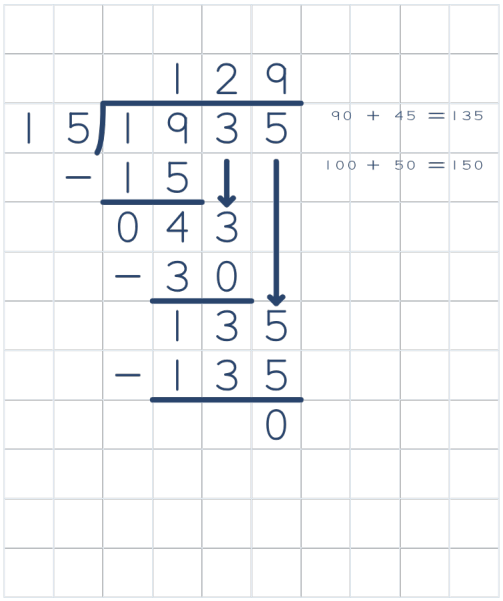

First, we subtract the ones, the smallest place-value column, which is 5 ones – 5 ones. 5 ones – 5 ones = 0 ones, so we write 0 in the ones column. No exchange is needed this time.

Step 24

1,935 ÷ 15 = ☐

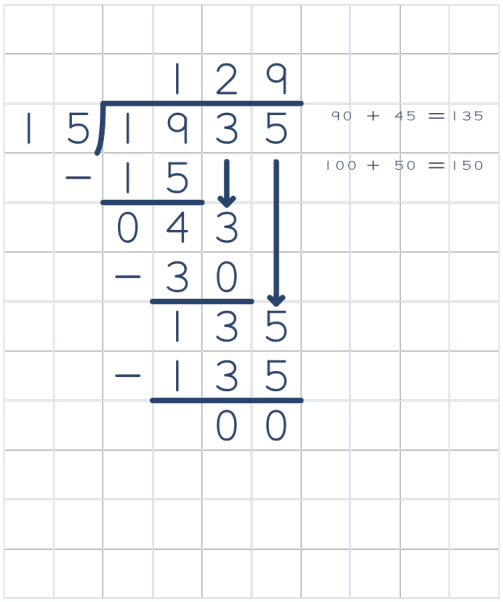

Next, we subtract the tens, which is 3 tens – 3 tens. 3 tens – 3 tens = 0 tens, so we write 0 in the tens column. No exchange is needed this time.

Step 25

1,935 ÷ 15 = ☐

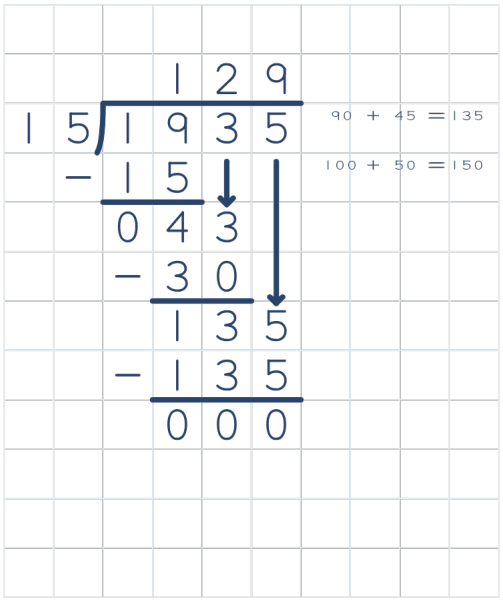

Finally, we subtract the hundreds, which is 1 hundred – 1 hundred. 1 hundred – 1 hundred = 0 hundreds, so we write 0 in the hundreds column. No exchange is needed this time.

Step 26

1,935 ÷ 15 = ☐

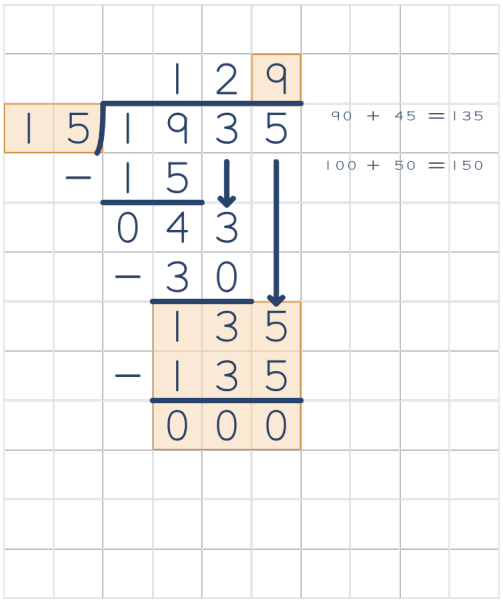

Check the subtraction for 135. 9 × 15 = 135. 135 – 135 = 0. 0 is smaller than 15.

Step 27

1,935 ÷ 15 = ☐

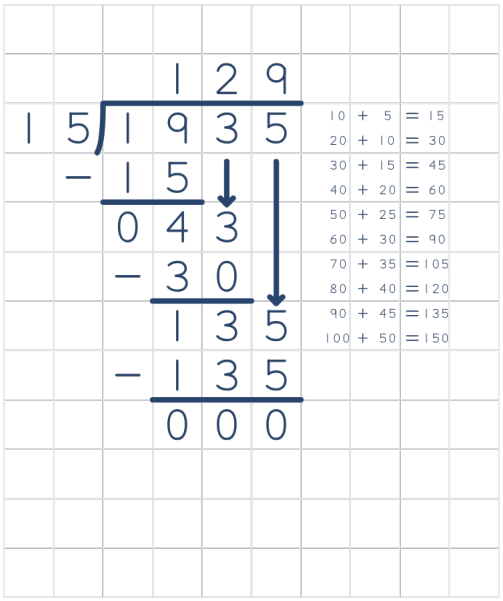

Nothing is left over after the last subtraction, so the division is exact.

Step 28

1,935 ÷ 15 = **129**

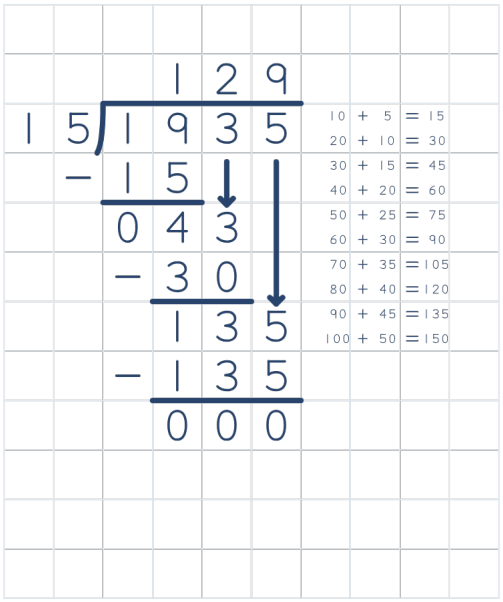

The quotient is 129. Copy 129 into the answer box. Make sure you copy the answer correctly.

Year 6 - Multiplying Decimals by a Whole Number — Lesson Guide

Step 1

0.7 × 3 = ☐



First, we circle the multiplication sign so we know to multiply the two factors and find their product.

Step 2

0.7 × 3 = ☐



We can use the same column method for a decimal multiplied by a whole number. The decimal point keeps its place between the ones and tenths.

Step 3

0.7 × 3 = ☐

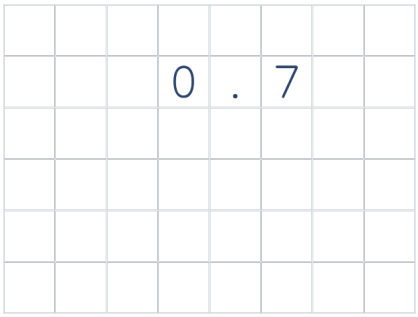

The first digit of 0.7 is in the ones column, so we start there. Now, we write 0.7 in the correct columns, with one digit in each box.

Step 4

0.7 × 3 = ☐

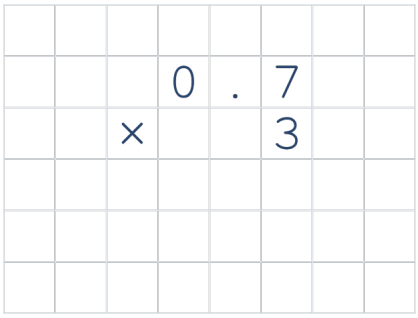

Remember: The multiplier is the whole number 3, even when it is written under a decimal digit.

Write the multiplication sign on the left. Write 3 under 7, the final digit in 0.7. The 3 means 3 lots of 0.7, so multiply each place by the whole number 3.

Step 5

0.7 × 3 = ☐

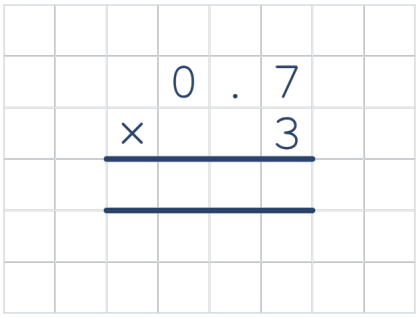

Draw a line under 3. Leave one row for the product, then draw the second line below that row. Write exchanges below the second line.

Step 6

0.7 × 3 = ☐

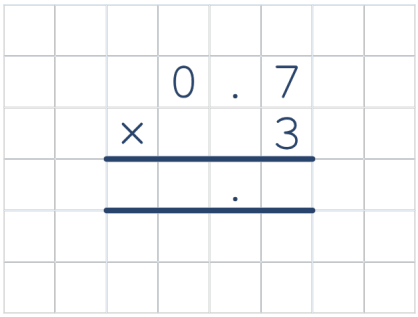

Before we start multiplying, we put the decimal point in the answer row, directly below the decimal point in the first factor.

Step 7

0.7 × 3 = ☐

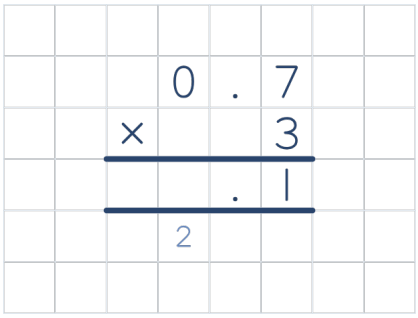

First, we multiply the tenths, the smallest place-value column. 7 tenths × 3 = 21 tenths. As we can only write one digit per box, we partition 21 tenths into 2 ones and 1 tenth. We write the 2 ones underneath the answer in the ones column, ready for the next step. We write 1 in the tenths answer box.

Step 8

0.7 × 3 = ☐

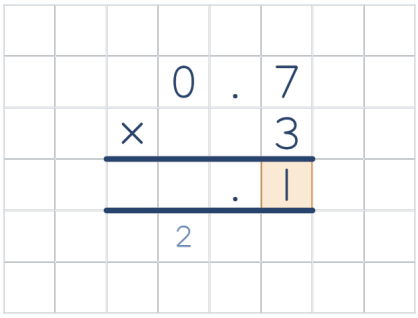

Remember: Check both places. Keep the small 2 below the ones column and the 1 in the tenths answer square.

The small 2 below the ones column stands for 2 ones. The 1 in the tenths answer square stands for 1 tenth. Together, they make 21 tenths.

Step 9

0.7 × 3 = ☐

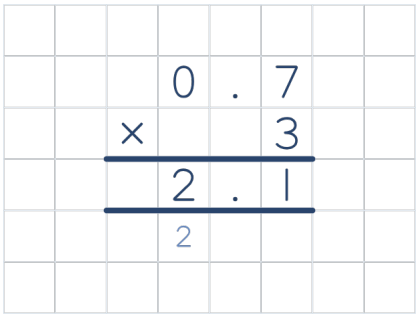

Remember: Look below the column you are working on. Add the exchanged amount written there.

Finally, we multiply the ones. 0 ones × 3 = 0 ones. Add the 2 ones shown by the small 2 below the ones column. That gives 2 ones. No exchange is needed this time. We write 2 in the ones answer box.

Step 10

0.7 × 3 = ☐

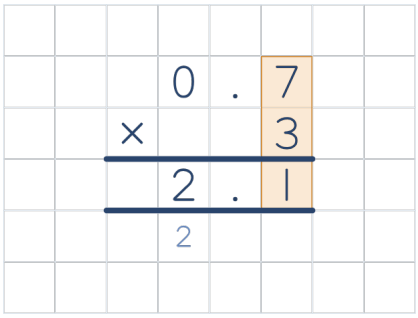

Check the tenths column. 7 tenths × 3 = 21 tenths. Check that the answer digit and any exchange are in the correct columns.

Step 11

0.7 × 3 = ☐

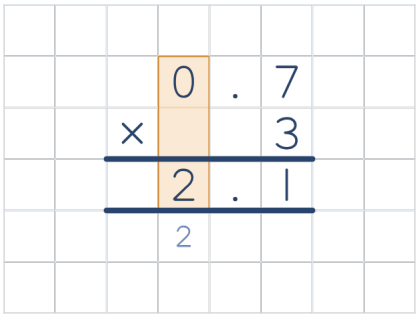

Check the ones column. 0 ones × 3 = 0 ones. Add the 2 ones shown by the small 2 below the ones column. That gives 2 ones. Check that the ones answer square shows the correct digit.

Step 12

0.7 × 3 = **2.1**

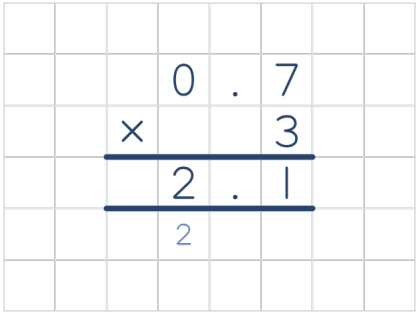

The product is 2.1. Copy 2.1 into the answer box. Make sure you copy the answer correctly.

Year 6 - Square Numbers — Lesson Guide

Step 1

$5^2 =$ ☐



First, we circle the small 2 to show that 5 is squared.

Step 2

$5^2 =$ ☐

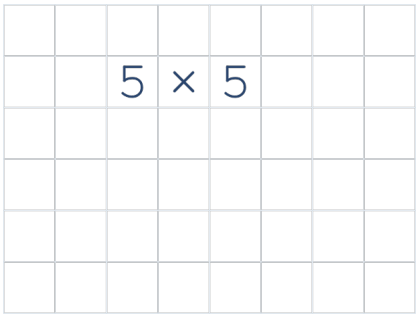

Remember: The index tells us how many copies of the base to use as factors.

Read 5^2 as 5 squared. The index is 2, so use two copies of 5 as factors. Write 5 × 5 on the next line.

Step 3

5^2 = ☐

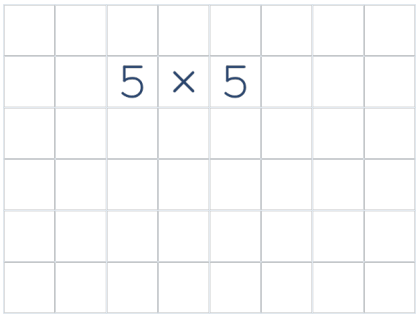

Now, we multiply 5 by 5. 5 × 5 = 25. Our square number is 25.

Step 4

5^2 = **25**

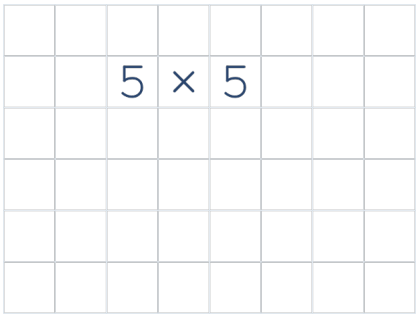

The product is 25. Copy 25 into the answer box. Make sure you copy the answer correctly.

Year 6 - Cube Numbers — Lesson Guide

Step 1

$4^3 =$ ☐



First, we circle the small 3 to show that 4 is cubed.

Step 2

$4^3 =$ ☐

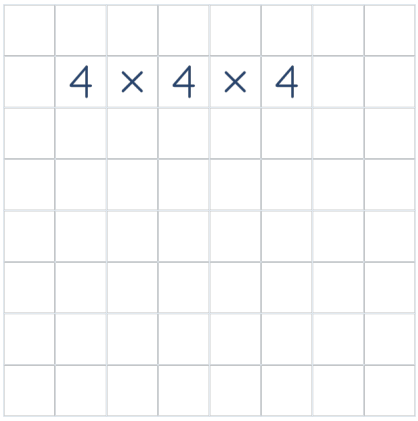

Remember: Multiply three copies of the number together.

The small 3 tells us to multiply 3 copies of 4 together. We write 4 × 4 × 4 below the question.

Step 3

$4^3 =$ ☐

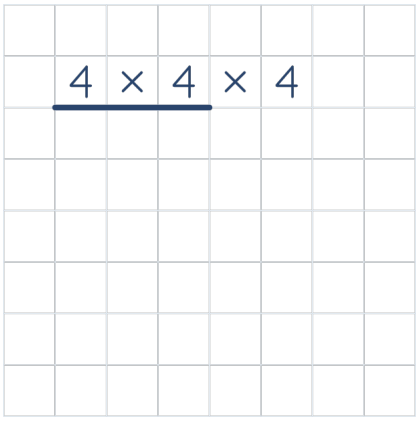

Underline the first two 4s. Multiply this pair first. Use the third 4 to multiply the result.

Step 4

$4^3 =$ ☐

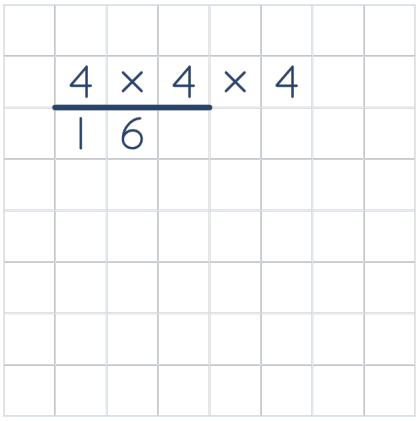

First, we multiply 4 by 4. 4 × 4 = 16. We write 16 underneath the first two factors.

Step 5

$4^3 =$ ☐

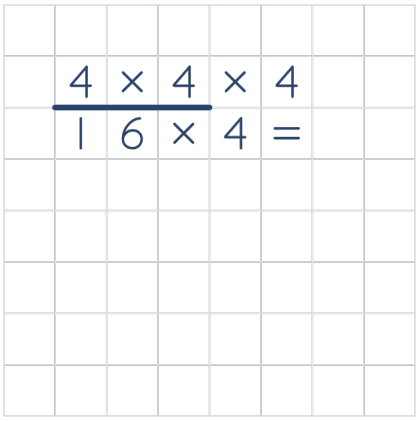

Next, we bring down the last factor, 4. We still need to multiply 16 by 4.

Step 6

$4^3 =$ ☐

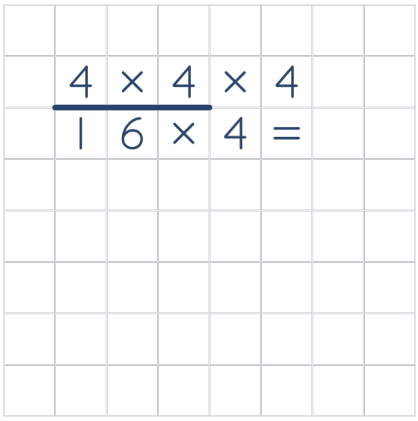

We can work out 16 × 4 mentally if we know the fact. If a written method would help, we can use column multiplication. Let’s follow that method now.

Step 7

$4^3 =$ ☐

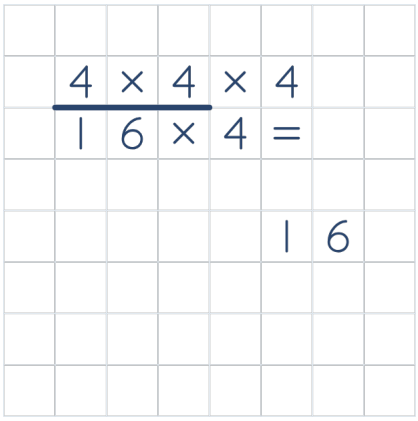

The first digit of 16, 1, is in the tens column, so we start there. Now, we write 16 in the correct columns, with one digit in each box.

Step 8

$4^3 =$ ☐

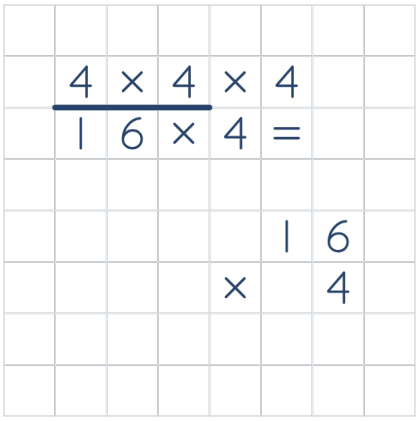

Remember: There must always be a digit in the ones column, even if it is a 0.

Then, we write the multiplication sign on the left and 4 in the ones column. We are multiplying by 4 ones.

Step 9

$4^3 =$ ☐

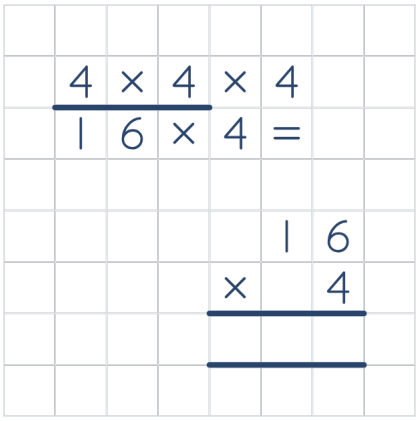

Draw a line under 4. Leave one row for the product, then draw the second line below that row. Write exchanges below the second line.

Step 10

4^3 = ☐

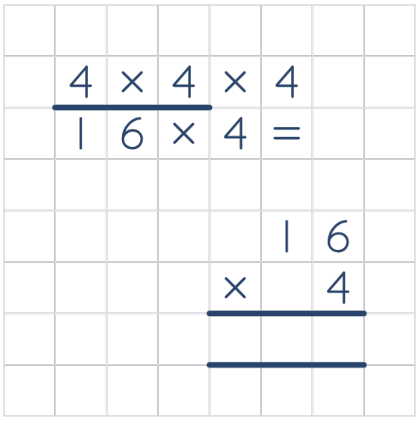

First, we multiply the ones, the smallest place-value column. 6 ones × 4 = 24 ones. As we can only write one digit per box, we partition 24 ones into 2 tens and 4 ones.

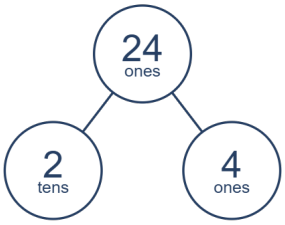

Step 11

4^3 = ☐

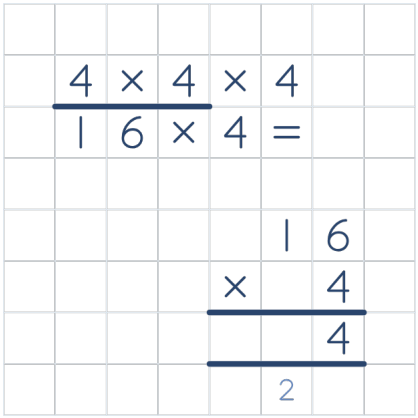

We write the 2 tens in the tens column underneath the answer, ready for the next step. Then we write the remaining 4 ones in the ones answer box.

Step 12

4^3 = ☐

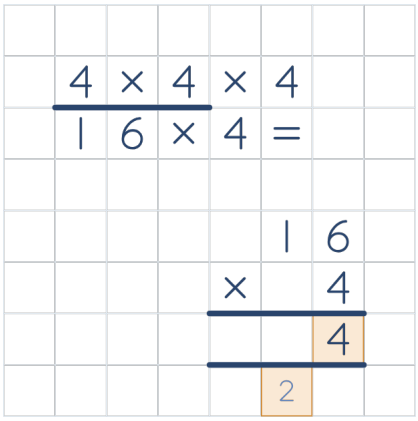

Remember: Check both places. Keep the small 2 below the tens column and the 4 in the ones answer square.

The small 2 below the tens column stands for 2 tens. The 4 in the ones answer square stands for 4 ones. Together, they make 24 ones.

Step 13

4^3 = ☐

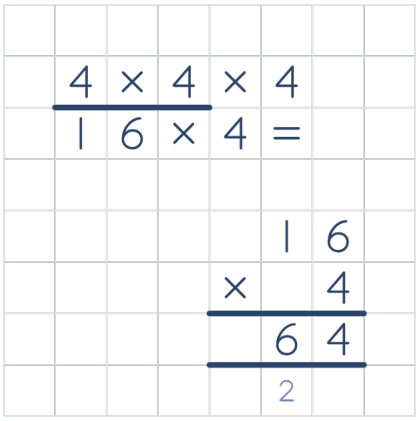

Remember: Look below the column you are working on. Add the exchanged amount written there.

Finally, we multiply the tens. 1 ten × 4 = 4 tens. Add the 2 exchanged tens shown by the small 2 below the tens column. 4 tens + 2 exchanged tens = 6 tens. We write 6 in the tens column. No exchange is needed this time.

Step 14

4^3 = ☐

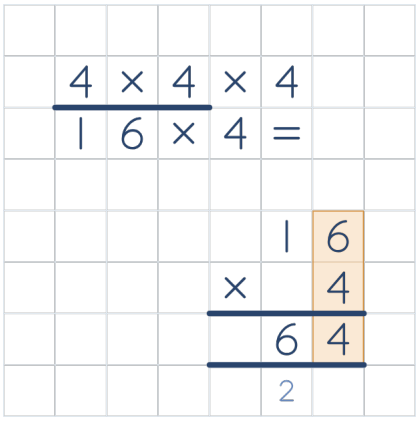

Our product is 64. Before we copy our answer into the answer box, let's check each column, including the exchanges. First, we check the ones: 6 ones × 4 = 24 ones. We have correctly written 2 tens underneath and 4 ones in the answer row.

Step 15

4^3 = ☐

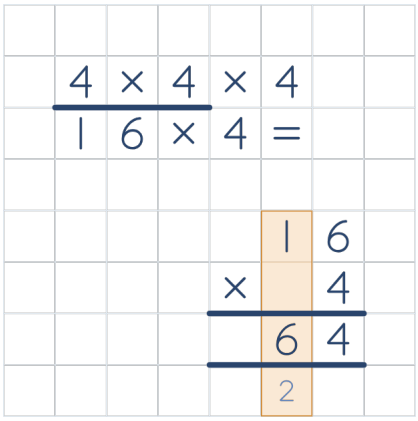

Remember: Look below the column you are working on. Add the exchanged amount written there.

Finally, we check the tens: 1 ten × 4 = 4 tens. Add the 2 exchanged tens shown by the small 2 below the tens column. 4 tens + 2 exchanged tens = 6 tens. We have correctly written 6 in the answer row, using the correct place-value columns.

Step 16

4^3 = ☐

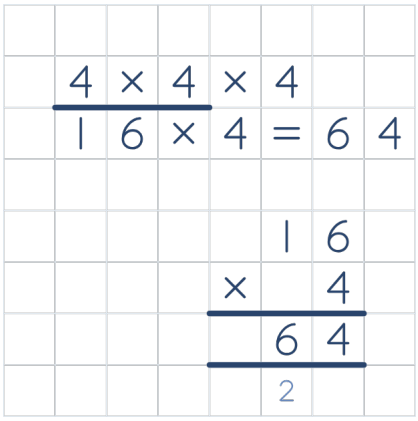

Now, we complete the calculation. 16 × 4 = 64.

Step 17

4^3 = **64**

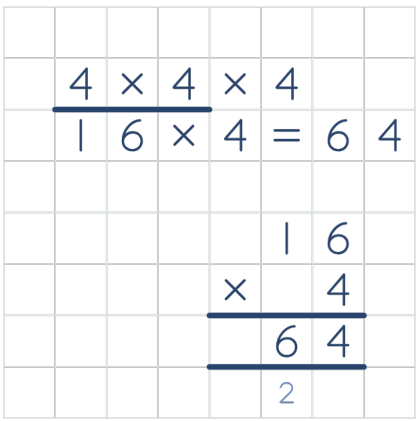

The product is 64. Copy 64 into the answer box. Make sure you copy the answer correctly.

Year 6 - Finding a Missing Place-Value Part — Lesson Guide

Step 1

4,030,206 = 4,000,000 + ☐ + 200 + 6

	4	0	3	0	2	0	6

The first digit of 4,030,206, 4, is in the millions column, so we start there. Now, we write 4,030,206 in the correct columns, with one digit in each box.

Step 2

4,030,206 = 4,000,000 + ☐ + 200 + 6

	4	0	3	0	2	0	6
			3	0	0	0	0

Remember: Give the value of the digit in its place. The digit is 3 and its value is 30,000.

The 3 in 4,030,206 is in the ten thousands place. 3 ten thousands are worth 30,000. That is the missing part. Write 30,000 on the grid.

Step 3

4,030,206 = 4,000,000 + 30,000 + 200 + 6

	4	0	3	0	2	0	6
			3	0	0	0	0

The missing part is 30000. Copy 30000 into the answer box. Make sure you copy the answer correctly.

Year 6 - Finding Missing Numbers (+ and –) — Lesson Guide

Step 1

□ – 415 = 312



First, we circle the minus sign. We look at the operation in the question before choosing how to find the missing number.

Step 2

□ – 415 = 312



Remember: The box asks for a missing number. Put it back in the same place to check.

Read the calculation with the blank. Something take away 415 leaves 312. We are finding the whole we started with, called the minuend. Draw the whole bar above the two parts.

Step 3

□ – 415 = 312

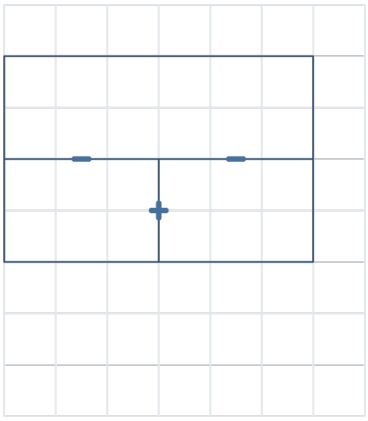

Next, we draw bold minus signs between the whole and its parts, and a bold plus sign between the two parts. This shows us that the two parts add to make the whole and, to find a part, we subtract the other part from the whole.

Step 4

□ – 415 = 312

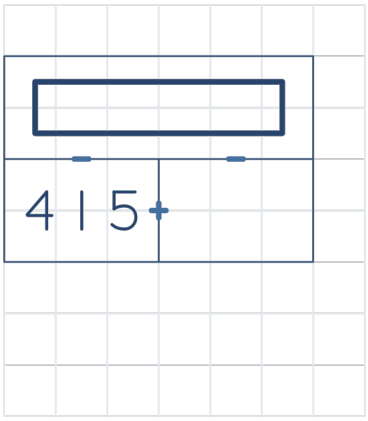

Draw an empty box in the whole bar for the missing number. Write 415 in the left part.

Step 5

□ – 415 = 312

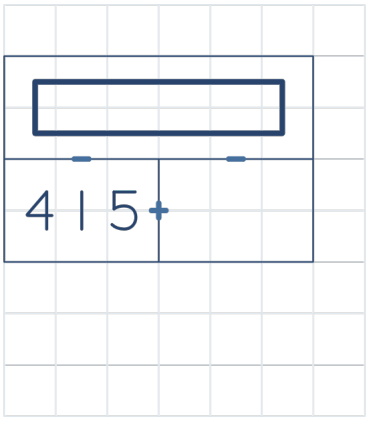

Check the two entries before filling the last space. Read the question up to the equals sign as something take away 415. In the bar model, the blank in the whole bar and 415 in the left part should read as something take away 415. If the entries match, fill the last space. If they differ, correct the model first.

Step 6

□ – 415 = 312

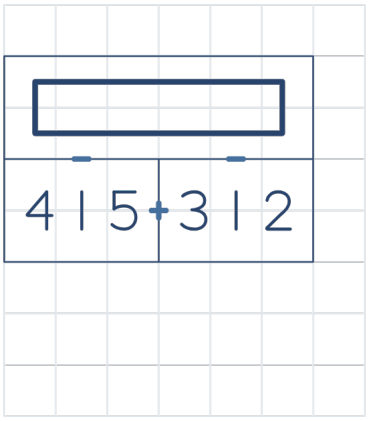

Write 312 in the right part.

Step 7

□ – 415 = 312

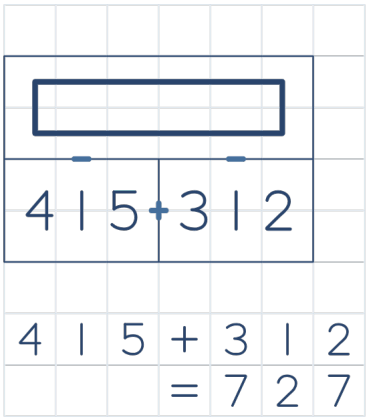

We add the two parts to find the whole. I can partition 312 into 300 and 10 and 2. I am going to add these parts mentally, starting with the greatest place value. 415 + 312 = 727.

Step 8

727 – 415 = 312

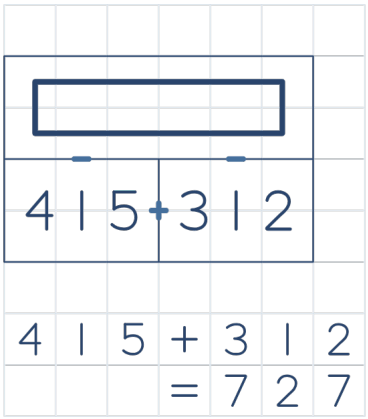

Now, we put 727 into the blank in the original question. Make sure you copy the answer correctly.

Step 9

727 – 415 = 312

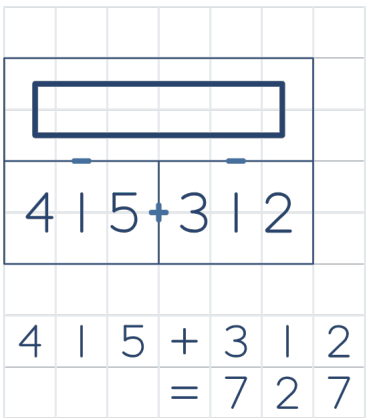

Put 727 in the blank and use the operation in the question. Work out 727 – 415. That gives 312. The result matches 312 on the right. If you get a different number, check that you used the operation in the question. Then work it out again.

Year 6 - Finding Missing Numbers (× and ÷) — Lesson Guide

Step 1

$\square \div 5 = 12$

First, we circle the division sign. We look at the operation in the question before choosing how to find the missing number.

Step 2

$\square \div 5 = 12$

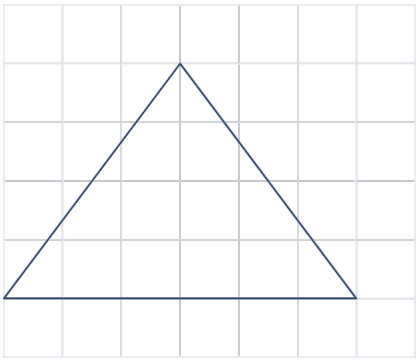

Remember: The product goes at the top. The factors go at the bottom.

We are finding the amount we started with. Sharing that amount into 5 equal groups gives 12 in each group. Draw the product-factor triangle. The missing whole goes at the top. The two known factors go at the bottom.

Step 3

$\square \div 5 = 12$

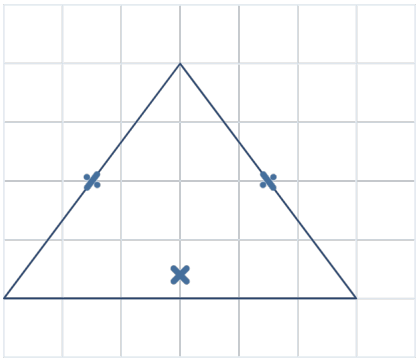

Next, we draw bold division signs over the two sloping sides and a bold multiplication sign just above the base. The factors multiply to make the product. To find a factor, we divide the product by the other factor.

Step 4

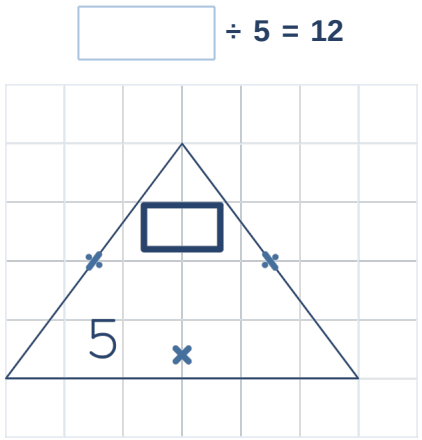

Next, we use our product-factor triangle to show something divided by 5. Our first two entries are on either side of the division sign. The first is the dividend, the product in the related multiplication. The second is the divisor, one of the factors. We draw a small rectangle at the top, in the product position for the missing dividend. We write 5 in the bottom-left corner.

Step 5

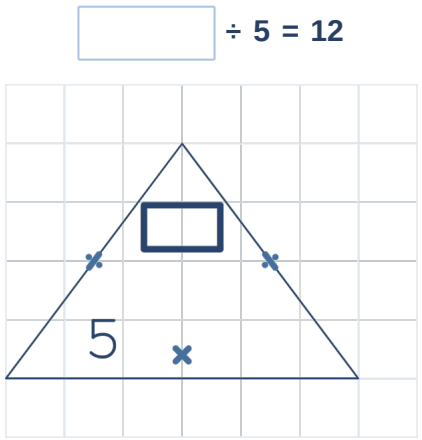

Before moving on, let's make sure our first two entries are in the right places. First, we read the calculation: something divided by 5. Then, we read the matching calculation in our product-factor triangle: something divided by 5. If they match, well done. If they do not, edit the model and check it again.

Step 6

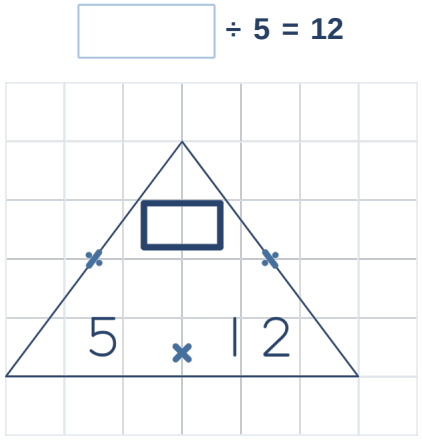

Now the calculation is in the correct place, we can look at our quotient, 12. We write 12 in the bottom-right corner.

Step 7

□ ÷ 5 = 12

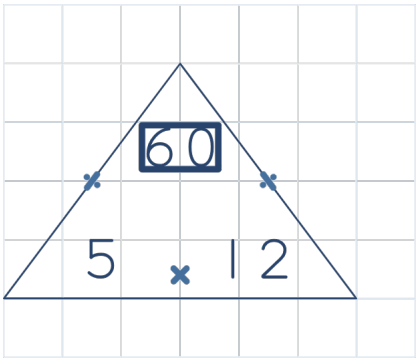

The top of the triangle is blank, so we multiply the two factors at the bottom. 5 × 12 = 60. The missing product is 60.

Step 8

60 ÷ 5 = 12

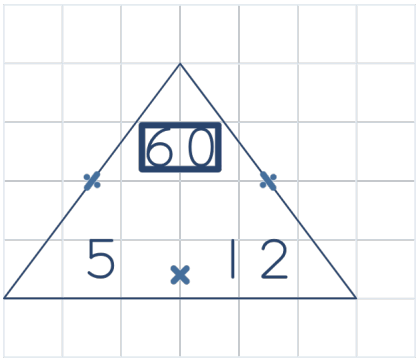

Now, we put 60 into the blank in the original question. Make sure you copy the answer correctly.

Step 9

60 ÷ 5 = 12

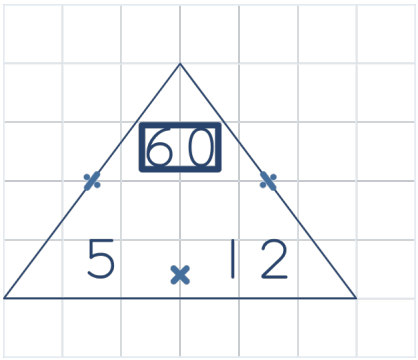

Put 60 back in the blank. Use the product-factor triangle to check the calculation. Multiply the factors. 5 × 12 = 60. So 60 shared into 5 equal groups gives 12 in each group. If you get a different number, check that you used the operation in the question. Then work it out again.

Year 6 - Dividing by 10, 100 and 1,000 — Lesson Guide

Step 1

11.1 ÷ 100 = ☐



First, we circle the division sign so we know which operation is in the question.

Step 2

11.1 ÷ 100 = ☐



Remember: The decimal point stays between the ones and tenths.

Next, we underline the 100 so we do not accidentally divide by the wrong amount. We can use place value instead of a column method. Each digit becomes worth one hundredth as much. The decimal point stays between the ones and tenths columns.

Step 3

11.1 ÷ 100 = ☐

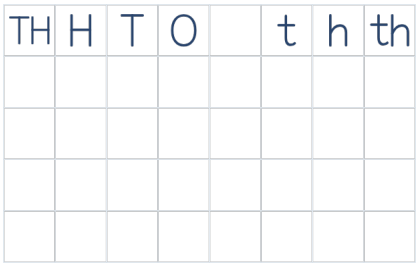

Next, we write the place-value headings, with one heading in each box. The ones are immediately to the left of the decimal point. Tenths come first on the right. Next are hundredths, with 100 to a whole. Then come thousandths, with 1,000 to a whole.

Step 4

11.1 ÷ 100 = ☐

TH	H	T	O		t	h	th
		1	1	.	1		

Now, we write 11.1 in the correct columns, with one digit in each box. We keep its original place values.

Step 5

11.1 ÷ 100 = ☐

TH	H	T	O		t	h	th
		1	1	.	1		
			0	.			

The hundreds column in 11.1 is empty. After dividing, that empty place gives us 0 ones. Write 0 in the ones place, then put a decimal point straight after the ones digit in our answer box. Each digit is worth one hundredth as much.

Step 6

11.1 ÷ 100 = ☐

TH	H	T	O		t	h	th
		1	1	.	1		
			0	.	1		

The 1 in the tens column stands for 1 ten. Dividing by 100 makes it 1 tenth. Write 1 in the tenths place, straight after the decimal point. Each digit is worth one hundredth as much.

Step 7

11.1 ÷ 100 = ☐

TH	H	T	O		t	h	th
		1	1	.	1		
			0	.	1	1	

The 1 in the ones column stands for 1 one. Dividing by 100 makes it 1 hundredth. Write 1 in the hundredths place. Each digit is worth one hundredth as much.

Step 8

11.1 ÷ 100 = ☐

TH	H	T	O		t	h	th
		1	1	.	1		
			0	.	1	1	1

The 1 in the tenths column stands for 1 tenth. Dividing by 100 makes it 1 thousandth. Write 1 in the thousandths place. Each digit is worth one hundredth as much.

Step 9

11.1 ÷ 100 = **0.111**

TH	H	T	O		t	h	th
		1	1	.	1		
			0	.	1	1	1

Read the answer as 0.111. The 1 is in the tenths place, the 1 is in the hundredths place and the 1 is in the thousandths place. The 0 shows there are no whole ones. Copy 0.111 into our answer box. Make sure you copy the answer correctly.

Year 6 - Multiplying by 10, 100 and 1,000 — Lesson Guide

Step 1

1.13 × 100 = ☐



First, we circle the multiplication sign so we know which operation is in the question.

Step 2

1.13 × 100 = ☐



Remember: The decimal point stays between the ones and tenths.

Next, we underline the 100 so we do not accidentally multiply by the wrong amount. We can use place value instead of a column method. Each digit becomes worth 100 times as much. The decimal point stays between the ones and tenths columns.

Step 3

1.13 × 100 = ☐

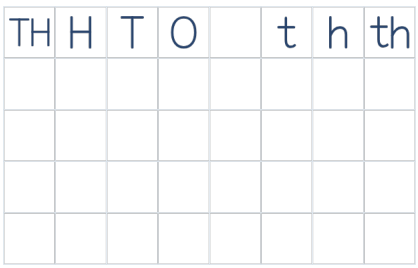

Next, we write the place-value headings, with one heading in each box. The ones are immediately to the left of the decimal point. Tenths come first on the right. Next are hundredths, with 100 to a whole. Then come thousandths, with 1,000 to a whole.

Step 4

1.13 × 100 = ☐

TH	H	T	O		t	h	th
			1	.	1	3	

Now, we write 1.13 in the correct columns, with one digit in each box. We keep its original place values.

Step 5

1.13 × 100 = ☐

TH	H	T	O		t	h	th
			1	.	1	3	
	1						

Remember: Move every digit the same number of places. The order of the digits stays the same.

The 1 in the ones column stands for 1 one. Multiplying by 100 makes it 1 hundred. Write 1 in the hundreds column.

Step 6

1.13 × 100 = ☐

TH	H	T	O		t	h	th
			1	.	1	3	
	1	1					

Remember: Move every digit the same number of places. The order of the digits stays the same.

The 1 in the tenths column stands for 1 tenth. Multiplying by 100 makes it 1 ten. Write 1 in the tens column. The 1 is already in the hundreds column.

Step 7

1.13 × 100 = ☐

TH	H	T	O		t	h	th
			1	.	1	3	
	1	1	3				

Remember: Move every digit the same number of places. The order of the digits stays the same.

The 3 in the hundredths column stands for 3 hundredths. Multiplying by 100 makes it 3 ones. Write 3 in the ones column. The 1 is already in the tens column.

Step 8

1.13 × 100 = 113

TH	H	T	O		t	h	th
			1	.	1	3	
	1	1	3				

Now, we check each digit is in the correct column. Our product is 113. We copy it into the answer box. Make sure you copy the answer correctly.

Year 6 - Finding Fractions of Amounts (Unit) — Lesson Guide

Step 1

Find $\frac{1}{3}$ of 81 = ☐

1/3 means we want 1 out of 3 equal parts. The denominator, 3, tells us how many equal parts make the whole. The numerator, 1, tells us how many of those parts we want. We want fewer than all 3 equal parts, so our answer must be less than 81.

Step 2

Find $\frac{1}{3}$ ✓ of 81 ✓ = ☐

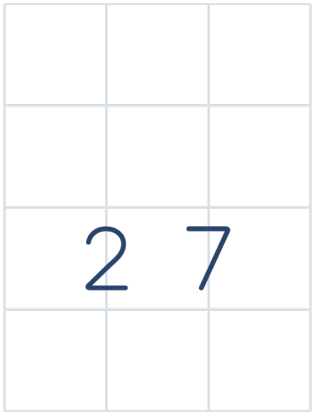

Remember: The denominator tells us how many equal parts to make. Use the numerator in the next step.

Divide the whole amount, 81, by the denominator, which is 3. Tick 81 and the denominator, 3, as you use them. 81 ÷ 3 = 27. One equal part contains 27. Keep that amount for the next step. You can work this out mentally or on the squares.

Step 3

Find $\frac{1}{3}$ ✓ of 81 ✓ = ☐

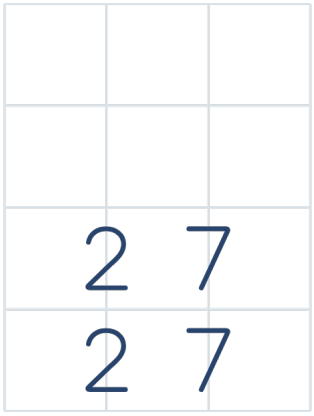

We found 27 in one equal part. Multiply 27 by the numerator, which is 1. 27 × 1 = 27. Tick the numerator, 1. The fraction amount is 27. You can work this out mentally or on the squares.

Step 4

Find $\frac{1}{3}$ of 81 =

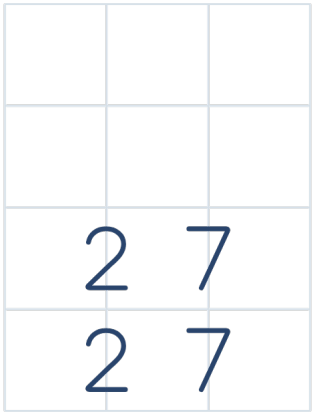

Now, we check all three ticks. We started with 81. We divided by 3. Then, we multiplied by 1.

Step 5

Find $\frac{1}{3}$ of 81 = **27**

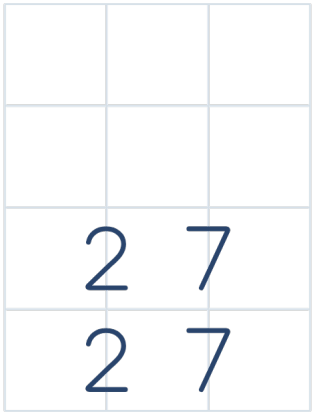

The fraction amount is 27. Copy 27 into the answer box. Make sure you copy the answer correctly.

Step 6

Find $\frac{1}{3}$ of 81 = **27**

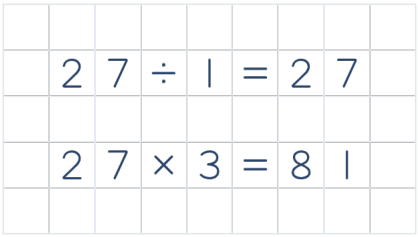

Divide 27 by the numerator, 1, to get one equal part. 27 ÷ 1 = 27. Multiply 27 by the denominator, 3, to put the equal parts back together. 27 × 3 = 81. We got back to the original whole amount, 81. That checks our answer of 27.

Year 6 - Finding Fractions of Amounts (Non-unit) — Lesson Guide

Step 1

Find $\frac{2}{3}$ of 81 = ☐

2/3 means we want 2 out of 3 equal parts. The denominator, 3, tells us how many equal parts make the whole. The numerator, 2, tells us how many of those parts we want. We want fewer than all 3 equal parts, so our answer must be less than 81.

Step 2

Find $\frac{2}{3}$ ✓ of 81 ✓ = ☐

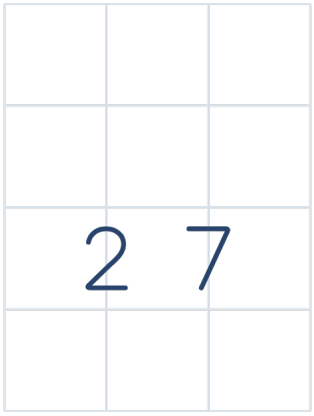

Remember: The denominator tells us how many equal parts to make. Use the numerator in the next step.

Divide the whole amount, 81, by the denominator, which is 3. Tick 81 and the denominator, 3, as you use them. 81 ÷ 3 = 27. One equal part contains 27. Keep that amount for the next step. You can work this out mentally or on the squares.

Step 3

Find $\frac{2}{3}$ ✓ of 81 ✓ = ☐

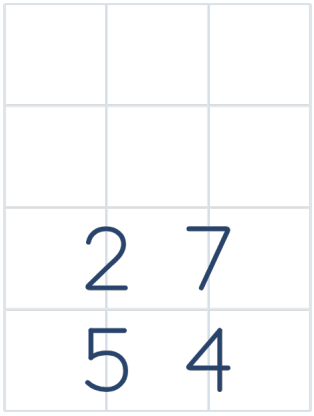

Remember: Always multiply by the numerator, even when it is 1. Keep the same habit for every fraction of an amount.

We found 27 in one equal part. Multiply 27 by the numerator, which is 2. 27 × 2 = 54. Tick the numerator, 2. The fraction amount is 54. You can work this out mentally or on the squares.

Step 4

Find $\frac{2}{3}$ of 81 =

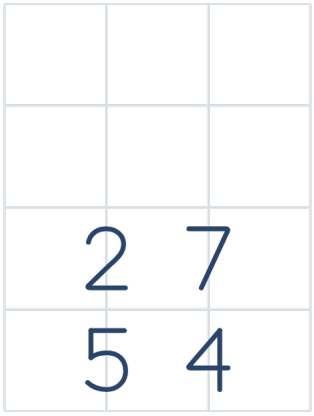

Now, we check all three ticks. We started with 81. We divided by 3. Then, we multiplied by 2.

Step 5

Find $\frac{2}{3}$ of 81 = **54**

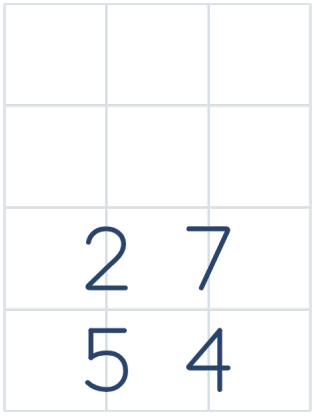

The fraction amount is 54. Copy 54 into the answer box. Make sure you copy the answer correctly.

Step 6

Find $\frac{2}{3}$ of 81 = **54**

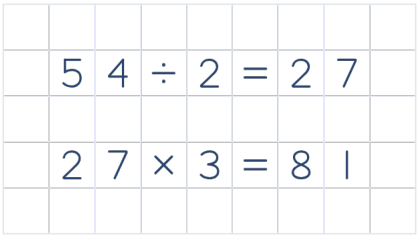

Divide 54 by the numerator, 2, to get one equal part. 54 ÷ 2 = 27. Multiply 27 by the denominator, 3, to put the equal parts back together. 27 × 3 = 81. We got back to the original whole amount, 81. That checks our answer of 54.

Year 6 - Adding 3 Numbers — Lesson Guide

Step 1

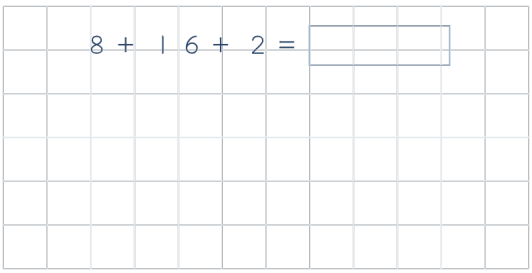

First, we circle both plus signs in the question. There are two additions, so we will calculate in two steps.

Step 2

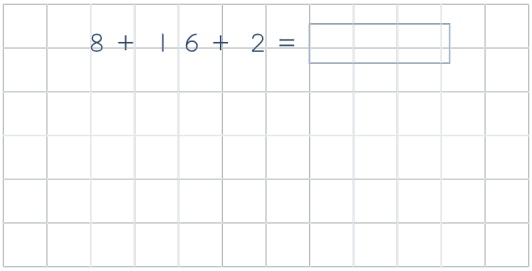

Remember: Look at all three numbers. Use each original number once.

Addition is commutative, which means we can add the numbers in any order and get the same sum. Let's look for a pair that is easy to work out first.

Step 3

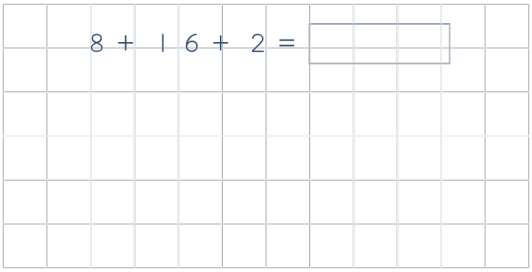

Remember: Use each original number once.

Use number bonds, doubles and other number facts to choose a helpful pair. A useful pair here is 8 and 2. 8 + 2 = 10. That gives us a multiple of 10, which is easy to add to. Draw a line from each chosen number to where we will write the first result. Keep 16 for the next step. Other pairs can still give the same sum.

Step 4

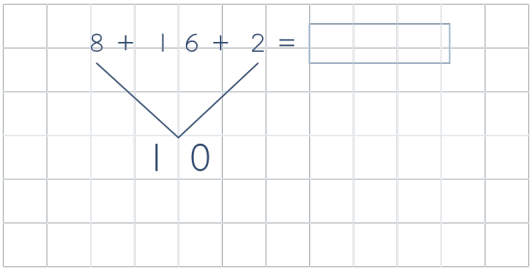

First, we add the chosen pair. 8 + 2 = 10. We write 10 on the squares, in the middle below the two chosen numbers. We still need the remaining addend, 16.

Step 5

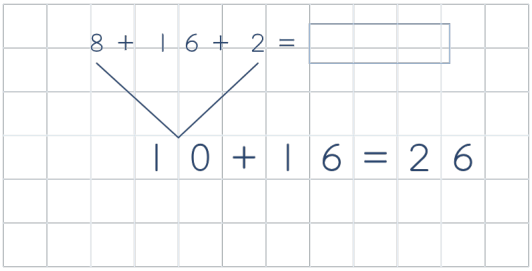

Next, we add the remaining addend to our first result. 10 + 16 = 26. There are no exchanges in this addition, so we can work it out mentally. We could use a column method if needed. We have now used all three original numbers once.

Step 6

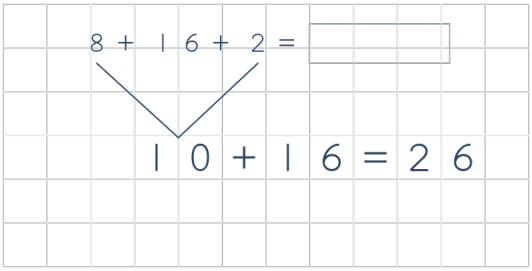

Now, we check that we have used all three original addends once. First, 8 + 2 = 10. Then, 10 + 16 = 26. All three original numbers have been used once.

Step 7

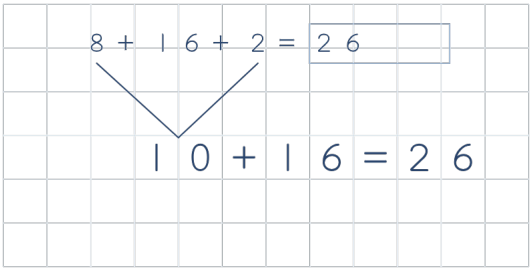

The sum is 26. Copy 26 into the answer box. Make sure you copy the answer correctly.

Year 6 - Multiplying 3 Numbers — Lesson Guide

Step 1

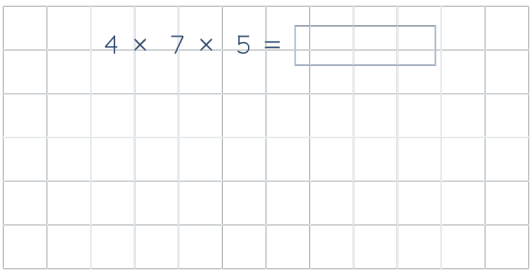

First, we circle both multiplication signs in the question. There are two multiplications, so we will calculate in two steps.

Step 2

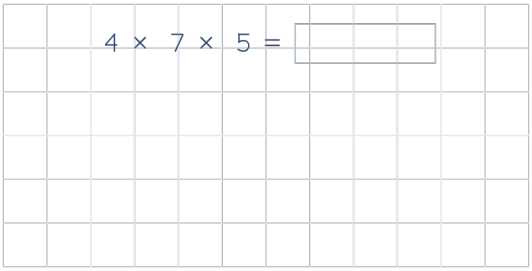

Remember: Look at all three numbers. Use each original number once.

Multiplication is commutative, which means we can multiply the numbers in any order and get the same product. Let’s look for a pair that is easy to work out first.

Step 3

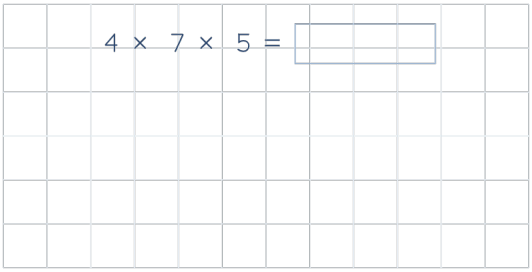

Remember: Use each original number once.

Use multiplication facts to choose a helpful pair. A useful pair here is 4 and 5. 4 × 5 = 20. 20 is 2 tens. We can use 2 × 7 to find the number of tens in the product. Draw a line from each chosen number to where we will write the first result. Keep 7 for the next step. Other pairs can still give the same product.

Step 4

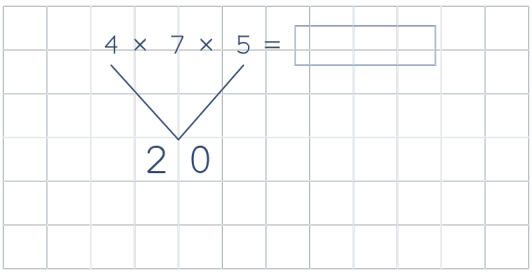

First, we multiply the chosen pair. 4 × 5 = 20. We write 20 on the squares, in the middle below the two chosen numbers. We still need the remaining factor, 7.

Step 5

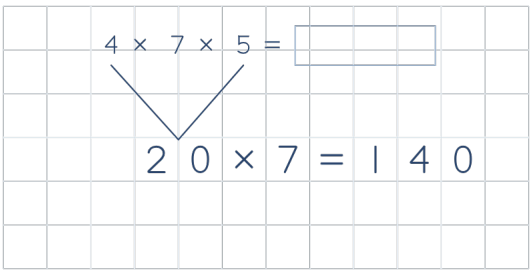

Next, we multiply our first result by the remaining factor. 20 is 2 tens. We know 2 × 7 = 14, so the product is 14 tens. 20 × 7 = 140. We can use our number facts mentally or choose a suitable written method if needed. We have now used all three original numbers once.

Step 6

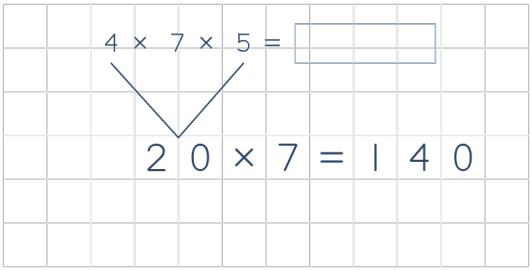

Now, we check that we have used all three original factors once. First, 4 × 5 = 20. Then, 20 × 7 = 140. All three original numbers have been used once.

Step 7

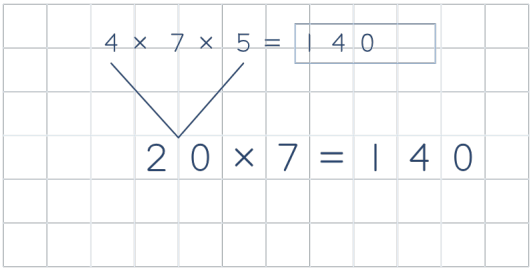

The product is 140. Copy 140 into the answer box. Make sure you copy the answer correctly.

Year 6 - Adding Fractions with the Same Denominator — Lesson Guide

Step 1

$\frac{2}{5} + \frac{4}{5} =$ ☐

First, we circle the plus sign so we know to add the fractions and find their sum.

Step 2

$\frac{2}{5} + \frac{4}{5} =$ $\frac{\quad}{5}$

Remember: The denominator stays the same because the size of each part stays the same.

Next, we check both denominators. Both are 5, so the parts are the same size. We tick both denominators to show they match. Then, we draw the fraction line and write 5 underneath it in the answer box.

Step 3

$\frac{2}{5} + \frac{4}{5} =$ $\frac{6}{5}$

Remember: The denominator tells us the size of each part. Keep it the same when you add or subtract these parts.

Both fractions use fifths of the same whole. Add 4 fifths to 2 fifths to make 6 fifths. Write 6 above the fraction line.

Step 4

$\frac{2}{5} + \frac{4}{5} = \frac{6}{5}$

Now, we check all three denominators. The first denominator is 5. The second denominator is 5. Our answer denominator is 5. All three are the same. We also check that 2 + 4 = 6, our numerator.

Step 5

$\frac{2}{5} + \frac{4}{5} = 1\frac{1}{5}$

Read 6/5 as 6 fifths. 5 fifths make one whole. 1 fifth is left. Write 1 1/5 in the answer box.

Year 6 - Adding Fractions with Different Denominators — Lesson Guide

Step 1

$\frac{4}{6} + \frac{2}{8} =$ ☐



First, we circle the plus sign so we know to add the fractions and find their sum.

Step 2

$\frac{4}{6} + \frac{2}{8} =$ ☐

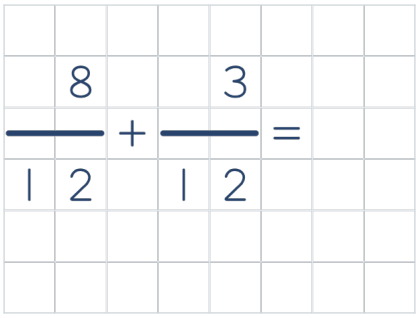

Remember: Change the numerator and denominator by the same factor to keep the value of the fraction.

First, we check whether either fraction can be simplified. Two thirds is equivalent to four sixths. Divide the numerator and denominator by 2 to make that change. One quarter is equivalent to two eighths. Divide the numerator and denominator by 2 to make that change. Start with the multiples of 4. 12 is the first one that is also a multiple of 3, so 12 is the smallest common denominator. Multiply the numerator and denominator of 2/3 by 4 to get 8/12. Multiply the numerator and denominator of 1/4 by 3 to get 3/12. We write 8/12 + 3/12 on the grid.

Step 3

$\frac{4}{6} + \frac{2}{8} =$ ☐

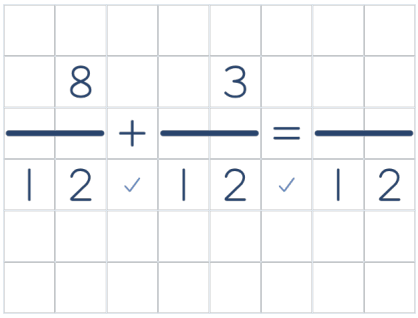

Both denominators are 12, so the parts are the same size. We tick both denominators to show they match. Then, we draw the fraction line and write 12 underneath it.

Step 4

$\frac{4}{6} + \frac{2}{8} =$ ☐

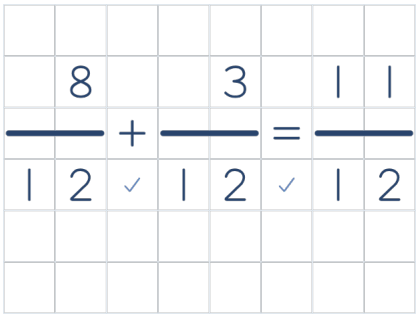

Then, we add the numerators. 8 + 3 = 11. The denominator stays 12 because the parts are the same size. We write 11 above the fraction line.

Step 5

$\frac{4}{6} + \frac{2}{8} =$ ☐

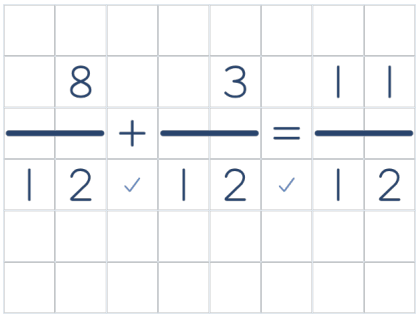

The parts are the same size. Add 8 twelfths and 3 twelfths to make 11 twelfths. Keep 12 as the denominator.

Step 6

$\frac{4}{6} + \frac{2}{8} = \frac{11}{12}$

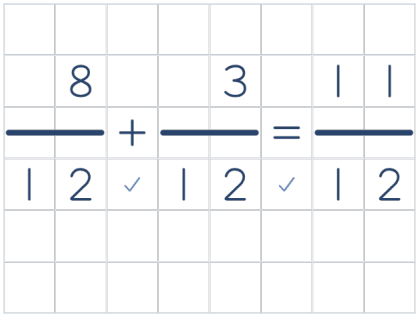

The sum is 11/12. Copy 11/12 into the answer box. Make sure you copy the answer correctly.

Step 7

$\frac{1}{6} + \frac{1}{3} = \frac{1}{2}$



The sum is 3/6. Divide its numerator and denominator by 3. 3/6 is equivalent to 1/2.

Year 6 - Adding Fractions with Wholes — Lesson Guide

Step 1

$2\frac{2}{4} + 1\frac{2}{8} =$ ☐



First, we circle the plus sign so we know to add and find the sum.

Step 2

$2\frac{2}{4} + 1\frac{2}{8} =$ ☐

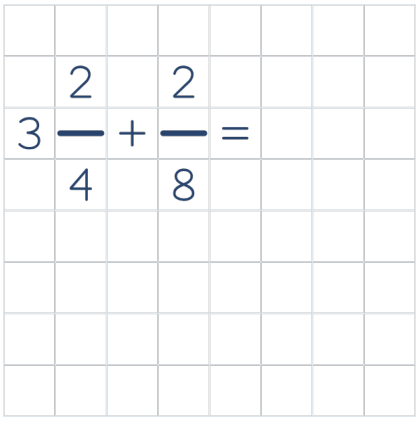

First, we add the whole-number parts, keeping the fractional parts separate for now. 2 + 1 = 3. We write 3 in the whole-number square and keep both fractions the same.

Step 3

$2\frac{2}{4} + 1\frac{2}{8} =$ ☐



First, we check whether either fraction can be simplified. One quarter is equivalent to two eighths. Divide the numerator and denominator by 2 to make that change. Keep 2/4, which already uses denominator 4. Keep 3 wholes on the left. On the next line, write 3 2/4 + 1/4.

Step 4

$2\frac{2}{4} + 1\frac{2}{8} =$ ☐



Remember: The denominator stays the same because the size of each part stays the same.

Both denominators are 4, so the parts are the same size. We tick both denominators to show they match. Then, we draw the fraction line and write 4 underneath it.

Step 5

$2\frac{2}{4} + 1\frac{2}{8} =$ ☐



Then, we add the numerators. 2 + 1 = 3. The denominator stays 4 because the parts are still the same size. We write 3 above the fraction line and write 3 in the whole-number square.

Step 6

$2\frac{2}{4} + 1\frac{2}{8} =$ $3\frac{3}{4}$



Read the whole-number and fractional parts together. The sum is 3 3/4. Copy 3 3/4 into the answer box. Make sure you copy the answer correctly.

Year 6 - Adding Fractions with Wholes – Crossing the Whole — Lesson Guide

Step 1

$2\frac{2}{4} + 1\frac{6}{8} =$ ☐



First, we circle the plus sign so we know to add and find the sum.

Step 2

$2\frac{2}{4} + 1\frac{6}{8} =$ ☐

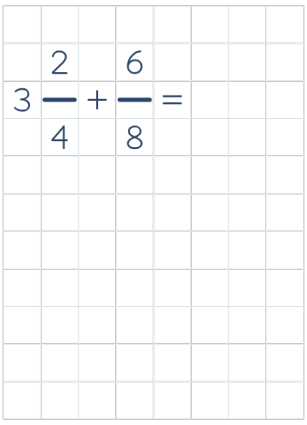

First, we add the whole-number parts, keeping the fractional parts separate for now. 2 + 1 = 3. We write 3 in the whole-number square and keep both fractions the same.

Step 3

$2\frac{2}{4} + 1\frac{6}{8} =$ ☐

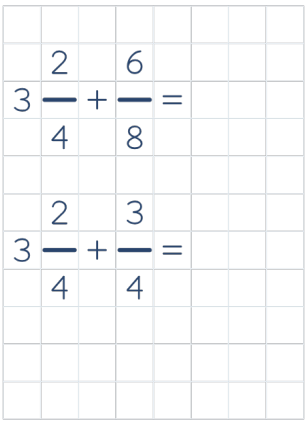

First, we check whether either fraction can be simplified. Three quarters is equivalent to six eighths. Divide the numerator and denominator by 2 to make that change. Keep 2/4, which already uses denominator 4. Keep 3 wholes on the left. On the next line, write 3 2/4 + 3/4.

Step 4

$2\frac{2}{4} + 1\frac{6}{8} =$ ☐

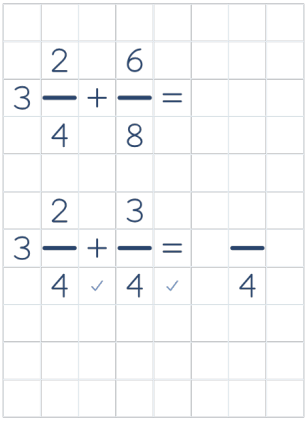

Both denominators are 4, so the parts are the same size. We tick both denominators to show they match. Then, we draw the fraction line and write 4 underneath it.

Step 5

$2\frac{2}{4} + 1\frac{6}{8} =$ ☐

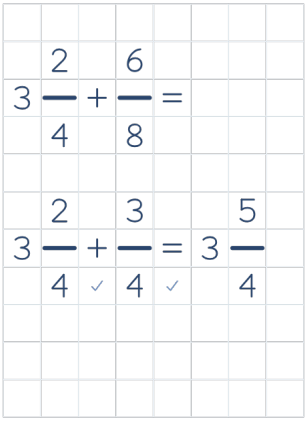

Then, we add the numerators. 2 + 3 = 5. The denominator stays 4 because the parts are still the same size. We write 5 above the fraction line and write 3 in the whole-number square.

Step 6

$2\frac{2}{4} + 1\frac{6}{8} =$ ☐

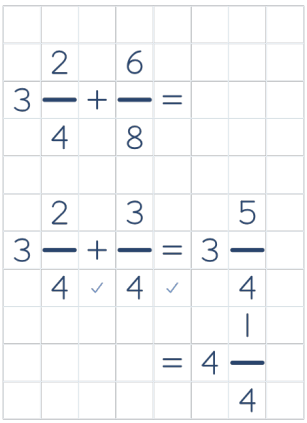

Remember: After making a whole from the fraction, count the parts left and keep their denominator.

We have 3 wholes and 5 quarters. Use 4 quarters to make 1 extra whole. Add 1 to 3 to make 4 wholes. 1 quarter remains. On the next line, line up the equals signs and write = 4 1/4.

Step 7

$2\frac{2}{4} + 1\frac{6}{8} = 4\frac{1}{4}$

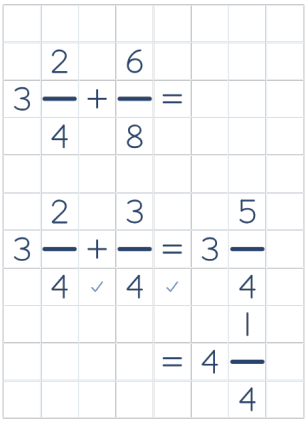

Read the whole-number and fractional parts together. The sum is 4 1/4. Copy 4 1/4 into the answer box. Make sure you copy the answer correctly.

Year 6 - Subtracting Fractions with the Same Denominator — Lesson Guide

Step 1

$\frac{5}{6} - \frac{4}{6} =$ ☐

First, we circle the minus sign so we know to subtract the fractions and find their difference.

Step 2

$\frac{5}{6} - \frac{4}{6} =$ $\frac{\square}{6}$

Remember: The denominator stays the same because the size of each part stays the same.

Next, we check both denominators. Both are 6, so the parts are the same size. We tick both denominators to show they match. Then, we draw the fraction line and write 6 underneath it in the answer box.

Step 3

$\frac{5}{6} - \frac{4}{6} = \frac{1}{6}$

Remember: The denominator tells us the size of each part. Keep it the same when you add or subtract these parts.

Both fractions use sixths of the same whole. Take 4 sixths away from 5 sixths to leave 1 sixth. Write 1 above the fraction line.

Step 4

$\frac{5}{6} - \frac{4}{6} = \frac{1}{6}$

Now, we check all three denominators. The first denominator is 6. The second denominator is 6. Our answer denominator is 6. All three are the same. We also check that 5 – 4 = 1, our numerator.

Year 6 - Subtracting Fractions with Different Denominators — Lesson Guide

Step 1

$\frac{5}{6} - \frac{2}{3} =$ ☐



First, we circle the minus sign so we know to subtract the fractions and find their difference.

Step 2

$\frac{5}{6} - \frac{2}{3} =$ ☐

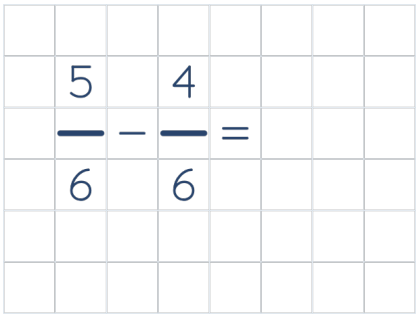

Remember: Change the numerator and denominator by the same factor to keep the value of the fraction.

First, we check whether either fraction can be simplified. Both fractions are already in their simplest form. 6 is a multiple of 3, so 6 is the smallest common denominator. To change 5/6 to denominator 3, we would also have to divide its numerator, 5, by 2. That would not give a whole number, so keep 6. Multiply the numerator and denominator of 2/3 by 2 to get 4/6. We write 5/6 – 4/6 on the grid.

Step 3

$\frac{5}{6} - \frac{2}{3} = \square$

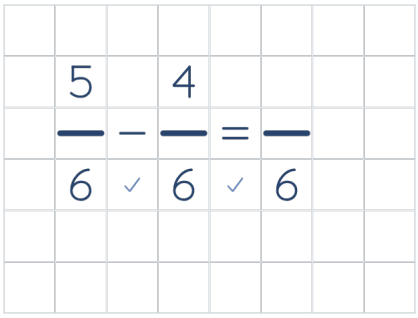

Both denominators are 6, so the parts are the same size. We tick both denominators to show they match. Then, we draw the fraction line and write 6 underneath it.

Step 4

$\frac{5}{6} - \frac{2}{3} = \square$

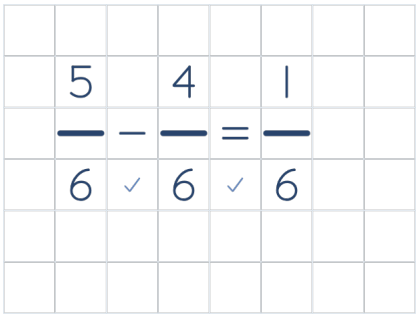

Then, we subtract the numerators. 5 – 4 = 1. The denominator stays 6 because the parts are the same size. We write 1 above the fraction line.

Step 5

$\frac{5}{6} - \frac{2}{3} = \square$

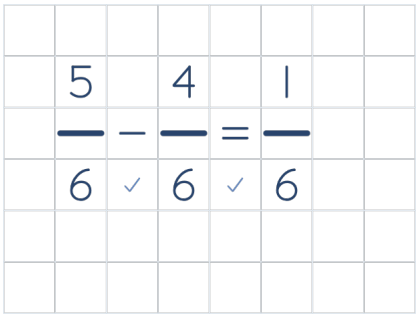

The parts are the same size. Take 4 sixths away from 5 sixths to leave 1 sixth. Keep 6 as the denominator.

Step 6

$\frac{5}{6} - \frac{2}{3} = \frac{1}{6}$

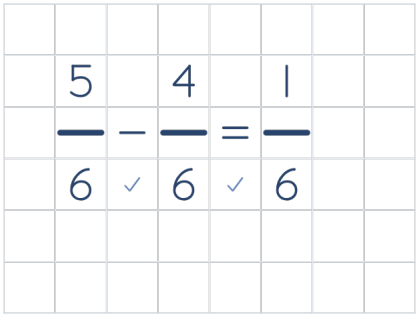

The difference is 1/6. Copy 1/6 into the answer box. Make sure you copy the answer correctly.

Step 7

$\frac{3}{4} - \frac{2}{8} = \frac{1}{2}$

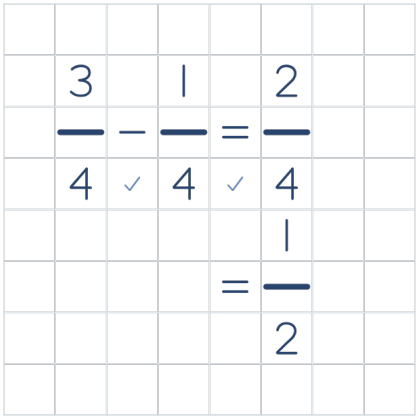

The difference is 2/4. Divide its numerator and denominator by 2. 2/4 is equivalent to 1/2.

Year 6 - Subtracting Fractions with Wholes — Lesson Guide

Step 1

$2\frac{2}{4} - 1\frac{2}{8} =$ ☐

First, we circle the minus sign so we know to subtract and find the difference.

Step 2

$2\frac{2}{4} - 1\frac{2}{8} =$ ☐

First, we subtract the whole-number parts, keeping the fractional parts separate for now. 2 – 1 = 1. We write 1 in the whole-number square and keep both fractions the same.

Step 3

$2\frac{2}{4} - 1\frac{2}{8} =$ ☐

First, we check whether either fraction can be simplified. One quarter is equivalent to two eighths. Divide the numerator and denominator by 2 to make that change. Keep 2/4, which already uses denominator 4. Keep 1 whole on the left. On the next line, write 1 2/4 – 1/4.

Step 4

$2\frac{2}{4} - 1\frac{2}{8} =$ ☐

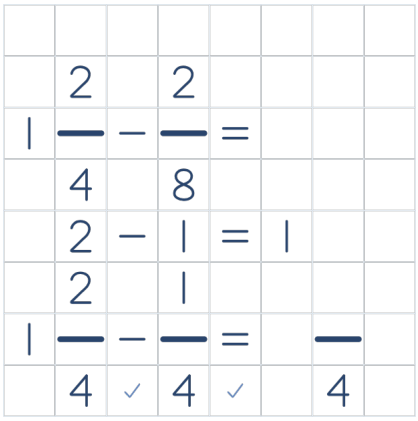

Remember: The denominator stays the same because the size of each part stays the same.

Both denominators are 4, so the parts are the same size. We tick both denominators to show they match. Then, we draw the fraction line and write 4 underneath it.

Step 5

$2\frac{2}{4} - 1\frac{2}{8} =$ ☐

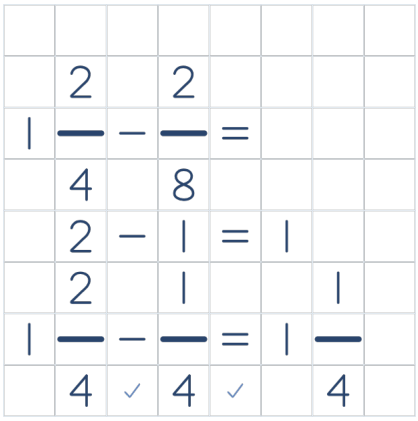

Then, we subtract the numerators. 2 – 1 = 1. The denominator stays 4 because the parts are still the same size. We write 1 above the fraction line and write 1 in the whole-number square.

Step 6

$2\frac{2}{4} - 1\frac{2}{8} =$ $1\frac{1}{4}$

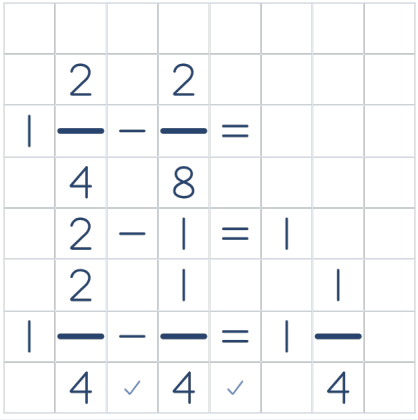

Read the whole-number and fractional parts together. The difference is 1 1/4. Copy 1 1/4 into the answer box. Make sure you copy the answer correctly.

Year 6 - Subtracting Fractions with Wholes – Crossing the Whole — Lesson Guide

Step 1

$5\frac{2}{4} - 1\frac{6}{8} =$ ☐



First, we circle the minus sign so we know to subtract and find the difference.

Step 2

$5\frac{2}{4} - 1\frac{6}{8} =$ ☐

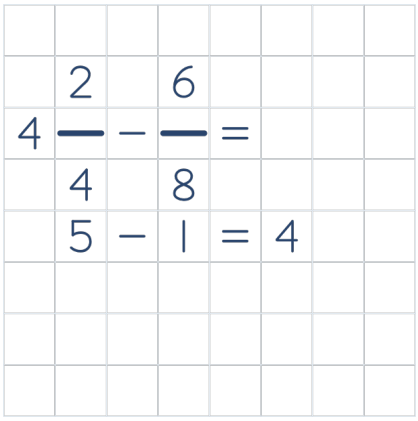

First, we subtract the whole-number parts, keeping the fractional parts separate for now. 5 – 1 = 4. We write 4 in the whole-number square and keep both fractions the same.

Step 3

$5\frac{2}{4} - 1\frac{6}{8} =$ ☐

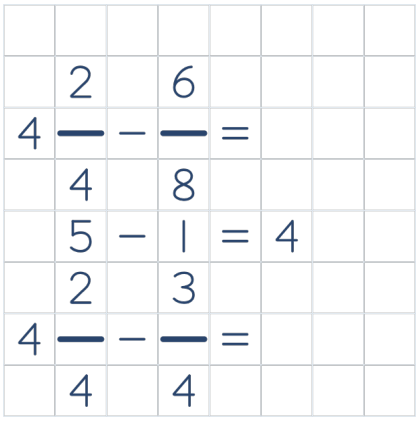

First, we check whether either fraction can be simplified. Three quarters is equivalent to six eighths. Divide the numerator and denominator by 2 to make that change. Keep 2/4, which already uses denominator 4. Keep 4 wholes on the left. On the next line, write 4 2/4 – 3/4.

Step 4

$5\frac{2}{4} - 1\frac{6}{8} =$ ☐

	2		6				
4	—	–	—	=			
	4		8				
	5	–	1	=	4		
	~~2~~ 6		3				
~~4~~ 3	—	–	—	=			
	4		4				

Remember: One whole is 4 quarters. Exchange one whole and add 4 to the numerator. Keep the denominator 4.

We need to subtract 3 quarters and have 2 quarters. Exchange 1 of the 4 wholes for 4 quarters. Cross out 4 and write 3 in the whole-number square. Add 4 quarters to 2 quarters. Cross out 2 and write 6 as the numerator. 3 wholes and 6 quarters have the same value as before the exchange.

Step 5

$5\frac{2}{4} - 1\frac{6}{8} =$ ☐

	2		6				
4	—	–	—	=			
	4		8				
	5	–	1	=	4		
	~~2~~ 6		3				
~~4~~ 3	—	–	—	=		—	
	4	✓	4	✓		4	

Both denominators are 4, so the parts are the same size. We tick both denominators to show they match. Then, we draw the fraction line and write 4 underneath it.

Step 6

$5\frac{2}{4} - 1\frac{6}{8} =$ ☐

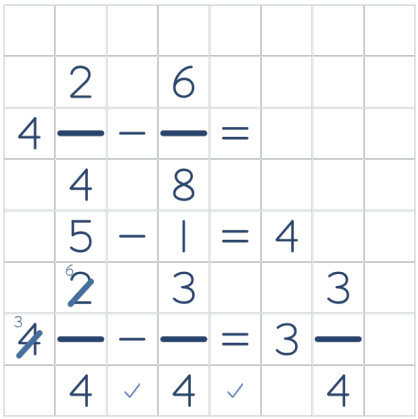

Subtract 3 quarters from 6 quarters. That leaves 3 quarters. Write 3 above the fraction line. We have 3 wholes after the exchange. Write 3 in the whole-number square.

Step 7

$5\frac{2}{4} - 1\frac{6}{8} = 3\frac{3}{4}$

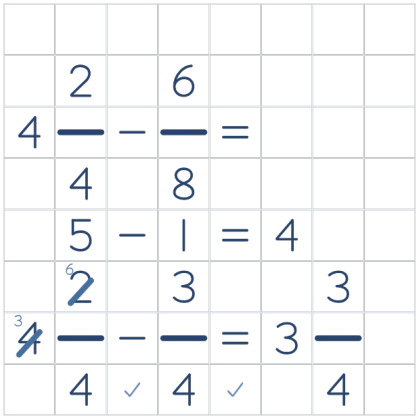

Read the whole-number and fractional parts together. The difference is 3 3/4. Copy 3 3/4 into the answer box. Make sure you copy the answer correctly.

Year 6 - Percentages (Multiples of 10) — Lesson Guide

Step 1

20% of 50 = ☐



Per cent means out of 100. To find 10%, we split the whole into ten equal parts. We can use this amount to find other multiples of 10%.

Step 2

20% of 50 = ☐

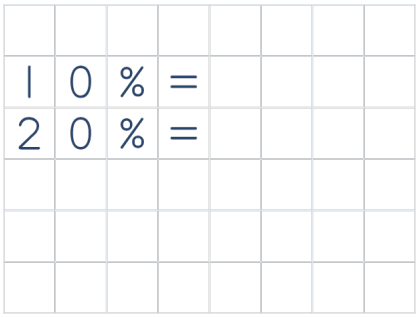

We are finding 20% of 50. Write 10% and an equals sign. Read this row as 10% of 50. Write 20% and an equals sign. Read this row as 20% of 50.

Step 3

20% of 50 = ☐

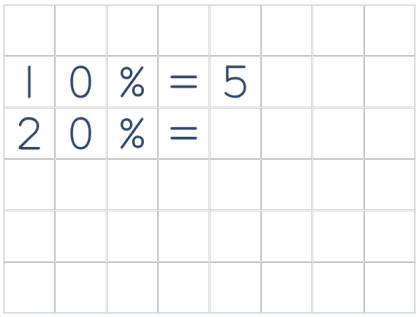

Remember: Find ten per cent of the whole amount by dividing the whole by ten.

We divide 50 by 10 to find 10%. 50 ÷ 10 = 5. We write 5 on the 10% row.

Step 4

20% of 50 = ☐

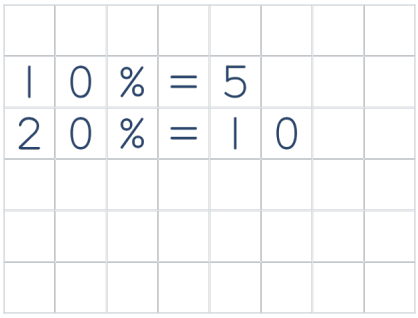

Remember: Read each percentage as a share of the original whole. In this question, the whole is 50.

The 10% row shows 5, which is 10% of 50. For 20% of 50, use 2 lots of 5. 5 × 2 = 10. Write 10 on the 20% row.

Step 5

20% of 50 = **10**

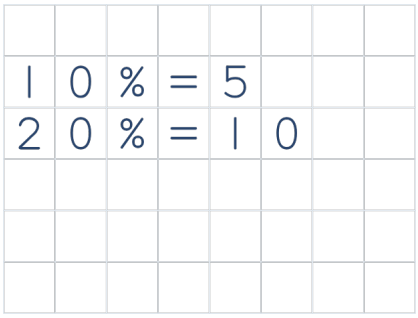

The answer is 10. Copy 10 into the answer box. Make sure you copy the answer correctly.

Year 6 - Percentages — Lesson Guide

Step 1

46% of 30 = ☐

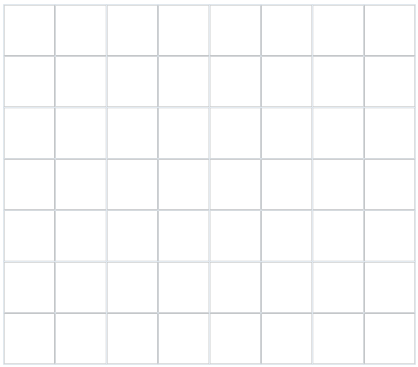

Per cent means out of 100. To find 10%, we split the whole into ten equal parts. To find 1%, we split the whole into one hundred equal parts. We can use these amounts to build the percentage we need.

Step 2

46% of 30 = ☐

1	0	%	=				
4	0	%	=				
	1	%	=				
	6	%	=				

Split 46% into 40% and 6%. Use 10% to find 40% and 1% to find 6%. Write 10% and an equals sign. Read this row as 10% of 30. Write 40% and an equals sign. Read this row as 40% of 30. Write 1% and an equals sign. Read this row as 1% of 30. Write 6% and an equals sign. Read this row as 6% of 30.

Step 3

46% of 30 = ☐

1	0	%	=	3			
4	0	%	=				
	1	%	=				
	6	%	=				

We divide 30 by 10 to find 10%. 30 ÷ 10 = 3. We write 3 on the 10% row.

Step 4

46% of 30 = ☐



Remember: Read each percentage as a share of the original whole. In this question, the whole is 30.

The 10% row shows 3, which is 10% of 30. For 40% of 30, use 4 lots of 3. 3 × 4 = 12. Write 12 on the 40% row.

Step 5

46% of 30 = ☐



Remember: One per cent is one hundredth of the whole amount.

One per cent of 30 is one hundredth of 30. We already know that 10% of 30 is 3. Divide 3 by 10 to get 1%, which is 0.3. Write 0.3 on the 1% row.

Step 6

46% of 30 = ☐



We need 6%, which is 6 lots of 1%. 0.3 × 6 = 1.8. We write 1.8 on the 6% row.

Step 7

46% of 30 = ☐

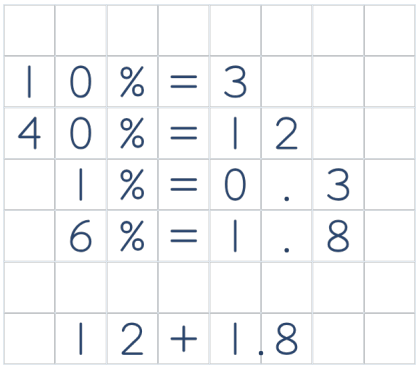

The 40% row shows 12 and the 6% row shows 1.8. Add the amounts because 40% and 6% make 46%. Write 12 + 1.8 = 13.8. 13.8 is between 12, which is 40% of 30, and 15, which is 50% of 30.

Step 8

46% of 30 = **13.8**

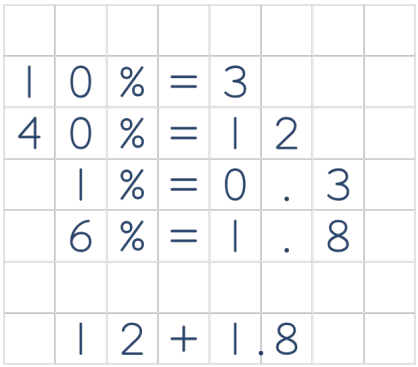

The answer is 13.8. Copy 13.8 into the answer box. Make sure you copy the answer correctly.

Year 6 - Multiplying Fractions — Lesson Guide

Step 1

$\frac{2}{4} \times \frac{2}{3} =$ ☐

First, we circle the multiplication sign so we know to multiply.

Step 2

$\frac{2}{4} \times \frac{2}{3} =$ ☐

Read 2/4 × 2/3 as 2 quarters of 2 thirds. Split each part of size 1/3 into 4 equal pieces. This makes 12 equal pieces in one whole. The denominators give the size of each piece. The numerators tell us how many pieces to take.

Step 3

$\frac{2}{4} \times \frac{2}{3} =$ $\frac{4}{\ }$

We multiply the numerators. 2 × 2 = 4. We write 4 above the fraction line in the answer box.

Step 4

$\frac{2}{4} \times \frac{2}{3} =$ $\frac{4}{12}$

Remember: For multiplication, multiply the denominators as well as the numerators.

We multiply the denominators. 4 × 3 = 12. We write 12 below the fraction line. Our product is 4/12.

Step 5

$\frac{2}{4} \times \frac{2}{3} =$ $\frac{1}{3}$

We can divide the numerator and denominator by 4. 4/12 is equivalent to 1/3. We write 1/3 in the answer box in its simplest form.

Year 6 - Multiplying a Mixed Number by a Whole Number — Lesson Guide

Step 1

$2\frac{1}{2} \times 8 =$ ☐



First, we circle the multiplication sign so we know to multiply.

Step 2

$2\frac{1}{2} \times 8 =$ ☐



Remember: Multiply both the whole-number part and the fractional part. Add the two products.

We split 2 1/2 into its whole-number part, 2, and its fractional part, 1/2. Multiplying the whole amount by 8 means multiplying both parts by 8, then adding the two products.

Step 3

$2\frac{1}{2} \times 8 =$ ☐

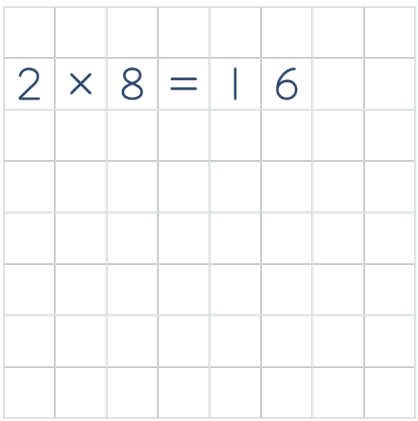

First, we multiply the whole-number part. 2 × 8 = 16.

Step 4

$2\frac{1}{2} \times 8 =$ ☐



Find 8 lots of 1 half. 1 × 8 = 8, so write 8 above the fraction line. Keep 2 as the denominator. The parts are still halves.

Step 5

$2\frac{1}{2} \times 8 =$ ☐



Remember: Count the wholes in 8 halves before adding the two products.

Read 8/2 as 8 halves. 2 halves make one whole, so 8 halves make 4 wholes. Add the fractional product to 16. Write 20 as the product.

Step 6

$2\frac{1}{2} \times 8 =$ **20**



The product is 20. Copy 20 into the answer box. Make sure you copy the answer correctly.

Year 6 - Dividing a Fraction by a Whole Number — Lesson Guide

Step 1

$\frac{1}{6} \div 2 =$ ☐

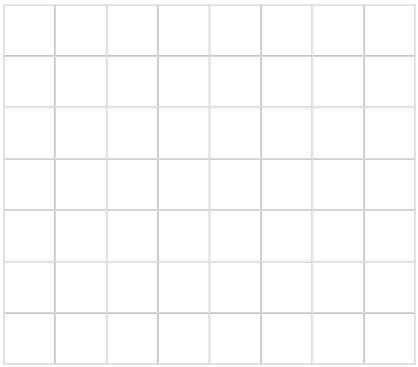

First, we circle the division sign so we know to divide.

Step 2

$\frac{1}{6} \div \frac{2}{1} =$ ☐

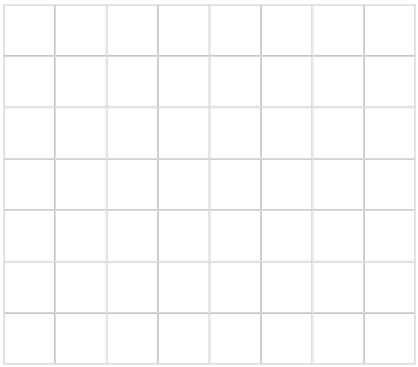

Write the divisor, 2, as 2/1. The denominator 1 means we are counting in wholes. Read 2/1 as 2 wholes. Its value is still 2.

Step 3

$\frac{1}{6} \div \frac{2}{1} =$ ☐

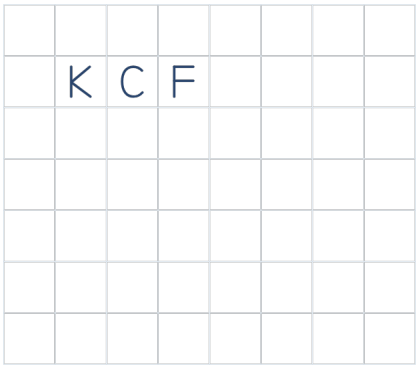

We write K, C and F across the first row. K means keep, C means change and F means flip.

Step 4

$\frac{1}{6} \div \frac{2}{1} =$ ☐

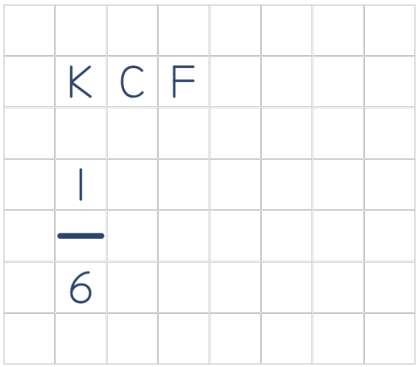

First, we keep the first fraction. We write 1/6 below K.

Step 5

$\frac{1}{6} \div \frac{2}{1} =$ ☐

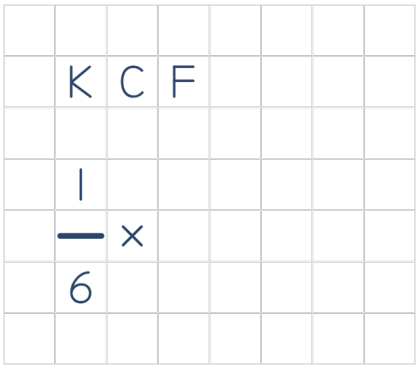

Next, we change the division sign to a multiplication sign. We write the multiplication sign below C.

Step 6

$\frac{1}{6} \div \frac{2}{1} =$ ☐

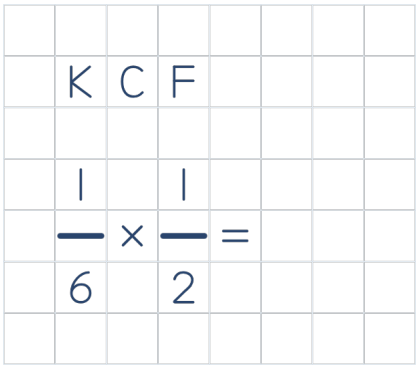

Remember: Flip the divisor only. Keep the first fraction the same.

Then, we flip 2/1 to make 1/2. Multiplying by 1/2 finds one of 2 equal shares, which is the same as dividing by 2. We write the new fraction below F, then an equals sign.

Step 7

$\frac{1}{6} \div \frac{2}{1} =$ ☐

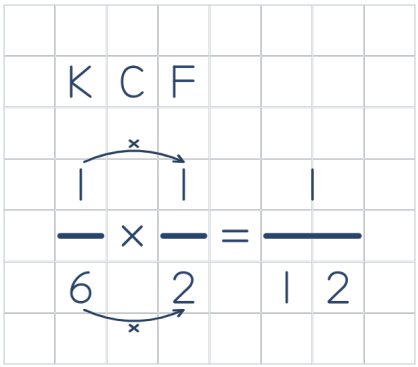

The top arrow links the numerators, 1 and 1. Multiply them and write 1 above the fraction line. The bottom arrow links the denominators, 6 and 2. Multiply them and write 12 below the line. Read the result as 1 twelfth.

Step 8

$\frac{1}{6} \div \frac{2}{1} = \frac{1}{12}$

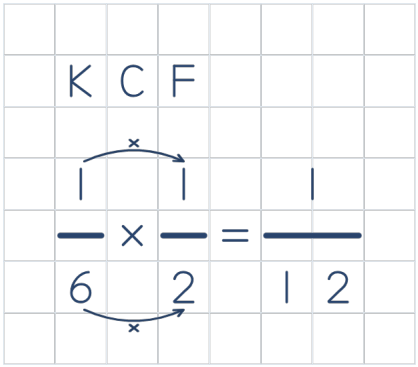

The quotient is 1/12. Copy 1/12 into the answer box. Make sure you copy the answer correctly.

Year 6 - Rounding Whole Numbers — Lesson Guide

Step 1

865,000 to the nearest 100,000 = ☐

First, we read the question: 865,000 to the nearest 100,000. We underline 100,000 so we do not accidentally round to the wrong amount. As we are rounding to the nearest 100,000, our answer will be a multiple of 100,000, ending in at least five zeros.

Step 2

865,000 to the nearest 100,000 = ☐

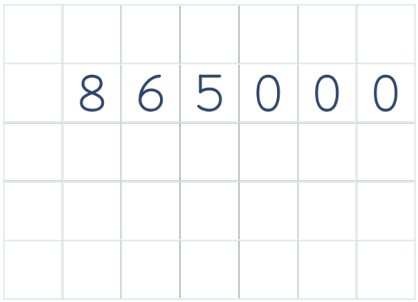

Now, we write 865,000 in the correct columns, with one digit in each box. The first digit of 865,000, 8, is in the hundred thousands column, so we start there.

Step 3

865,000 to the nearest 100,000 = ☐



Now, we circle the hundred thousands digit because we are rounding to the nearest 100,000.

Step 4

865,000 to the nearest 100,000 = ☐

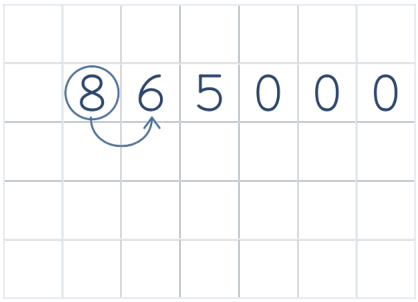

Remember: The circled digit marks the place to round to. The digit at the arrow tells us whether to round up.

The circled 8 marks the hundred thousands place. Draw a curved arrow from there to the 6 in the ten thousands place. That digit decides which way to round. Zero to four, stay on the floor. Five to nine, climb the vine.

Step 5

865,000 to the nearest 100,000 = ☐

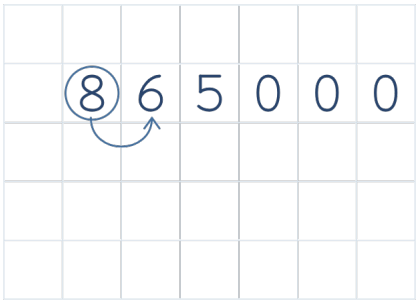

Remember: When we round down, the circled digit stays the same. When we round up, it increases by 1. If it reaches 10, write 0 and exchange into the next place.

6 is between 5 and 9, so we climb the vine and round up. We increase the hundred thousands place by one hundred thousand. All the digits to the right of the rounded place become 0.

Step 6

865,000 to the nearest 100,000 = 900000

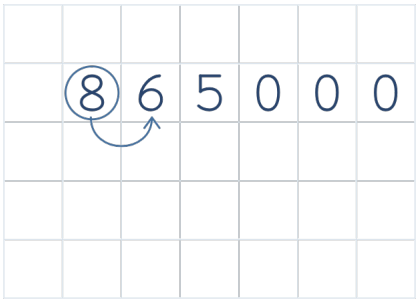

Now, we write 900,000 directly in the answer box. 865,000 rounded to the nearest 100,000 is 900,000. Make sure you copy the answer correctly.

Step 7

865,000 to the nearest 100,000 = 900000

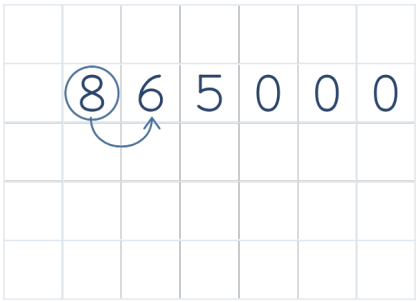

Check the rounding marks. The underline shows the nearest 100,000. The circle marks the 8 in the hundred thousands place. The arrow ends at the 6. The neighbouring multiples are 800,000 and 900,000. The halfway point is 850,000. 865,000 is closer to 900,000. That agrees with our rounded answer of 900,000.

Year 6 - Solving Calculations on Either Side — Lesson Guide

Step 1

$\square \times 2 = 13 + 7$



First, we circle the operation sign on the left. Then, we circle the operation sign on the right. The equals sign tells us that both sides must have the same value.

Step 2

$\square \times 2 = \underline{13 + 7}$



Remember: Both sides of the equals sign must have the same value.

Next, we look for the side with no missing number. We underline 13 + 7. We will work out this complete calculation first.

Step 3

$\square \times 2 = \underline{13 + 7}$

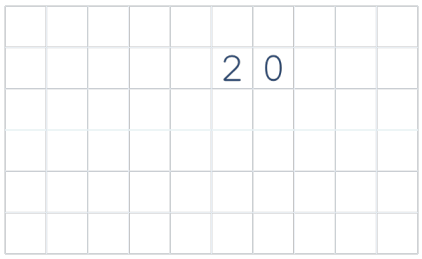

I can use place value and a number fact to add 7 mentally. 13 + 7 = 20. We write 20 directly underneath this calculation, with one digit in each square.

Step 4

$\square \times 2 = 13 + 7$

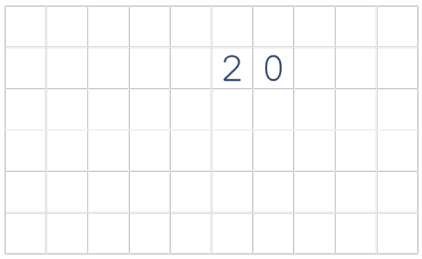

The equals sign tells us that both sides have the same value. We underline something × 2 on the other side.

Step 5

$\square \times 2 = 13 + 7$



The right side, 13 + 7, equals 20. The left side must also equal 20. Write 20 directly under the left side, with one digit in each square.

Step 6

$\square \times 2 = 13 + 7$



Now we need something × 2 to equal 20. We can use our missing-number method to find the missing factor.

Step 7

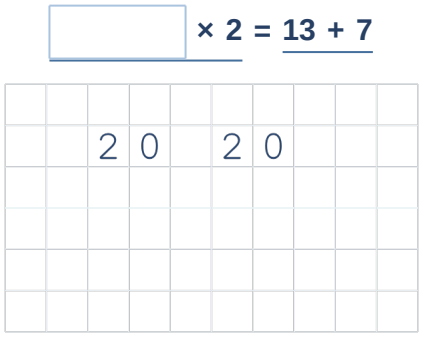

Remember: Work out the complete side first, wherever it appears. Use its value to find the missing number.

Look at the left side of the equals sign. It says something times 2. This side needs a value of 20. The box is for the missing factor.

Step 8

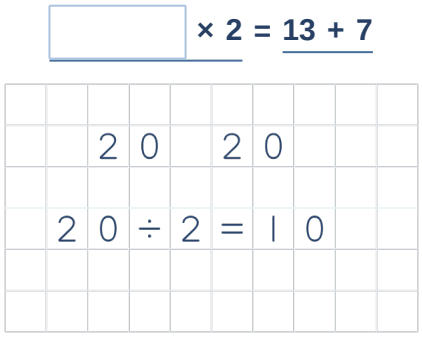

The side with the blank must also equal 20. Divide 20 by 2 to find the missing factor. Write 20 ÷ 2 = 10 below the two totals.

Step 9

10 × 2 = 13 + 7

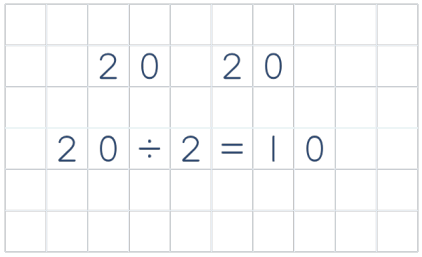

Now, we put 10 into the blank in the original question. Make sure you copy the answer correctly.

Step 10

10 × 2 = 13 + 7

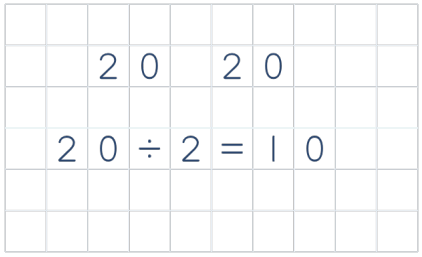

Read the completed equation. 10 × 2 = 13 + 7. The left side is 10 × 2, which makes 20. The right side is 13 + 7, which also makes 20. Both sides have the same value, so 10 works.

Year 6 - BIDMAS — Lesson Guide

Step 1

(9 – 4) × (12 – 6) = ☐

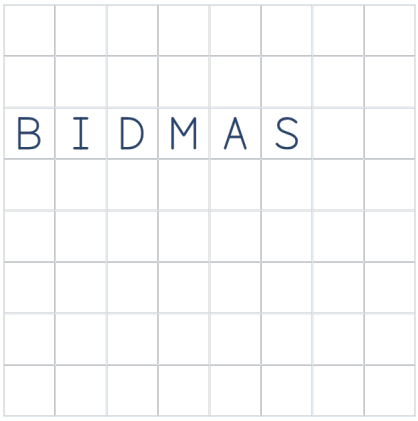

We use BIDMAS to decide what to do first. It stands for brackets, indices, division, multiplication, addition and subtraction. Indices are powers, such as squares and cubes. Division and multiplication have equal priority. Addition and subtraction have equal priority. When operations have the same priority, we work from left to right.

Step 2

(9 – 4) × (12 – 6) = ☐



Remember: Division and multiplication have equal priority. Addition and subtraction have equal priority.

We underline B for brackets and M for multiplication. The brackets come first.

Step 3

(9 – 4) × (12 – 6) = ☐

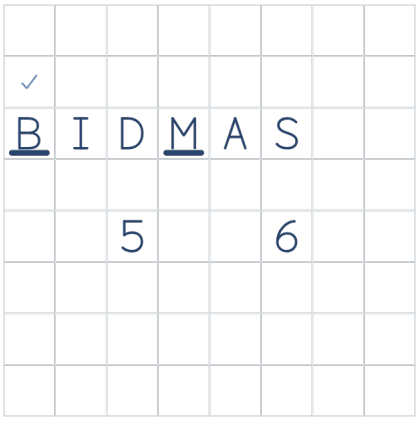

Work out each bracket. 9 – 4 = 5. Write 5 below the left bracket. 12 – 6 = 6. Write 6 below the right bracket. Tick B when both brackets are done. Keep the operation between the brackets for the next step.

Step 4

(9 – 4) × (12 – 6) = ____

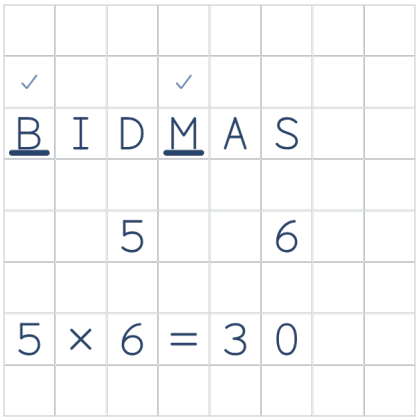

Now we use the bracket values for the multiplication. 5 × 6 = 30. We write that calculation underneath and tick M.

Step 5

(9 – 4) × (12 – 6) = 30

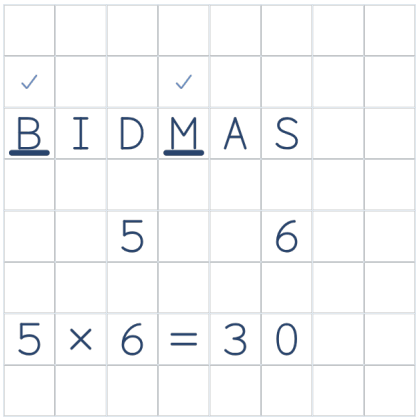

The answer is 30. Copy 30 into the answer box. Make sure you copy the answer correctly.

Step 6

24 ÷ 6 × 2 = ☐

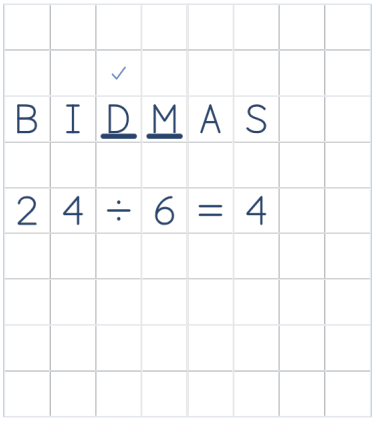

These operations have equal priority, so we work from left to right. 24 ÷ 6 = 4. We write that number fact on the grid.

Step 7

24 ÷ 6 × 2 = **8**

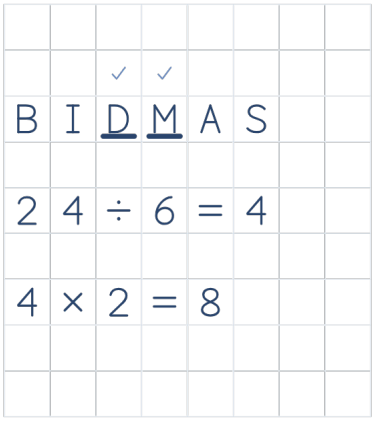

We complete the remaining calculation. 4 × 2 = 8. We write that number fact on the grid. We copy 8 into the answer box.